Task card 1 Surface Area of Cylinders

Find the surface area of the cylinder in square meters. Use π ≈ 3.14.

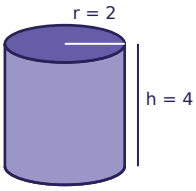

Task card 2 Surface Area of Cylinders

Find the surface area of the cylinder in square inches. Use π ≈ 3.14.

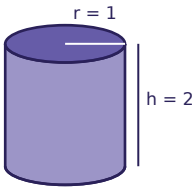

Task card 3 Surface Area of Cylinders

Find the surface area of the cylinder in square feet. Use π ≈ 3.14.

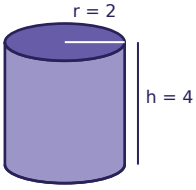

Task card 4 Surface Area of Cylinders

Find the surface area of the cylinder in square centimeters. Use π ≈ 3.14.

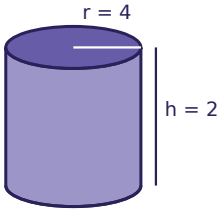

Task card 5 Surface Area of Cylinders

Find the surface area of the cylinder in square feet. Use π ≈ 3.14.

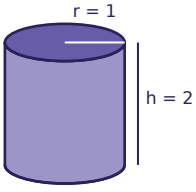

Task card 6 Surface Area of Cylinders

Find the surface area of the cylinder in square meters. Use π ≈ 3.14.

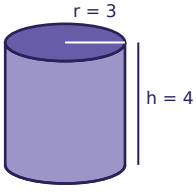

Task card 7 Surface Area of Cylinders

Find the surface area of the cylinder in square centimeters. Use π ≈ 3.14.

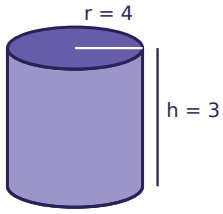

Task card 8 Surface Area of Cylinders

Find the surface area of the cylinder in square feet. Use π ≈ 3.14.

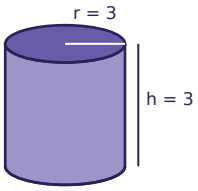

Task card 9 Surface Area of Cylinders

Find the surface area of the cylinder in square meters. Use π ≈ 3.14.

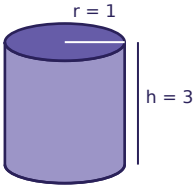

Task card 10 Surface Area of Cylinders

Find the surface area of the cylinder in square feet. Use π ≈ 3.14.

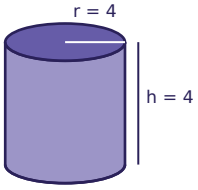

Task card 11 Surface Area of Cylinders

Find the surface area of the cylinder in square feet. Use π ≈ 3.14.

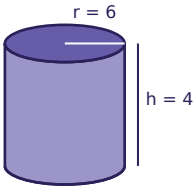

Task card 12 Surface Area of Cylinders

Find the surface area of the cylinder in square meters. Use π ≈ 3.14.

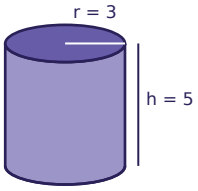

Task card 13 Surface Area of Cylinders

Find the surface area of the cylinder in square centimeters. Use π ≈ 3.14.

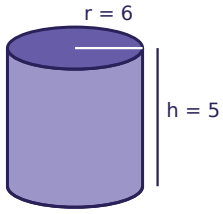

Task card 14 Surface Area of Cylinders

Find the surface area of the cylinder in square centimeters. Use π ≈ 3.14.

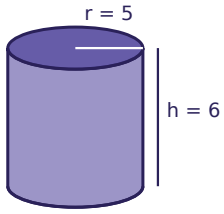

Task card 15 Surface Area of Cylinders

Find the surface area of the cylinder in square feet. Use π ≈ 3.14.

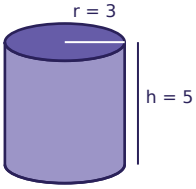

Task card 16 Surface Area of Cylinders

Find the surface area of the cylinder in square inches. Use π ≈ 3.14.

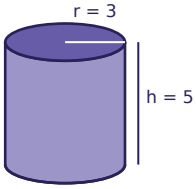

Task card 17 Surface Area of Cylinders

Find the surface area of the cylinder in square inches. Use π ≈ 3.14.

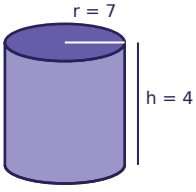

Task card 18 Surface Area of Cylinders

Find the surface area of the cylinder in square feet. Use π ≈ 3.14.

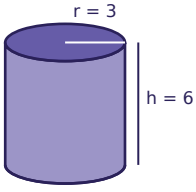

Task card 19 Surface Area of Cylinders

Find the surface area of the cylinder in square inches. Use π ≈ 3.14.

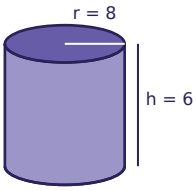

Task card 20 Surface Area of Cylinders

Find the surface area of the cylinder in square feet. Use π ≈ 3.14.

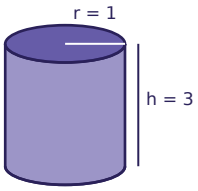

Task card 21 Surface Area of Cylinders

Find the surface area of the cylinder in square meters. Use π ≈ 3.14.

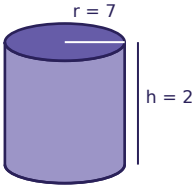

Task card 22 Surface Area of Cylinders

Find the surface area of the cylinder in square centimeters. Use π ≈ 3.14.

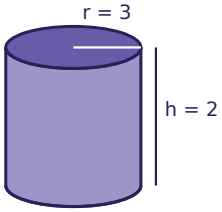

Task card 23 Surface Area of Cylinders

Find the surface area of the cylinder in square inches. Use π ≈ 3.14.

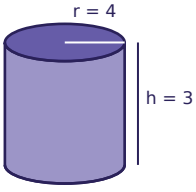

Task card 24 Surface Area of Cylinders

Find the surface area of the cylinder in square inches. Use π ≈ 3.14.

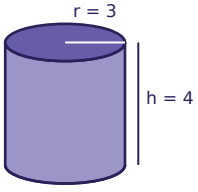

Surface Area of Cylinders Task Cards

Recording sheet · Grade 8 · Use π ≈ 3.14 unless the problem says "in terms of π".

Name: _____ Date: _____

Scan to check your answers

1	2	3	4
5	6	7	8
9	10	11	12
13	14	15	16
17	18	19	20
21	22	23	24

Surface Area of Cylinders Task Cards: Answer Key

Grade 8 · Easy

The answers online

1. 75.36	**2.** 18.84	**3.** 75.36
4. 150.72	**5.** 18.84	**6.** 131.88
7. 175.84	**8.** 113.04	**9.** 25.12
10. 200.96	**11.** 376.8	**12.** 150.72
13. 414.48	**14.** 345.4	**15.** 150.72
16. 150.72	**17.** 483.56	**18.** 169.56
19. 703.36	**20.** 25.12	**21.** 395.64
22. 94.2	**23.** 175.84	**24.** 131.88