Surface Area of Cylinders · 1

Find the surface area of the cylinder in square meters. Use π ≈ 3.14.

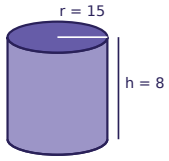

Surface Area of Cylinders · 2

Find the surface area of the cylinder in square meters. Use π ≈ 3.14.

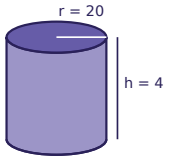

Surface Area of Cylinders · 3

Find the surface area of the cylinder in square centimeters. Use π ≈ 3.14.

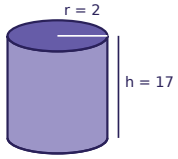

Surface Area of Cylinders · 4

Find the surface area of the cylinder in square inches. Use π ≈ 3.14.

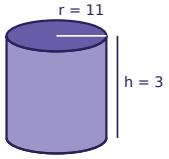

Surface Area of Cylinders · 5

Find the surface area of the cylinder in square inches. Use π ≈ 3.14.

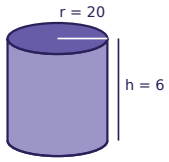

Surface Area of Cylinders · 6

Find the surface area of the cylinder in square centimeters. Use π ≈ 3.14.

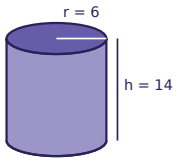

Surface Area of Cylinders · 7

Find the surface area of the cylinder in square inches. Use π ≈ 3.14.

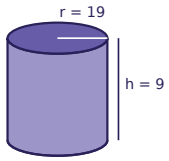

Surface Area of Cylinders · 8

Find the surface area of the cylinder in square feet. Use π ≈ 3.14.

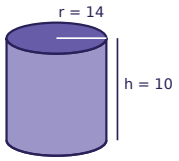

Surface Area of Cylinders · 2

ANSWER

3014.4

Surface Area of Cylinders · 1

ANSWER

2166.6

Surface Area of Cylinders · 4

ANSWER

967.12

Surface Area of Cylinders · 3

ANSWER

238.64

Surface Area of Cylinders · 6

ANSWER

753.6

Surface Area of Cylinders · 5

ANSWER

3265.6

Surface Area of Cylinders · 8

ANSWER

2110.08

Surface Area of Cylinders · 7

ANSWER

3340.96

Surface Area of Cylinders · 9

Find the surface area of the cylinder in square feet. Use π ≈ 3.14.

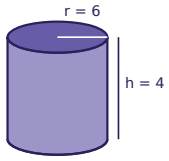

Surface Area of Cylinders · 10

Find the surface area of the cylinder in square inches. Use π ≈ 3.14.

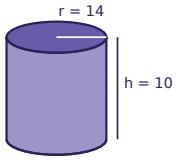

Surface Area of Cylinders · 11

Find the surface area of the cylinder in square meters. Use π ≈ 3.14.

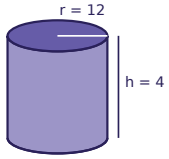

Surface Area of Cylinders · 12

Find the surface area of the cylinder in square inches. Use π ≈ 3.14.

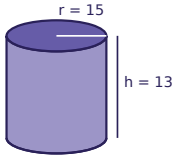

Surface Area of Cylinders · 13

A round water tank has a radius of 2 in and a height of 5 in. The whole outside, top and bottom included, is painted. How many square inches are painted? Use π ≈ 3.14.

Surface Area of Cylinders · 14

A soup can has a radius of 9 in and a height of 13 in. How many square inches of metal make the can, top and bottom included? Use π ≈ 3.14.

Surface Area of Cylinders · 15

A round water tank has a radius of 13 m and a height of 4 m. The whole outside, top and bottom included, is painted. How many square meters are painted? Use π ≈ 3.14.

Surface Area of Cylinders · 16

A round water tank has a radius of 5 m and a height of 5 m. The whole outside, top and bottom included, is painted. How many square meters are painted? Use π ≈ 3.14.

Surface Area of Cylinders · 10

ANSWER

2110.08

Surface Area of Cylinders · 9

ANSWER

376.8

Surface Area of Cylinders · 12

ANSWER

2637.6

Surface Area of Cylinders · 11

ANSWER

1205.76

Surface Area of Cylinders · 14

ANSWER

1243.44

Surface Area of Cylinders · 13

ANSWER

87.92

Surface Area of Cylinders · 16

ANSWER

314

Surface Area of Cylinders · 15

ANSWER

1387.88

Surface Area of Cylinders · 17

Find the surface area of the cylinder in square centimeters. Use π ≈ 3.14.

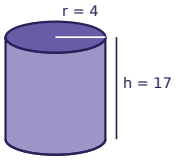

Surface Area of Cylinders · 18

Find the surface area of the cylinder in square centimeters. Use π ≈ 3.14.

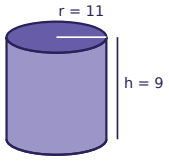

Surface Area of Cylinders · 19

Find the surface area of the cylinder in square feet. Use π ≈ 3.14.

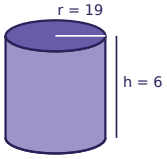

Surface Area of Cylinders · 20

Find the surface area of the cylinder in square inches. Use π ≈ 3.14.

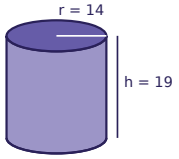

Surface Area of Cylinders · 21

Find the surface area of the cylinder in square inches. Use π ≈ 3.14.

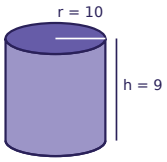

Surface Area of Cylinders · 22

Find the surface area of the cylinder in square feet. Use π ≈ 3.14.

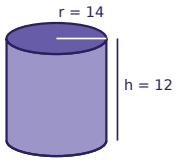

Surface Area of Cylinders · 23

Find the surface area of the cylinder in square feet. Use π ≈ 3.14.

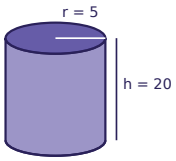

Surface Area of Cylinders · 24

Find the surface area of the cylinder in square feet. Use π ≈ 3.14.

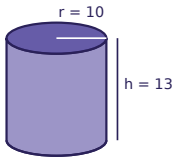

Surface Area of Cylinders · 18

ANSWER

1381.6

Surface Area of Cylinders · 17

ANSWER

527.52

Surface Area of Cylinders · 20

ANSWER

2901.36

Surface Area of Cylinders · 19

ANSWER

2983

Surface Area of Cylinders · 22

ANSWER

2285.92

Surface Area of Cylinders · 21

ANSWER

1193.2

Surface Area of Cylinders · 24

ANSWER

1444.4

Surface Area of Cylinders · 23

ANSWER

785