Surface Area of Cylinders · 1

Find the surface area of the cylinder in square meters. Use π ≈ 3.14.

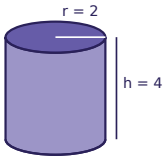

Surface Area of Cylinders · 2

Find the surface area of the cylinder in square inches. Use π ≈ 3.14.

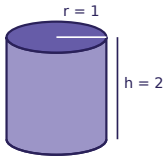

Surface Area of Cylinders · 3

Find the surface area of the cylinder in square feet. Use π ≈ 3.14.

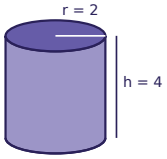

Surface Area of Cylinders · 4

Find the surface area of the cylinder in square centimeters. Use π ≈ 3.14.

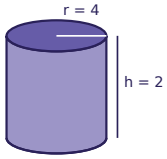

Surface Area of Cylinders · 5

Find the surface area of the cylinder in square feet. Use π ≈ 3.14.

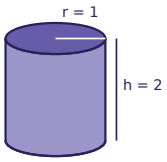

Surface Area of Cylinders · 6

Find the surface area of the cylinder in square meters. Use π ≈ 3.14.

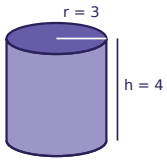

Surface Area of Cylinders · 7

Find the surface area of the cylinder in square centimeters. Use π ≈ 3.14.

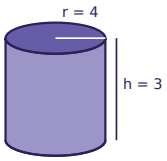

Surface Area of Cylinders · 8

Find the surface area of the cylinder in square feet. Use π ≈ 3.14.

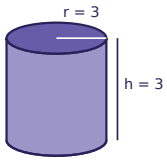

Surface Area of Cylinders · 2

ANSWER

18.84

Surface Area of Cylinders · 1

ANSWER

75.36

Surface Area of Cylinders · 4

ANSWER

150.72

Surface Area of Cylinders · 3

ANSWER

75.36

Surface Area of Cylinders · 6

ANSWER

131.88

Surface Area of Cylinders · 5

ANSWER

18.84

Surface Area of Cylinders · 8

ANSWER

113.04

Surface Area of Cylinders · 7

ANSWER

175.84

Surface Area of Cylinders · 9

Find the surface area of the cylinder in square meters. Use π ≈ 3.14.

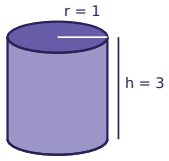

Surface Area of Cylinders · 10

Find the surface area of the cylinder in square feet. Use π ≈ 3.14.

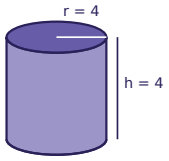

Surface Area of Cylinders · 11

Find the surface area of the cylinder in square feet. Use π ≈ 3.14.

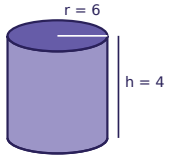

Surface Area of Cylinders · 12

Find the surface area of the cylinder in square meters. Use π ≈ 3.14.

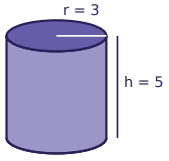

Surface Area of Cylinders · 13

Find the surface area of the cylinder in square centimeters. Use π ≈ 3.14.

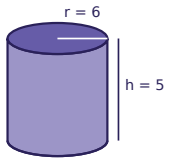

Surface Area of Cylinders · 14

Find the surface area of the cylinder in square centimeters. Use π ≈ 3.14.

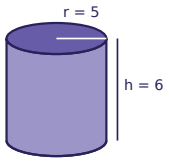

Surface Area of Cylinders · 15

Find the surface area of the cylinder in square feet. Use π ≈ 3.14.

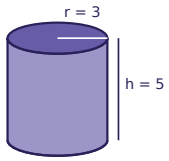

Surface Area of Cylinders · 16

Find the surface area of the cylinder in square inches. Use π ≈ 3.14.

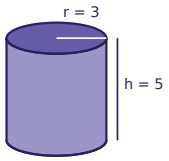

Surface Area of Cylinders · 10

ANSWER

200.96

Surface Area of Cylinders · 9

ANSWER

25.12

Surface Area of Cylinders · 12

ANSWER

150.72

Surface Area of Cylinders · 11

ANSWER

376.8

Surface Area of Cylinders · 14

ANSWER

345.4

Surface Area of Cylinders · 13

ANSWER

414.48

Surface Area of Cylinders · 16

ANSWER

150.72

Surface Area of Cylinders · 15

ANSWER

150.72

Surface Area of Cylinders · 17

Find the surface area of the cylinder in square inches. Use π ≈ 3.14.

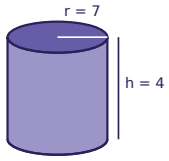

Surface Area of Cylinders · 18

Find the surface area of the cylinder in square feet. Use π ≈ 3.14.

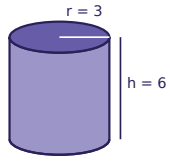

Surface Area of Cylinders · 19

Find the surface area of the cylinder in square inches. Use π ≈ 3.14.

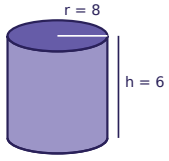

Surface Area of Cylinders · 20

Find the surface area of the cylinder in square feet. Use π ≈ 3.14.

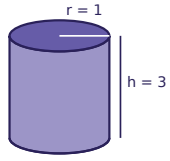

Surface Area of Cylinders · 21

Find the surface area of the cylinder in square meters. Use π ≈ 3.14.

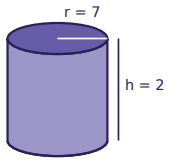

Surface Area of Cylinders · 22

Find the surface area of the cylinder in square centimeters. Use π ≈ 3.14.

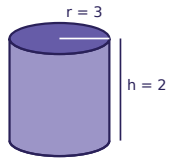

Surface Area of Cylinders · 23

Find the surface area of the cylinder in square inches. Use π ≈ 3.14.

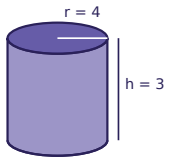

Surface Area of Cylinders · 24

Find the surface area of the cylinder in square inches. Use π ≈ 3.14.

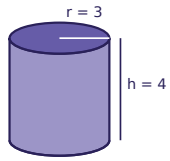

Surface Area of Cylinders · 18

ANSWER

169.56

Surface Area of Cylinders · 17

ANSWER

483.56

Surface Area of Cylinders · 20

ANSWER

25.12

Surface Area of Cylinders · 19

ANSWER

703.36

Surface Area of Cylinders · 22

ANSWER

94.2

Surface Area of Cylinders · 21

ANSWER

395.64

Surface Area of Cylinders · 24

ANSWER

131.88

Surface Area of Cylinders · 23

ANSWER

175.84