Surface Area of Cones · 1

Find the surface area of the cone in square centimeters. First find the slant height. Use π ≈ 3.14.

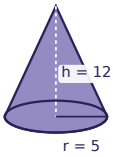

Surface Area of Cones · 2

Find the surface area of the cone in square inches. First find the slant height. Use π ≈ 3.14.

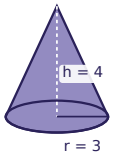

Surface Area of Cones · 3

Find the surface area of the cone in square meters. First find the slant height. Use π ≈ 3.14.

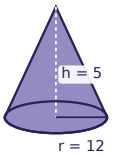

Surface Area of Cones · 4

Find the surface area of the cone in square centimeters. First find the slant height. Use π ≈ 3.14.

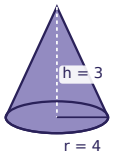

Surface Area of Cones · 5

Find the surface area of the cone in square feet. First find the slant height. Use π ≈ 3.14.

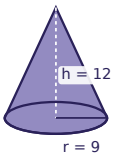

Surface Area of Cones · 6

Find the surface area of the cone in square feet. First find the slant height. Use π ≈ 3.14.

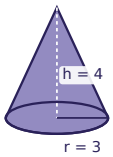

Surface Area of Cones · 7

Find the surface area of the cone in square meters. First find the slant height. Use π ≈ 3.14.

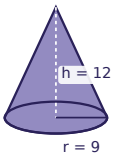

Surface Area of Cones · 8

Find the surface area of the cone in square meters. First find the slant height. Use π ≈ 3.14.

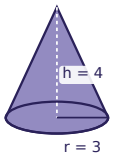

Surface Area of Cones · 2

ANSWER

75.36

Surface Area of Cones · 1

ANSWER

282.6

Surface Area of Cones · 4

ANSWER

113.04

Surface Area of Cones · 3

ANSWER

942

Surface Area of Cones · 6

ANSWER

75.36

Surface Area of Cones · 5

ANSWER

678.24

Surface Area of Cones · 8

ANSWER

75.36

Surface Area of Cones · 7

ANSWER

678.24

Surface Area of Cones · 9

Find the surface area of the cone in square inches. First find the slant height. Use π ≈ 3.14.

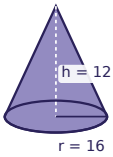

Surface Area of Cones · 10

Find the surface area of the cone in square feet. First find the slant height. Use π ≈ 3.14.

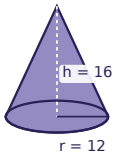

Surface Area of Cones · 11

Find the surface area of the cone in square inches. First find the slant height. Use π ≈ 3.14.

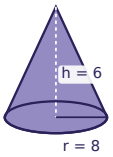

Surface Area of Cones · 12

Find the surface area of the cone in square feet. First find the slant height. Use π ≈ 3.14.

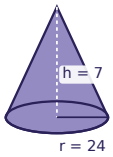

Surface Area of Cones · 13

Find the surface area of the cone in square feet. First find the slant height. Use π ≈ 3.14.

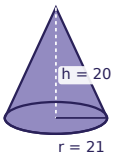

Surface Area of Cones · 14

Find the surface area of the cone in square inches. First find the slant height. Use π ≈ 3.14.

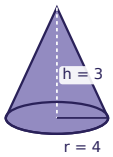

Surface Area of Cones · 15

Find the surface area of the cone in square centimeters. First find the slant height. Use π ≈ 3.14.

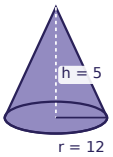

Surface Area of Cones · 16

Find the surface area of the cone in square centimeters. First find the slant height. Use π ≈ 3.14.

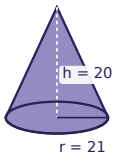

Surface Area of Cones · 10

ANSWER

1205.76

Surface Area of Cones · 9

ANSWER

1808.64

Surface Area of Cones · 12

ANSWER

3692.64

Surface Area of Cones · 11

ANSWER

452.16

Surface Area of Cones · 14

ANSWER

113.04

Surface Area of Cones · 13

ANSWER

3297

Surface Area of Cones · 16

ANSWER

3297

Surface Area of Cones · 15

ANSWER

942

Surface Area of Cones · 17

Find the surface area of the cone in square feet. First find the slant height. Use π ≈ 3.14.

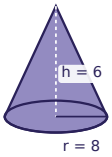

Surface Area of Cones · 18

Find the surface area of the cone in square feet. First find the slant height. Use π ≈ 3.14.

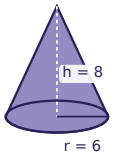

Surface Area of Cones · 19

Find the surface area of the cone in square meters. First find the slant height. Use π ≈ 3.14.

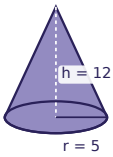

Surface Area of Cones · 20

Find the surface area of the cone in square inches. First find the slant height. Use π ≈ 3.14.

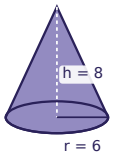

Surface Area of Cones · 21

Find the surface area of the cone in square centimeters. First find the slant height. Use π ≈ 3.14.

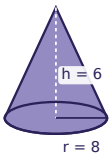

Surface Area of Cones · 22

Find the surface area of the cone in square centimeters. First find the slant height. Use π ≈ 3.14.

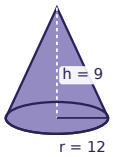

Surface Area of Cones · 23

Find the surface area of the cone in square centimeters. First find the slant height. Use π ≈ 3.14.

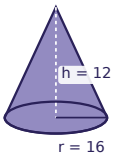

Surface Area of Cones · 24

Find the surface area of the cone in square inches. First find the slant height. Use π ≈ 3.14.

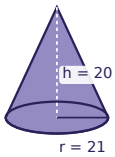

Surface Area of Cones · 18

ANSWER

301.44

Surface Area of Cones · 17

ANSWER

452.16

Surface Area of Cones · 20

ANSWER

301.44

Surface Area of Cones · 19

ANSWER

282.6

Surface Area of Cones · 22

ANSWER

1017.36

Surface Area of Cones · 21

ANSWER

452.16

Surface Area of Cones · 24

ANSWER

3297

Surface Area of Cones · 23

ANSWER

1808.64