Task card 1 Summer Math

Omar orders 4 beach balls online. Shipping costs $7.00, and the total is $37.00. Write and solve an equation to find the price of one beach ball.

Task card 2 Summer Math

A cylinder-shaped tin of cupcakes has a radius of 2 inches and a height of 3 inches. What is its volume in cubic inches?

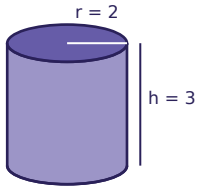

Task card 3 Summer Math

A rectangular banner for the summer barbecue is 4 feet long and 3 feet tall. Noah runs a string of lights straight across it, from one corner to the opposite corner. How many feet long is the string of lights?

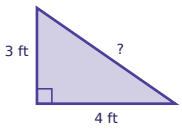

Task card 4 Summer Math

Zoe orders 3 beach balls online. Shipping costs $7.00, and the total is $20.50. Write and solve an equation to find the price of one beach ball.

Task card 5 Summer Math

Ben has $20 saved for the summer barbecue and adds $5 every week. How many dollars will Ben have after 5 weeks?

Task card 6 Summer Math

A cylinder-shaped tin of blueberry muffins has a radius of 2 inches and a height of 4 inches. What is its volume in cubic inches?

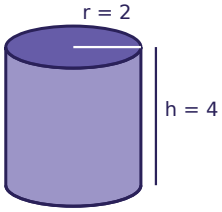

Task card 7

Summer Math

A rectangular banner for the summer barbecue is 12 feet long and 5 feet tall. Mia runs a string of lights straight across it, from one corner to the opposite corner. How many feet long is the string of lights?

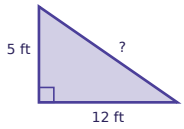

Task card 8

Summer Math

Noah has $15 saved for the summer barbecue and adds $2 every week. How many dollars will Noah have after 7 weeks?

Task card 9

Summer Math

A rectangular banner for the summer barbecue is 12 feet long and 5 feet tall. Sam runs a string of lights straight across it, from one corner to the opposite corner. How many feet long is the string of lights?

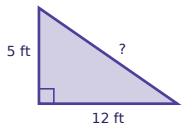

Task card 10

Summer Math

A cylinder-shaped tin of blueberry muffins has a radius of 3 inches and a height of 3 inches. What is its volume in cubic inches?

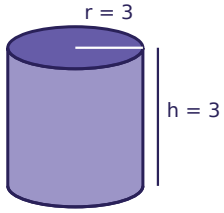

Task card 11

Summer Math

A rectangular banner for the summer barbecue is 4 feet long and 3 feet tall. Zoe runs a string of lights straight across it, from one corner to the opposite corner. How many feet long is the string of lights?

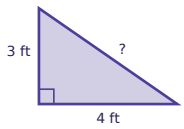

Task card 12

Summer Math

A cylinder-shaped tin of cupcakes has a radius of 3 inches and a height of 5 inches. What is its volume in cubic inches?

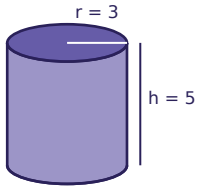

Task card 13 Summer Math

Lily orders 5 cups of lemonade online. Shipping costs $6.00, and the total is $17.25. Write and solve an equation to find the price of one cup of lemonade.

Task card 14 Summer Math

Noah orders 4 beach balls online. Shipping costs $2.00, and the total is $34.00. Write and solve an equation to find the price of one beach ball.

Task card 15 Summer Math

Mia has $10 saved for the summer barbecue and adds $6 every week. How many dollars will Mia have after 7 weeks?

Task card 16 Summer Math

Omar has $15 saved for the summer barbecue and adds $2 every week. How many dollars will Omar have after 9 weeks?

Task card 17 Summer Math

Ava orders 2 pairs of sunglasses online. Shipping costs $5.00, and the total is $20.00. Write and solve an equation to find the price of one pair of sunglasses.

Task card 18 Summer Math

A cylinder-shaped tin of lemon bars has a radius of 3 inches and a height of 6 inches. What is its volume in cubic inches?

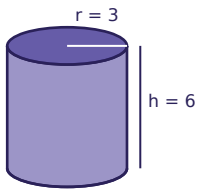

Task card 19 Summer Math

Ella has $20 saved for the summer barbecue and adds $2 every week. How many dollars will Ella have after 5 weeks?

Task card 20 Summer Math

Zoe orders 4 pairs of sunglasses online. Shipping costs $5.00, and the total is $30.00. Write and solve an equation to find the price of one pair of sunglasses.

Task card 21 Summer Math

A rectangular banner for the summer barbecue is 8 feet long and 6 feet tall. Mia runs a string of lights straight across it, from one corner to the opposite corner. How many feet long is the string of lights?

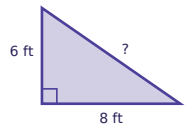

Task card 22 Summer Math

A cylinder-shaped tin of blueberry muffins has a radius of 2 inches and a height of 6 inches. What is its volume in cubic inches?

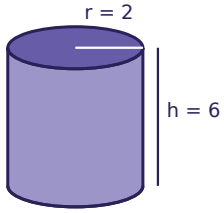

Task card 23 Summer Math

Ben has $15 saved for the summer barbecue and adds $2 every week. How many dollars will Ben have after 8 weeks?

Task card 24 Summer Math

A cylinder-shaped tin of blueberry muffins has a radius of 2 inches and a height of 7 inches. What is its volume in cubic inches?

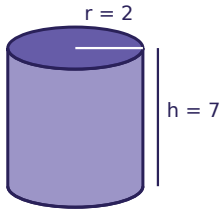

Summer Math Task Cards

Recording sheet · Grade 8 · Read each story and solve. Write money like $3.75. Use 3.14 for π and round to the nearest tenth.

Name: _____ Date: _____

Scan to check your answers

1	2	3	4
5	6	7	8
9	10	11	12
13	14	15	16
17	18	19	20
21	22	23	24

Summer Math Task Cards: Answer Key

Grade 8 · Easy

The answers online

1. $7.50	**2.** 37.7	**3.** 5
4. $4.50	**5.** 45	**6.** 50.2
7. 13	**8.** 29	**9.** 13
10. 84.8	**11.** 5	**12.** 141.3
13. $2.25	**14.** $8.00	**15.** 52
16. 33	**17.** $7.50	**18.** 169.6
19. 30	**20.** $6.25	**21.** 10
22. 75.4	**23.** 31	**24.** 87.9