Solving Systems by Graphing · 1

Solve the system y = -2x + 1 and y = 2x - 3 using the graph.

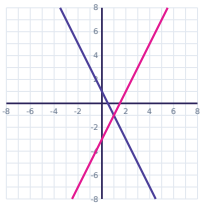

Solving Systems by Graphing · 2

Solve the system y = 3 and y = x + 1 using the graph.

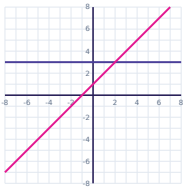

Solving Systems by Graphing · 3

Solve the system y = -x + 3 and y = x - 3 using the graph.

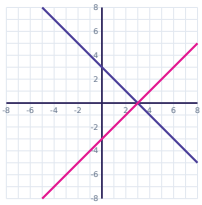

Solving Systems by Graphing · 4

Solve the system y = -2x + 2 and y = 2x - 6 using the graph.

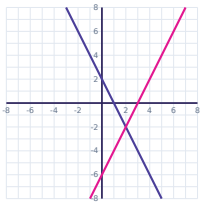

Solving Systems by Graphing · 5

Solve the system y = 2x - 6 and y = -2x + 6 using the graph.

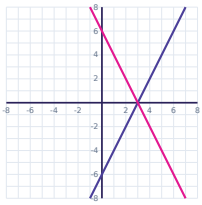

Solving Systems by Graphing · 6

Solve the system y = 2x + 1 and y = x using the graph.

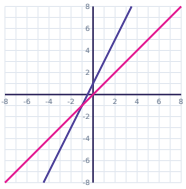

Solving Systems by Graphing · 7

Solve the system y = x + 3 and y = -x + 3 using the graph.

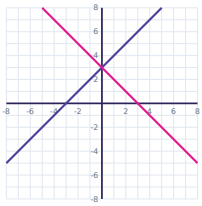

Solving Systems by Graphing · 8

Solve the system y = -x and y = x - 4 using the graph.

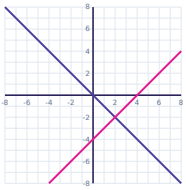

Solving Systems by Graphing · 2

ANSWER

(2, 3)

Solving Systems by Graphing · 1

ANSWER

(1, -1)

Solving Systems by Graphing · 4

ANSWER

(2, -2)

Solving Systems by Graphing · 3

ANSWER

(3, 0)

Solving Systems by Graphing · 6

ANSWER

(-1, -1)

Solving Systems by Graphing · 5

ANSWER

(3, 0)

Solving Systems by Graphing · 8

ANSWER

(2, -2)

Solving Systems by Graphing · 7

ANSWER

(0, 3)

Solving Systems by Graphing · 9

Solve the system y = -2x and y = -x using the graph.

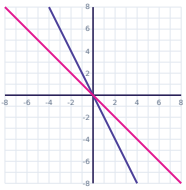

Solving Systems by Graphing · 10

Solve the system y = 2x - 1 and y = -1 using the graph.

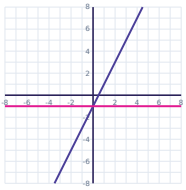

Solving Systems by Graphing · 11

Solve the system y = -2x + 6 and y = 2x - 6 using the graph.

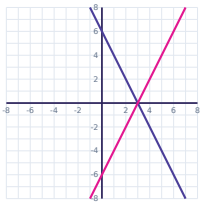

Solving Systems by Graphing · 12

Solve the system y = x - 1 and y = -1 using the graph.

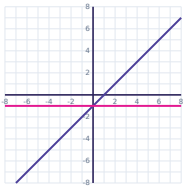

Solving Systems by Graphing · 13

Solve the system y = 3 and y = -x + 4 using the graph.

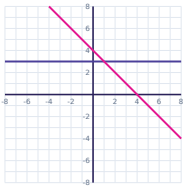

Solving Systems by Graphing · 14

Solve the system y = x + 2 and y = -2x - 1 using the graph.

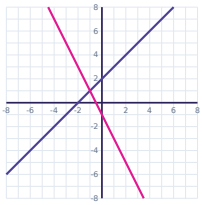

Solving Systems by Graphing · 15

Solve the system y = -2x - 2 and y = x - 2 using the graph.

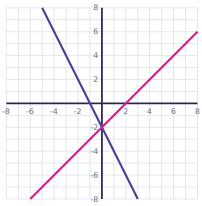

Solving Systems by Graphing · 16

Solve the system y = 2x - 2 and y = 0 using the graph.

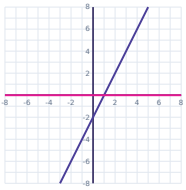

Solving Systems by Graphing · 10

ANSWER

(0, -1)

Solving Systems by Graphing · 9

ANSWER

(0, 0)

Solving Systems by Graphing · 12

ANSWER

(0, -1)

Solving Systems by Graphing · 11

ANSWER

(3, 0)

Solving Systems by Graphing · 14

ANSWER

(-1, 1)

Solving Systems by Graphing · 13

ANSWER

(1, 3)

Solving Systems by Graphing · 16

ANSWER

(1, 0)

Solving Systems by Graphing · 15

ANSWER

(0, -2)

Solving Systems by Graphing · 17

Solve the system y = -x - 3 and y = x + 1 using the graph.

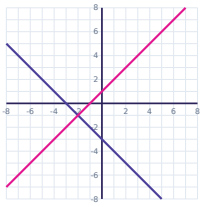

Solving Systems by Graphing · 18

Solve the system y = -x - 1 and y = 2x - 7 using the graph.

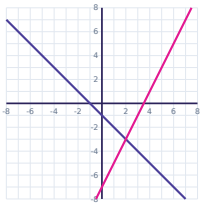

Solving Systems by Graphing · 19

Solve the system y = -3x + 4 and y = -x using the graph.

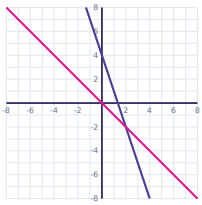

Solving Systems by Graphing · 20

Solve the system y = 2x + 4 and y = -x + 4 using the graph.

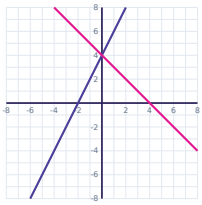

Solving Systems by Graphing · 21

Solve the system y = -2x - 7 and y = x + 5 using the graph.

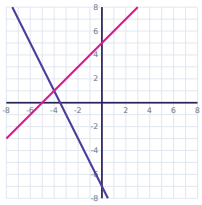

Solving Systems by Graphing · 22

Solve the system y = 2x - 5 and y = -x - 2 using the graph.

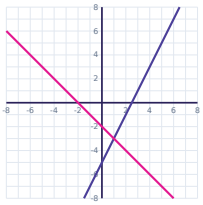

Solving Systems by Graphing · 23

Solve the system y = x - 4 and y = 2x - 5 using the graph.

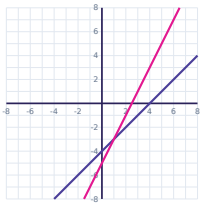

Solving Systems by Graphing · 24

Solve the system y = x + 1 and y = -x + 3 using the graph.

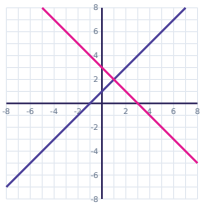

Solving Systems by Graphing · 18

ANSWER

(2, -3)

Solving Systems by Graphing · 17

ANSWER

(-2, -1)

Solving Systems by Graphing · 20

ANSWER

(0, 4)

Solving Systems by Graphing · 19

ANSWER

(2, -2)

Solving Systems by Graphing · 22

ANSWER

(1, -3)

Solving Systems by Graphing · 21

ANSWER

(-4, 1)

Solving Systems by Graphing · 24

ANSWER

(1, 2)

Solving Systems by Graphing · 23

ANSWER

(1, -3)