Task card 1 Slope from a Graph, Table or Two P...

Find the slope of the line.

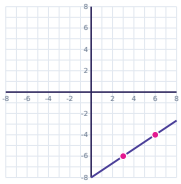

Task card 2 Slope from a Graph, Table or Two P...

Find the slope of the line through (-1, 5) and (1, -1).

Task card 3 Slope from a Graph, Table or Two P...

Find the slope of the line.

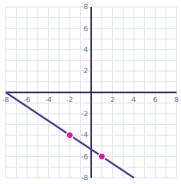

Task card 4 Slope from a Graph, Table or Two P...

Find the slope of the line through (0, 8) and (-2, 5).

Task card 5 Slope from a Graph, Table or Two P...

Find the slope of the line.

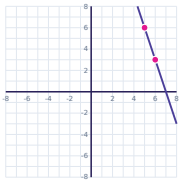

Task card 6 Slope from a Graph, Table or Two P...

Find the slope of the line through (-4, -8) and (-3, -8).

Task card 7 Slope from a Graph, Table or Two P...

Find the slope of the line.

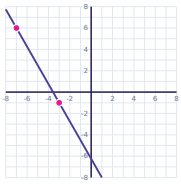

Task card 8 Slope from a Graph, Table or Two P...

Find the slope of the line through (3, -3) and (5, -13).

Task card 9 Slope from a Graph, Table or Two P...

Find the slope of the line.

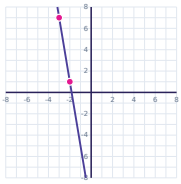

Task card 10 Slope from a Graph, Table or Two P...

Find the slope of the line through (-3, -5) and (9, -14).

Task card 11 Slope from a Graph, Table or Two P...

Find the slope of the line.

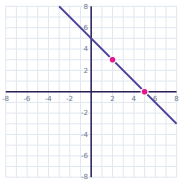

Task card 12 Slope from a Graph, Table or Two P...

Find the slope of the line through (5, 0) and (7, 0).

Task card 13 Slope from a Graph, Table or Two P...

Find the slope of the line.

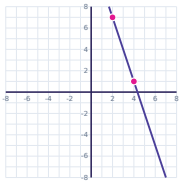

Task card 14 Slope from a Graph, Table or Two P...

Find the slope of the line through (-4, -3) and (4, 5).

Task card 15 Slope from a Graph, Table or Two P...

Find the slope of the line.

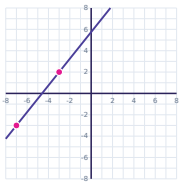

Task card 16 Slope from a Graph, Table or Two P...

Find the slope of the line through (-3, -5) and (0, -2).

Task card 17 Slope from a Graph, Table or Two P...

Find the slope of the line.

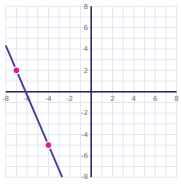

Task card 18 Slope from a Graph, Table or Two P...

Find the slope of the line through (-1, 2) and (-1, 6).

Task card 19 Slope from a Graph, Table or Two P...

Find the slope of the line.

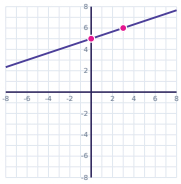

Task card 20 Slope from a Graph, Table or Two P...

Find the slope of the line through (-4, -1) and (-6, 0).

Task card 21 Slope from a Graph, Table or Two P...

Find the slope of the line.

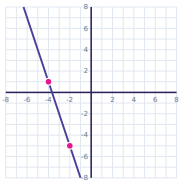

Task card 22 Slope from a Graph, Table or Two P...

Find the slope of the line through (9, -5) and (11, 0).

Task card 23 Slope from a Graph, Table or Two P...

Find the slope of the line.

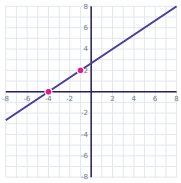

Task card 24 Slope from a Graph, Table or Two P...

Find the slope of the line through (9, 6) and (11, 6).

Slope from a Graph, Table or Two Points Task Cards

Recording sheet · Grade 8 · Find the slope. Write it as a whole number or a fraction in lowest terms, or write "undefined".

Scan to check your answers

Name: _____ Date: _____

1	2	3	4
5	6	7	8
9	10	11	12
13	14	15	16
17	18	19	20
21	22	23	24

Slope from a Graph, Table or Two Points Task Cards: Answer Key

Grade 8 · Medium

The answers online

1. $\frac{2}{3}$	**2.** -3	**3.** $\frac{2}{-3}$
4. $\frac{3}{2}$	**5.** -3	**6.** 0
7. $\frac{7}{-4}$	**8.** -5	**9.** -6
10. $\frac{3}{-4}$	**11.** -1	**12.** 0
13. -3	**14.** 1	**15.** $\frac{5}{4}$
16. 1	**17.** $\frac{7}{-3}$	**18.** undefined
19. $\frac{1}{3}$	**20.** $\frac{1}{-2}$	**21.** -3
22. $\frac{5}{2}$	**23.** $\frac{2}{3}$	**24.** 0