Task card 1 Slope from a Graph, Table or Two P...

Find the slope of the line.

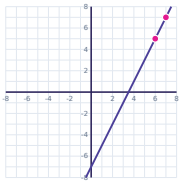

Task card 2 Slope from a Graph, Table or Two P...

Find the slope of the line through (-1, -9) and (-2, -8).

Task card 3 Slope from a Graph, Table or Two P...

Find the slope of the line.

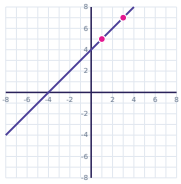

Task card 4 Slope from a Graph, Table or Two P...

Find the slope of the line through (-9, -6) and (-11, -5).

Task card 5 Slope from a Graph, Table or Two P...

Find the slope of the line.

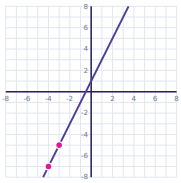

Task card 6 Slope from a Graph, Table or Two P...

Find the slope of the line through (-5, -4) and (-4, -3).

Task card 7 Slope from a Graph, Table or Two P...

Find the slope of the line.

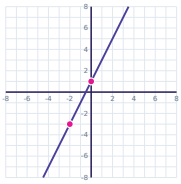

Task card 8 Slope from a Graph, Table or Two P...

Find the slope of the line through (-5, 3) and (-4, 7).

Task card 9 Slope from a Graph, Table or Two P...

Find the slope of the line.

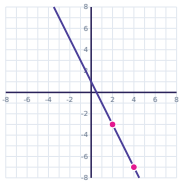

Task card 10 Slope from a Graph, Table or Two P...

Find the slope of the line through (-5, 2) and (-4, 5).

Task card 11 Slope from a Graph, Table or Two P...

Find the slope of the line.

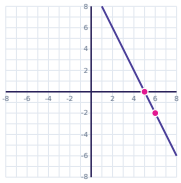

Task card 12 Slope from a Graph, Table or Two P...

Find the slope of the line through (-9, -3) and (-8, -5).

Task card 13 Slope from a Graph, Table or Two P...

Find the slope of the line.

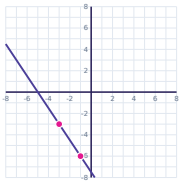

Task card 14 Slope from a Graph, Table or Two P...

Find the slope of the line through (-2, -5) and (1, -2).

Task card 15 Slope from a Graph, Table or Two P...

Find the slope of the line.

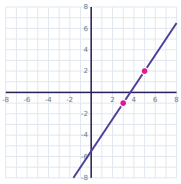

Task card 16 Slope from a Graph, Table or Two P...

Find the slope of the line through (-5, -8) and (-3, -11).

Task card 17 Slope from a Graph, Table or Two P...

Find the slope of the line.

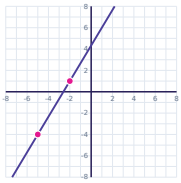

Task card 18 Slope from a Graph, Table or Two P...

Find the slope of the line through (4, -7) and (7, -9).

Task card 19 Slope from a Graph, Table or Two P...

Find the slope of the line.

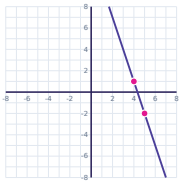

Task card 20 Slope from a Graph, Table or Two P...

Find the slope of the line through (-3, -3) and (-5, 0).

Task card 21 Slope from a Graph, Table or Two P...

Find the slope of the line.

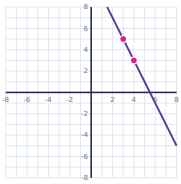

Task card 22 Slope from a Graph, Table or Two P...

Find the slope of the line through (9, -8) and (7, -6).

Task card 23 Slope from a Graph, Table or Two P...

Find the slope of the line.

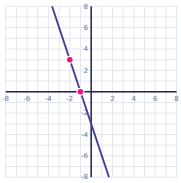

Task card 24 Slope from a Graph, Table or Two P...

Find the slope of the line through (-5, -2) and (-6, -3).

Slope from a Graph, Table or Two Points Task Cards

Recording sheet · Grade 8 · Find the slope. Write it as a whole number or a fraction in lowest terms, or write "undefined".

Scan to check your answers

Name: _____ Date: _____

1	2	3	4
5	6	7	8
9	10	11	12
13	14	15	16
17	18	19	20
21	22	23	24

Slope from a Graph, Table or Two Points Task Cards: Answer Key

Grade 8 · Easy

The answers online

1. 2	**2.** -1	**3.** 1
4. $\frac{1}{-2}$	**5.** 2	**6.** 1
7. 2	**8.** 4	**9.** -2
10. 3	**11.** -2	**12.** -2
13. $\frac{3}{-2}$	**14.** 1	**15.** $\frac{3}{2}$
16. $\frac{3}{-2}$	**17.** $\frac{5}{3}$	**18.** $\frac{2}{-3}$
19. -3	**20.** $\frac{3}{-2}$	**21.** -2
22. -1	**23.** -3	**24.** 1