Slope from a Graph, Table or Two Points · 1

Find the slope of the line.

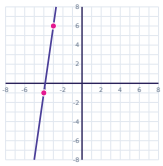

Slope from a Graph, Table or Two Points · 2

Find the slope of the line through (-9, -2) and (-1, -12).

Slope from a Graph, Table or Two Points · 3

Find the slope of the line.

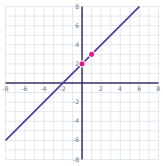

Slope from a Graph, Table or Two Points · 4

Find the slope of the line through (4, 8) and (16, 2).

Slope from a Graph, Table or Two Points · 5

Find the slope of the line.

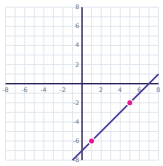

Slope from a Graph, Table or Two Points · 6

Find the slope of the line through (7, 5) and (13, 5).

Slope from a Graph, Table or Two Points · 7

Find the slope of the line.

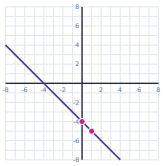

Slope from a Graph, Table or Two Points · 8

Find the slope of the line through (2, -1) and (-1, -10).

Slope from a Graph, Table or Two Points · 2

ANSWER

$$\frac{5}{-4}$$

Slope from a Graph, Table or Two Points · 1

ANSWER

7

Slope from a Graph, Table or Two Points · 4

ANSWER

$$\frac{1}{-2}$$

Slope from a Graph, Table or Two Points · 3

ANSWER

1

Slope from a Graph, Table or Two Points · 6

ANSWER

0

Slope from a Graph, Table or Two Points · 5

ANSWER

1

Slope from a Graph, Table or Two Points · 8

ANSWER

3

Slope from a Graph, Table or Two Points · 7

ANSWER

-1

Slope from a Graph, Table or Two Points · 9

Find the slope of the line.

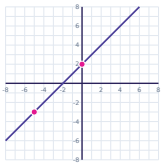

Slope from a Graph, Table or Two Points · 10

Find the slope of the line through (3, -4) and (8, -11).

Slope from a Graph, Table or Two Points · 11

Find the slope of the line.

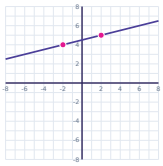

Slope from a Graph, Table or Two Points · 12

Find the slope of the line through (9, 1) and (12, 1).

Slope from a Graph, Table or Two Points · 13

Find the slope of the line.

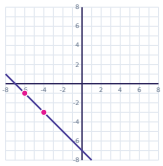

Slope from a Graph, Table or Two Points · 14

Find the slope of the line through (-1, -9) and (11, -3).

Slope from a Graph, Table or Two Points · 15

Find the slope of the line.

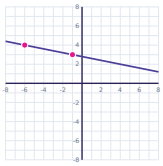

Slope from a Graph, Table or Two Points · 16

Find the slope of the line through (-4, -4) and (-7, 11).

Slope from a Graph, Table or Two Points · 10

ANSWER

$$\frac{7}{-5}$$

Slope from a Graph, Table or Two Points · 9

ANSWER

$$1$$

Slope from a Graph, Table or Two Points · 12

ANSWER

$$0$$

Slope from a Graph, Table or Two Points · 11

ANSWER

$$\frac{1}{4}$$

Slope from a Graph, Table or Two Points · 14

ANSWER

$$\frac{1}{2}$$

Slope from a Graph, Table or Two Points · 13

ANSWER

$$-1$$

Slope from a Graph, Table or Two Points · 16

ANSWER

$$-5$$

Slope from a Graph, Table or Two Points · 15

ANSWER

$$\frac{1}{-5}$$

Slope from a Graph, Table or Two Points · 17

Find the slope of the line.

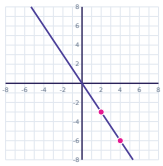

Slope from a Graph, Table or Two Points · 18

Find the slope of the line through (-3, -6) and (2, -6).

Slope from a Graph, Table or Two Points · 19

Find the slope of the line.

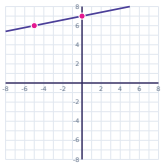

Slope from a Graph, Table or Two Points · 20

Find the slope of the line through (0, 5) and (-6, 13).

Slope from a Graph, Table or Two Points · 21

Find the slope of the line.

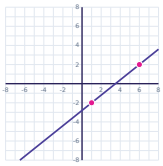

Slope from a Graph, Table or Two Points · 22

Find the slope of the line through (-8, 2) and (-3, 0).

Slope from a Graph, Table or Two Points · 23

Find the slope of the line.

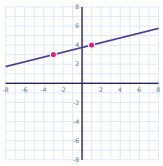

Slope from a Graph, Table or Two Points · 24

Find the slope of the line through (4, -7) and (-4, -7).

Slope from a Graph, Table or Two Points · 18

ANSWER

$$0$$

Slope from a Graph, Table or Two Points · 17

ANSWER

$$\frac{3}{-2}$$

Slope from a Graph, Table or Two Points · 20

ANSWER

$$\frac{4}{-3}$$

Slope from a Graph, Table or Two Points · 19

ANSWER

$$\frac{1}{5}$$

Slope from a Graph, Table or Two Points · 22

ANSWER

$$\frac{2}{-5}$$

Slope from a Graph, Table or Two Points · 21

ANSWER

$$\frac{4}{5}$$

Slope from a Graph, Table or Two Points · 24

ANSWER

$$0$$

Slope from a Graph, Table or Two Points · 23

ANSWER

$$\frac{1}{4}$$