Slope from a Graph, Table or Two Points · 1

Find the slope of the line.

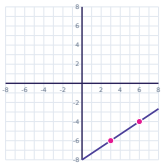

Slope from a Graph, Table or Two Points · 2

Find the slope of the line through (-1, 5) and (1, -1).

Slope from a Graph, Table or Two Points · 3

Find the slope of the line.

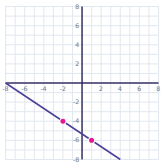

Slope from a Graph, Table or Two Points · 4

Find the slope of the line through (0, 8) and (-2, 5).

Slope from a Graph, Table or Two Points · 5

Find the slope of the line.

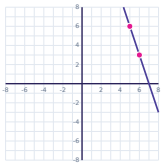

Slope from a Graph, Table or Two Points · 6

Find the slope of the line through (-4, -8) and (-3, -8).

Slope from a Graph, Table or Two Points · 7

Find the slope of the line.

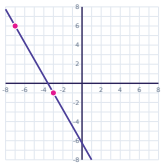

Slope from a Graph, Table or Two Points · 8

Find the slope of the line through (3, -3) and (5, -13).

Slope from a Graph, Table or Two Points · 2

ANSWER

-3

Slope from a Graph, Table or Two Points · 1

ANSWER

$\frac{2}{3}$

Slope from a Graph, Table or Two Points · 4

ANSWER

$\frac{3}{2}$

Slope from a Graph, Table or Two Points · 3

ANSWER

$\frac{2}{-3}$

Slope from a Graph, Table or Two Points · 6

ANSWER

0

Slope from a Graph, Table or Two Points · 5

ANSWER

-3

Slope from a Graph, Table or Two Points · 8

ANSWER

-5

Slope from a Graph, Table or Two Points · 7

ANSWER

$\frac{7}{-4}$

Slope from a Graph, Table or Two Points · 9

Find the slope of the line.

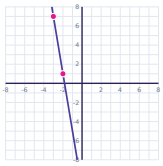

Slope from a Graph, Table or Two Points · 10

Find the slope of the line through (-3, -5) and (9, -14).

Slope from a Graph, Table or Two Points · 11

Find the slope of the line.

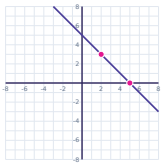

Slope from a Graph, Table or Two Points · 12

Find the slope of the line through (5, 0) and (7, 0).

Slope from a Graph, Table or Two Points · 13

Find the slope of the line.

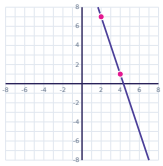

Slope from a Graph, Table or Two Points · 14

Find the slope of the line through (-4, -3) and (4, 5).

Slope from a Graph, Table or Two Points · 15

Find the slope of the line.

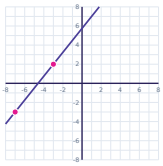

Slope from a Graph, Table or Two Points · 16

Find the slope of the line through (-3, -5) and (0, -2).

Slope from a Graph, Table or Two Points · 10

ANSWER

$$\frac{3}{-4}$$

Slope from a Graph, Table or Two Points · 9

ANSWER

-6

Slope from a Graph, Table or Two Points · 12

ANSWER

0

Slope from a Graph, Table or Two Points · 11

ANSWER

-1

Slope from a Graph, Table or Two Points · 14

ANSWER

1

Slope from a Graph, Table or Two Points · 13

ANSWER

-3

Slope from a Graph, Table or Two Points · 16

ANSWER

1

Slope from a Graph, Table or Two Points · 15

ANSWER

$$\frac{5}{4}$$

Slope from a Graph, Table or Two Points · 17

Find the slope of the line.

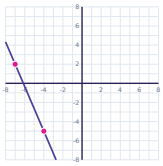

Slope from a Graph, Table or Two Points · 18

Find the slope of the line through (-1, 2) and (-1, 6).

Slope from a Graph, Table or Two Points · 19

Find the slope of the line.

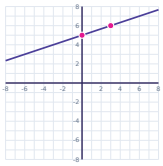

Slope from a Graph, Table or Two Points · 20

Find the slope of the line through (-4, -1) and (-6, 0).

Slope from a Graph, Table or Two Points · 21

Find the slope of the line.

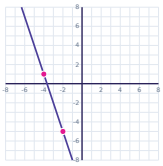

Slope from a Graph, Table or Two Points · 22

Find the slope of the line through (9, -5) and (11, 0).

Slope from a Graph, Table or Two Points · 23

Find the slope of the line.

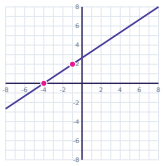

Slope from a Graph, Table or Two Points · 24

Find the slope of the line through (9, 6) and (11, 6).

Slope from a Graph, Table or Two Points · 18

ANSWER

undefined

Slope from a Graph, Table or Two Points · 17

ANSWER

$$\frac{7}{-3}$$

Slope from a Graph, Table or Two Points · 20

ANSWER

$$\frac{1}{-2}$$

Slope from a Graph, Table or Two Points · 19

ANSWER

$$\frac{1}{3}$$

Slope from a Graph, Table or Two Points · 22

ANSWER

$$\frac{5}{2}$$

Slope from a Graph, Table or Two Points · 21

ANSWER

-3

Slope from a Graph, Table or Two Points · 24

ANSWER

0

Slope from a Graph, Table or Two Points · 23

ANSWER

$$\frac{2}{3}$$