Pythagorean Theorem (Intro) · 1

A right triangle has legs of length 6 and 8.

Find the hypotenuse.

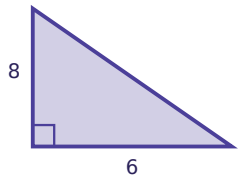

Pythagorean Theorem (Intro) · 2

A right triangle has legs of length 8 and 6.

Find the hypotenuse.

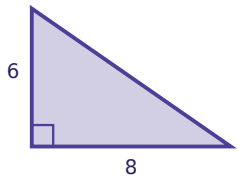

Pythagorean Theorem (Intro) · 3

A right triangle has legs of length 3 and 4.

Find the hypotenuse.

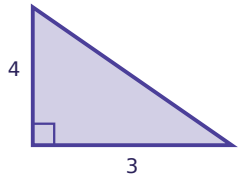

Pythagorean Theorem (Intro) · 4

A right triangle has legs of length 12 and 5.

Find the hypotenuse.

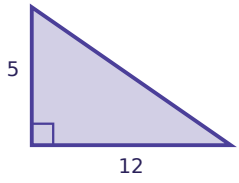

Pythagorean Theorem (Intro) · 5

A right triangle has legs of length 5 and 12.

Find the hypotenuse.

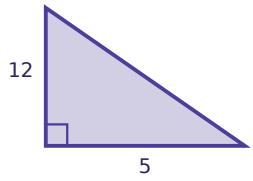

Pythagorean Theorem (Intro) · 6

A right triangle has legs of length 4 and 3.

Find the hypotenuse.

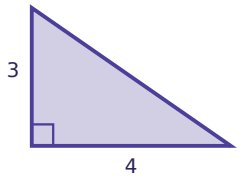

Pythagorean Theorem (Intro) · 7

A right triangle has legs of length 12 and 9.

Find the hypotenuse.

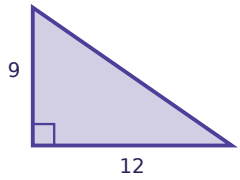

Pythagorean Theorem (Intro) · 8

A right triangle has legs of length 9 and 12.

Find the hypotenuse.

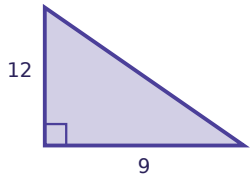

Pythagorean Theorem (Intro) · 2

ANSWER

10

Pythagorean Theorem (Intro) · 1

ANSWER

10

Pythagorean Theorem (Intro) · 4

ANSWER

13

Pythagorean Theorem (Intro) · 3

ANSWER

5

Pythagorean Theorem (Intro) · 6

ANSWER

5

Pythagorean Theorem (Intro) · 5

ANSWER

13

Pythagorean Theorem (Intro) · 8

ANSWER

15

Pythagorean Theorem (Intro) · 7

ANSWER

15

Pythagorean Theorem (Intro) · 9

A right triangle has legs of length 8 and 15.

Find the hypotenuse.

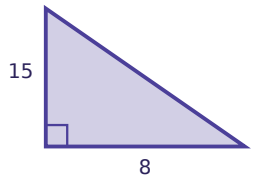

Pythagorean Theorem (Intro) · 10

A right triangle has legs of length 15 and 8.

Find the hypotenuse.

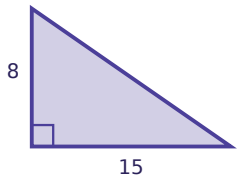

Pythagorean Theorem (Intro) · 10

ANSWER

17

Pythagorean Theorem (Intro) · 9

ANSWER

17