Task card 1 Proportional Relationships & Unit...

12 tickets cost $66.00 in all. What is the unit price in dollars per ticket?

Task card 2 Proportional Relationships & Unit...

5 tickets cost $18.75 in all. What is the unit price in dollars per ticket?

Task card 3 Proportional Relationships & Unit...

7 pounds of apples cost $40.25 in all. What is the unit price in dollars per pound of apples?

Task card 4 Proportional Relationships & Unit...

The graph shows how much Leo earns. What is the unit rate in dollars per hour?

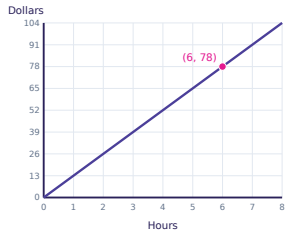

Task card 5 Proportional Relationships & Unit...

8 bottles of juice cost $32.00 in all. What is the unit price in dollars per bottle of juice?

Task card 6 Proportional Relationships & Unit...

3 notebooks cost $10.50 in all. What is the unit price in dollars per notebook?

Task card 7 Proportional Relationships & Unit...

The graph shows how far a runner goes. What is the unit rate in meters per second?

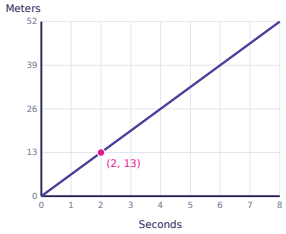

Task card 8 Proportional Relationships & Unit...

10 packs of gum cost $45.00 in all. What is the unit price in dollars per pack of gum?

Task card 9 Proportional Relationships & Unit...

12 packs of gum cost $78.00 in all. What is the unit price in dollars per pack of gum?

Task card 10 Proportional Relationships & Unit...

The graph shows how far a runner goes. What is the unit rate in meters per second?

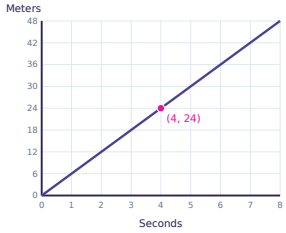

Task card 11 Proportional Relationships & Unit...

7 notebooks cost $36.75 in all. What is the unit price in dollars per notebook?

Task card 12 Proportional Relationships & Unit...

6 tickets cost $10.50 in all. What is the unit price in dollars per ticket?

Task card 13 Proportional Relationships & Unit...

The graph shows how much Leo earns. What is the unit rate in dollars per hour?

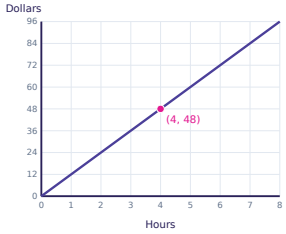

Task card 14 Proportional Relationships & Unit...

11 notebooks cost $79.75 in all. What is the unit price in dollars per notebook?

Task card 15 Proportional Relationships & Unit...

7 tickets cost $26.25 in all. What is the unit price in dollars per ticket?

Task card 16 Proportional Relationships & Unit...

The graph shows how much Leo earns. What is the unit rate in dollars per hour?

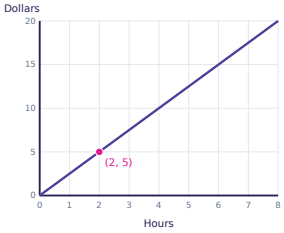

Task card 17 Proportional Relationships & Unit...

4 pounds of apples cost $7.00 in all. What is the unit price in dollars per pound of apples?

Task card 18 Proportional Relationships & Unit...

10 tickets cost $12.50 in all. What is the unit price in dollars per ticket?

Task card 19 Proportional Relationships & Unit...

6 tickets cost $39.00 in all. What is the unit price in dollars per ticket?

Task card 20 Proportional Relationships & Unit...

10 tickets cost $47.50 in all. What is the unit price in dollars per ticket?

Task card 21 Proportional Relationships & Unit...

The graph shows how far a runner goes. What is the unit rate in meters per second?

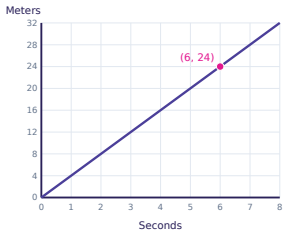

Task card 22 Proportional Relationships & Unit...

7 bottles of juice cost $52.50 in all. What is the unit price in dollars per bottle of juice?

Task card 23 Proportional Relationships & Unit...

3 tickets cost $21.75 in all. What is the unit price in dollars per ticket?

Task card 24 Proportional Relationships & Unit...

8 bottles of juice cost $34.00 in all. What is the unit price in dollars per bottle of juice?

Proportional Relationships & Unit Rate Task Cards

Recording sheet · Grade 8 · Answer each question. Give the unit rate as a number.

Scan to check your answers

Name: _____ Date: _____

1	2	3	4
5	6	7	8
9	10	11	12
13	14	15	16
17	18	19	20
21	22	23	24

Proportional Relationships & Unit Rate Task Cards: Answer Key

Grade 8 · Medium

The answers online

1. 5.5	**2.** 3.75	**3.** 5.75
4. 13	**5.** 4	**6.** 3.5
7. 6.5	**8.** 4.5	**9.** 6.5
10. 6	**11.** 5.25	**12.** 1.75
13. 12	**14.** 7.25	**15.** 3.75
16. 2.5	**17.** 1.75	**18.** 1.25
19. 6.5	**20.** 4.75	**21.** 4
22. 7.5	**23.** 7.25	**24.** 4.25