Task card 1 Proportional Relationships & Unit...

The graph shows how far a runner goes. What is the unit rate in meters per second?

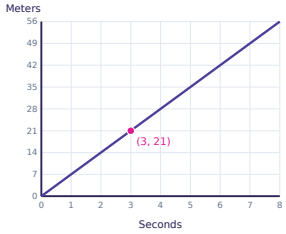

Task card 2 Proportional Relationships & Unit...

9 tickets cost $11.25 in all. What is the unit price in dollars per ticket?

Task card 3 Proportional Relationships & Unit...

3 tickets cost $3.00 in all. What is the unit price in dollars per ticket?

Task card 4 Proportional Relationships & Unit...

The graph shows how far a runner goes. What is the unit rate in meters per second?

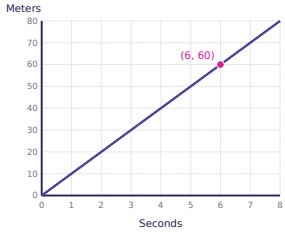

Task card 5 Proportional Relationships & Unit...

10 packs of gum cost $57.50 in all. What is the unit price in dollars per pack of gum?

Task card 6 Proportional Relationships & Unit...

The graph shows how far a runner goes. What is the unit rate in meters per second?

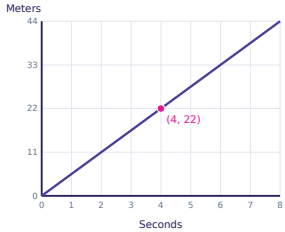

Task card 7 Proportional Relationships & Unit...

6 notebooks cost $6.00 in all. What is the unit price in dollars per notebook?

Task card 8 Proportional Relationships & Unit...

12 notebooks cost $75.00 in all. What is the unit price in dollars per notebook?

Task card 9 Proportional Relationships & Unit...

10 packs of gum cost $20.00 in all. What is the unit price in dollars per pack of gum?

Task card 10 Proportional Relationships & Unit...

12 notebooks cost $60.00 in all. What is the unit price in dollars per notebook?

Task card 11 Proportional Relationships & Unit...

The graph shows how much Leo earns. What is the unit rate in dollars per hour?

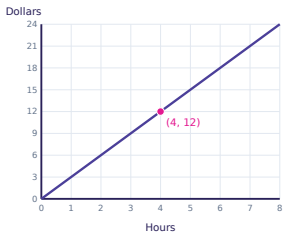

Task card 12 Proportional Relationships & Unit...

8 tickets cost $30.00 in all. What is the unit price in dollars per ticket?

Task card 13 Proportional Relationships & Unit...

6 tickets cost $15.00 in all. What is the unit price in dollars per ticket?

Task card 14 Proportional Relationships & Unit...

10 notebooks cost $35.00 in all. What is the unit price in dollars per notebook?

Task card 15 Proportional Relationships & Unit...

The graph shows how much Leo earns. What is the unit rate in dollars per hour?

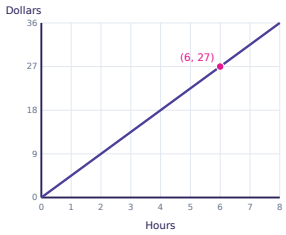

Task card 16 Proportional Relationships & Unit...

4 notebooks cost $13.00 in all. What is the unit price in dollars per notebook?

Task card 17 Proportional Relationships & Unit...

The graph shows how much Leo earns. What is the unit rate in dollars per hour?

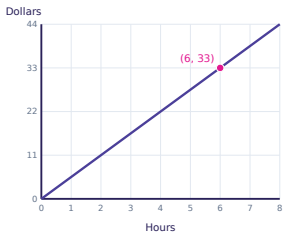

Task card 18 Proportional Relationships & Unit...

3 packs of gum cost $9.00 in all. What is the unit price in dollars per pack of gum?

Task card 19 Proportional Relationships & Unit...

6 pounds of apples cost $7.50 in all. What is the unit price in dollars per pound of apples?

Task card 20 Proportional Relationships & Unit...

9 packs of gum cost $18.00 in all. What is the unit price in dollars per pack of gum?

Task card 21 Proportional Relationships & Unit...

The graph shows how far a runner goes. What is the unit rate in meters per second?

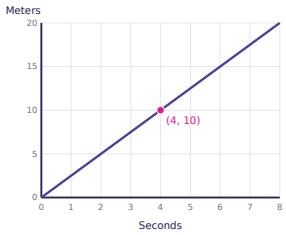

Task card 22 Proportional Relationships & Unit...

7 tickets cost $28.00 in all. What is the unit price in dollars per ticket?

Task card 23 Proportional Relationships & Unit...

The graph shows how much Leo earns. What is the unit rate in dollars per hour?

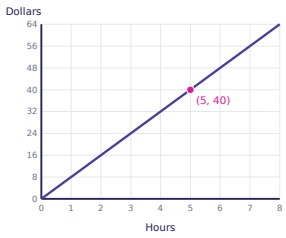

Task card 24 Proportional Relationships & Unit...

6 bottles of juice cost $43.50 in all. What is the unit price in dollars per bottle of juice?

Proportional Relationships & Unit Rate Task Cards

Recording sheet · Grade 8 · Answer each question. Give the unit rate as a number.

Scan to check your answers

Name: _____ Date: _____

1	2	3	4
5	6	7	8
9	10	11	12
13	14	15	16
17	18	19	20
21	22	23	24

Proportional Relationships & Unit Rate Task Cards: Answer Key

Grade 8 · Hard

The answers online

1. 7	**2.** 1.25	**3.** 1
4. 10	**5.** 5.75	**6.** 5.5
7. 1	**8.** 6.25	**9.** 2
10. 5	**11.** 3	**12.** 3.75
13. 2.5	**14.** 3.5	**15.** 4.5
16. 3.25	**17.** 5.5	**18.** 3
19. 1.25	**20.** 2	**21.** 2.5
22. 4	**23.** 8	**24.** 7.25