Task card 1 Proportional Relationships & Unit...

8 notebooks cost $20.00 in all. What is the unit price in dollars per notebook?

Task card 2 Proportional Relationships & Unit...

4 bottles of juice cost $15.00 in all. What is the unit price in dollars per bottle of juice?

Task card 3 Proportional Relationships & Unit...

The graph shows how much Leo earns. What is the unit rate in dollars per hour?

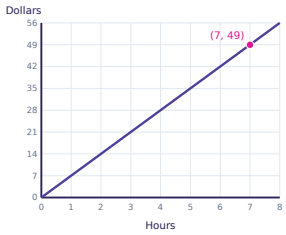

Task card 4 Proportional Relationships & Unit...

6 pounds of apples cost $24.00 in all. What is the unit price in dollars per pound of apples?

Task card 5 Proportional Relationships & Unit...

9 bottles of juice cost $31.50 in all. What is the unit price in dollars per bottle of juice?

Task card 6 Proportional Relationships & Unit...

4 pounds of apples cost $8.00 in all. What is the unit price in dollars per pound of apples?

Task card 7 Proportional Relationships & Unit...

12 bottles of juice cost $18.00 in all. What is the unit price in dollars per bottle of juice?

Task card 8 Proportional Relationships & Unit...

10 bottles of juice cost $22.50 in all. What is the unit price in dollars per bottle of juice?

Task card 9 Proportional Relationships & Unit...

The graph shows how far a runner goes. What is the unit rate in meters per second?

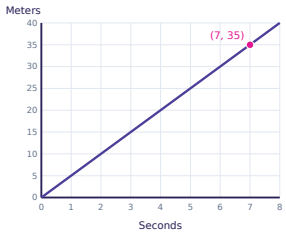

Task card 10 Proportional Relationships & Unit...

7 bottles of juice cost $8.75 in all. What is the unit price in dollars per bottle of juice?

Task card 11 Proportional Relationships & Unit...

The graph shows how far a runner goes. What is the unit rate in meters per second?

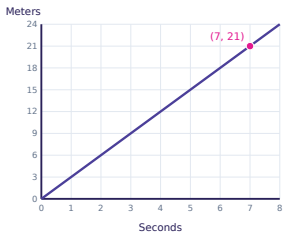

Task card 12 Proportional Relationships & Unit...

7 pounds of apples cost $28.00 in all. What is the unit price in dollars per pound of apples?

Task card 13 Proportional Relationships & Unit...

The graph shows how much Leo earns. What is the unit rate in dollars per hour?

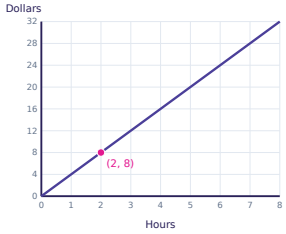

Task card 14 Proportional Relationships & Unit...

10 notebooks cost $35.00 in all. What is the unit price in dollars per notebook?

Task card 15 Proportional Relationships & Unit...

3 pounds of apples cost $9.75 in all. What is the unit price in dollars per pound of apples?

Task card 16 Proportional Relationships & Unit...

7 packs of gum cost $26.25 in all. What is the unit price in dollars per pack of gum?

Task card 17 Proportional Relationships & Unit...

8 notebooks cost $6.00 in all. What is the unit price in dollars per notebook?

Task card 18 Proportional Relationships & Unit...

The graph shows how far a runner goes. What is the unit rate in meters per second?

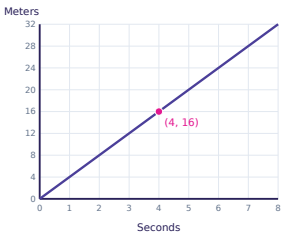

Task card 19 Proportional Relationships & Unit...

6 notebooks cost $24.00 in all. What is the unit price in dollars per notebook?

Task card 20 Proportional Relationships & Unit...

5 packs of gum cost $3.75 in all. What is the unit price in dollars per pack of gum?

Task card 21 Proportional Relationships & Unit...

10 packs of gum cost $17.50 in all. What is the unit price in dollars per pack of gum?

Task card 22 Proportional Relationships & Unit...

The graph shows how much Leo earns. What is the unit rate in dollars per hour?

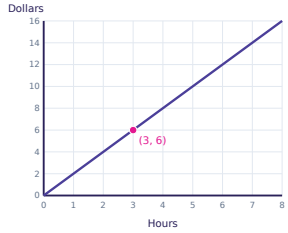

Task card 23 Proportional Relationships & Unit...

6 bottles of juice cost $10.50 in all. What is the unit price in dollars per bottle of juice?

Task card 24 Proportional Relationships & Unit...

8 bottles of juice cost $26.00 in all. What is the unit price in dollars per bottle of juice?

Proportional Relationships & Unit Rate Task Cards

Recording sheet · Grade 8 · Answer each question. Give the unit rate as a number.

Scan to check your answers

Name: _____ Date: _____

1	2	3	4
5	6	7	8
9	10	11	12
13	14	15	16
17	18	19	20
21	22	23	24

Proportional Relationships & Unit Rate Task Cards: Answer Key

Grade 8 · Easy

The answers online

1. 2.5	**2.** 3.75	**3.** 7
4. 4	**5.** 3.5	**6.** 2
7. 1.5	**8.** 2.25	**9.** 5
10. 1.25	**11.** 3	**12.** 4
13. 4	**14.** 3.5	**15.** 3.25
16. 3.75	**17.** 0.75	**18.** 4
19. 4	**20.** 0.75	**21.** 1.75
22. 2	**23.** 1.75	**24.** 3.25