Proportional Relationships & Unit Rate · 1

12 tickets cost $66.00 in all. What is the unit price in dollars per ticket?

Proportional Relationships & Unit Rate · 2

5 tickets cost $18.75 in all. What is the unit price in dollars per ticket?

Proportional Relationships & Unit Rate · 3

7 pounds of apples cost $40.25 in all. What is the unit price in dollars per pound of apples?

Proportional Relationships & Unit Rate · 4

The graph shows how much Leo earns. What is the unit rate in dollars per hour?



Proportional Relationships & Unit Rate · 5

8 bottles of juice cost $32.00 in all. What is the unit price in dollars per bottle of juice?

Proportional Relationships & Unit Rate · 6

3 notebooks cost $10.50 in all. What is the unit price in dollars per notebook?

Proportional Relationships & Unit Rate · 7

The graph shows how far a runner goes. What is the unit rate in meters per second?

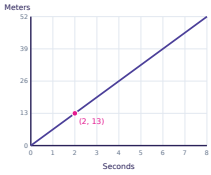

Proportional Relationships & Unit Rate · 8

10 packs of gum cost $45.00 in all. What is the unit price in dollars per pack of gum?

Proportional Relationships & Unit Rate · 2

ANSWER

3.75

Proportional Relationships & Unit Rate · 1

ANSWER

5.5

Proportional Relationships & Unit Rate · 4

ANSWER

13

Proportional Relationships & Unit Rate · 3

ANSWER

5.75

Proportional Relationships & Unit Rate · 6

ANSWER

3.5

Proportional Relationships & Unit Rate · 5

ANSWER

4

Proportional Relationships & Unit Rate · 8

ANSWER

4.5

Proportional Relationships & Unit Rate · 7

ANSWER

6.5

Proportional Relationships & Unit Rate · 9

12 packs of gum cost $78.00 in all. What is the unit price in dollars per pack of gum?

Proportional Relationships & Unit Rate · 10

The graph shows how far a runner goes. What is the unit rate in meters per second?

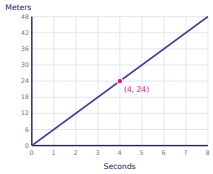

Proportional Relationships & Unit Rate · 11

7 notebooks cost $36.75 in all. What is the unit price in dollars per notebook?

Proportional Relationships & Unit Rate · 12

6 tickets cost $10.50 in all. What is the unit price in dollars per ticket?

Proportional Relationships & Unit Rate · 13

The graph shows how much Leo earns. What is the unit rate in dollars per hour?

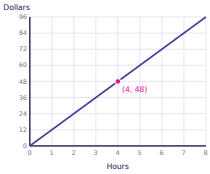

Proportional Relationships & Unit Rate · 14

11 notebooks cost $79.75 in all. What is the unit price in dollars per notebook?

Proportional Relationships & Unit Rate · 15

7 tickets cost $26.25 in all. What is the unit price in dollars per ticket?

Proportional Relationships & Unit Rate · 16

The graph shows how much Leo earns. What is the unit rate in dollars per hour?



Proportional Relationships & Unit Rate · 10

ANSWER

6

Proportional Relationships & Unit Rate · 9

ANSWER

6.5

Proportional Relationships & Unit Rate · 12

ANSWER

1.75

Proportional Relationships & Unit Rate · 11

ANSWER

5.25

Proportional Relationships & Unit Rate · 14

ANSWER

7.25

Proportional Relationships & Unit Rate · 13

ANSWER

12

Proportional Relationships & Unit Rate · 16

ANSWER

2.5

Proportional Relationships & Unit Rate · 15

ANSWER

3.75

Proportional Relationships & Unit Rate · 17

4 pounds of apples cost $7.00 in all. What is the unit price in dollars per pound of apples?

Proportional Relationships & Unit Rate · 18

10 tickets cost $12.50 in all. What is the unit price in dollars per ticket?

Proportional Relationships & Unit Rate · 19

6 tickets cost $39.00 in all. What is the unit price in dollars per ticket?

Proportional Relationships & Unit Rate · 20

10 tickets cost $47.50 in all. What is the unit price in dollars per ticket?

Proportional Relationships & Unit Rate · 21

The graph shows how far a runner goes. What is the unit rate in meters per second?

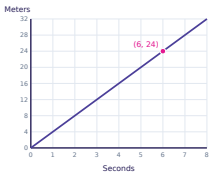

Proportional Relationships & Unit Rate · 22

7 bottles of juice cost $52.50 in all. What is the unit price in dollars per bottle of juice?

Proportional Relationships & Unit Rate · 23

3 tickets cost $21.75 in all. What is the unit price in dollars per ticket?

Proportional Relationships & Unit Rate · 24

8 bottles of juice cost $34.00 in all. What is the unit price in dollars per bottle of juice?

Proportional Relationships & Unit Rate · 18

ANSWER

1.25

Proportional Relationships & Unit Rate · 17

ANSWER

1.75

Proportional Relationships & Unit Rate · 20

ANSWER

4.75

Proportional Relationships & Unit Rate · 19

ANSWER

6.5

Proportional Relationships & Unit Rate · 22

ANSWER

7.5

Proportional Relationships & Unit Rate · 21

ANSWER

4

Proportional Relationships & Unit Rate · 24

ANSWER

4.25

Proportional Relationships & Unit Rate · 23

ANSWER

7.25