Proportional Relationships & Unit Rate · 1

The graph shows how far a runner goes. What is the unit rate in meters per second?

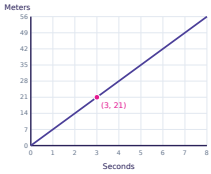

Proportional Relationships & Unit Rate · 2

9 tickets cost $11.25 in all. What is the unit price in dollars per ticket?

Proportional Relationships & Unit Rate · 3

3 tickets cost $3.00 in all. What is the unit price in dollars per ticket?

Proportional Relationships & Unit Rate · 4

The graph shows how far a runner goes. What is the unit rate in meters per second?

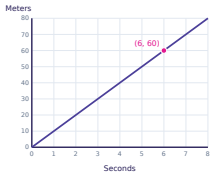

Proportional Relationships & Unit Rate · 5

10 packs of gum cost $57.50 in all. What is the unit price in dollars per pack of gum?

Proportional Relationships & Unit Rate · 6

The graph shows how far a runner goes. What is the unit rate in meters per second?

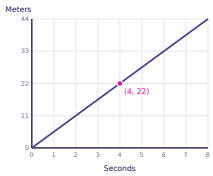

Proportional Relationships & Unit Rate · 7

6 notebooks cost $6.00 in all. What is the unit price in dollars per notebook?

Proportional Relationships & Unit Rate · 8

12 notebooks cost $75.00 in all. What is the unit price in dollars per notebook?

Proportional Relationships & Unit Rate · 2

ANSWER

1.25

Proportional Relationships & Unit Rate · 1

ANSWER

7

Proportional Relationships & Unit Rate · 4

ANSWER

10

Proportional Relationships & Unit Rate · 3

ANSWER

1

Proportional Relationships & Unit Rate · 6

ANSWER

5.5

Proportional Relationships & Unit Rate · 5

ANSWER

5.75

Proportional Relationships & Unit Rate · 8

ANSWER

6.25

Proportional Relationships & Unit Rate · 7

ANSWER

1

Proportional Relationships & Unit Rate · 9

10 packs of gum cost $20.00 in all. What is the unit price in dollars per pack of gum?

Proportional Relationships & Unit Rate · 10

12 notebooks cost $60.00 in all. What is the unit price in dollars per notebook?

Proportional Relationships & Unit Rate · 11

The graph shows how much Leo earns. What is the unit rate in dollars per hour?



Proportional Relationships & Unit Rate · 12

8 tickets cost $30.00 in all. What is the unit price in dollars per ticket?

Proportional Relationships & Unit Rate · 13

6 tickets cost $15.00 in all. What is the unit price in dollars per ticket?

Proportional Relationships & Unit Rate · 14

10 notebooks cost $35.00 in all. What is the unit price in dollars per notebook?

Proportional Relationships & Unit Rate · 15

The graph shows how much Leo earns. What is the unit rate in dollars per hour?



Proportional Relationships & Unit Rate · 16

4 notebooks cost $13.00 in all. What is the unit price in dollars per notebook?

Proportional Relationships & Unit Rate · 10

ANSWER

5

Proportional Relationships & Unit Rate · 9

ANSWER

2

Proportional Relationships & Unit Rate · 12

ANSWER

3.75

Proportional Relationships & Unit Rate · 11

ANSWER

3

Proportional Relationships & Unit Rate · 14

ANSWER

3.5

Proportional Relationships & Unit Rate · 13

ANSWER

2.5

Proportional Relationships & Unit Rate · 16

ANSWER

3.25

Proportional Relationships & Unit Rate · 15

ANSWER

4.5

Proportional Relationships & Unit Rate · 17

The graph shows how much Leo earns. What is the unit rate in dollars per hour?



Proportional Relationships & Unit Rate · 18

3 packs of gum cost $9.00 in all. What is the unit price in dollars per pack of gum?

Proportional Relationships & Unit Rate · 19

6 pounds of apples cost $7.50 in all. What is the unit price in dollars per pound of apples?

Proportional Relationships & Unit Rate · 20

9 packs of gum cost $18.00 in all. What is the unit price in dollars per pack of gum?

Proportional Relationships & Unit Rate · 21

The graph shows how far a runner goes. What is the unit rate in meters per second?

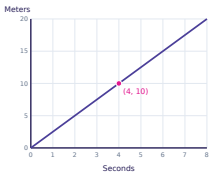

Proportional Relationships & Unit Rate · 22

7 tickets cost $28.00 in all. What is the unit price in dollars per ticket?

Proportional Relationships & Unit Rate · 23

The graph shows how much Leo earns. What is the unit rate in dollars per hour?

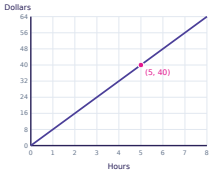

Proportional Relationships & Unit Rate · 24

6 bottles of juice cost $43.50 in all. What is the unit price in dollars per bottle of juice?

Proportional Relationships & Unit Rate · 18

ANSWER

3

Proportional Relationships & Unit Rate · 17

ANSWER

5.5

Proportional Relationships & Unit Rate · 20

ANSWER

2

Proportional Relationships & Unit Rate · 19

ANSWER

1.25

Proportional Relationships & Unit Rate · 22

ANSWER

4

Proportional Relationships & Unit Rate · 21

ANSWER

2.5

Proportional Relationships & Unit Rate · 24

ANSWER

7.25

Proportional Relationships & Unit Rate · 23

ANSWER

8