Proportional Relationships & Unit Rate · 1

8 notebooks cost $20.00 in all. What is the unit price in dollars per notebook?

Proportional Relationships & Unit Rate · 2

4 bottles of juice cost $15.00 in all. What is the unit price in dollars per bottle of juice?

Proportional Relationships & Unit Rate · 3

The graph shows how much Leo earns. What is the unit rate in dollars per hour?

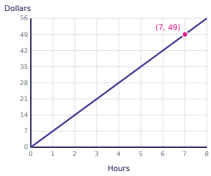

Proportional Relationships & Unit Rate · 4

6 pounds of apples cost $24.00 in all. What is the unit price in dollars per pound of apples?

Proportional Relationships & Unit Rate · 5

9 bottles of juice cost $31.50 in all. What is the unit price in dollars per bottle of juice?

Proportional Relationships & Unit Rate · 6

4 pounds of apples cost $8.00 in all. What is the unit price in dollars per pound of apples?

Proportional Relationships & Unit Rate · 7

12 bottles of juice cost $18.00 in all. What is the unit price in dollars per bottle of juice?

Proportional Relationships & Unit Rate · 8

10 bottles of juice cost $22.50 in all. What is the unit price in dollars per bottle of juice?

Proportional Relationships & Unit Rate · 2

ANSWER

3.75

Proportional Relationships & Unit Rate · 1

ANSWER

2.5

Proportional Relationships & Unit Rate · 4

ANSWER

4

Proportional Relationships & Unit Rate · 3

ANSWER

7

Proportional Relationships & Unit Rate · 6

ANSWER

2

Proportional Relationships & Unit Rate · 5

ANSWER

3.5

Proportional Relationships & Unit Rate · 8

ANSWER

2.25

Proportional Relationships & Unit Rate · 7

ANSWER

1.5

Proportional Relationships & Unit Rate · 9

The graph shows how far a runner goes. What is the unit rate in meters per second?

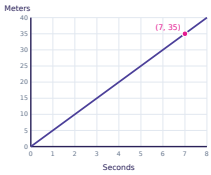

Proportional Relationships & Unit Rate · 10

7 bottles of juice cost $8.75 in all. What is the unit price in dollars per bottle of juice?

Proportional Relationships & Unit Rate · 11

The graph shows how far a runner goes. What is the unit rate in meters per second?

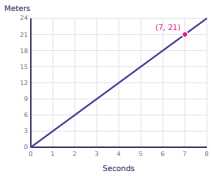

Proportional Relationships & Unit Rate · 12

7 pounds of apples cost $28.00 in all. What is the unit price in dollars per pound of apples?

Proportional Relationships & Unit Rate · 13

The graph shows how much Leo earns. What is the unit rate in dollars per hour?

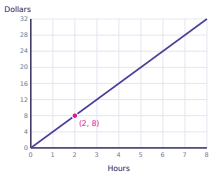

Proportional Relationships & Unit Rate · 14

10 notebooks cost $35.00 in all. What is the unit price in dollars per notebook?

Proportional Relationships & Unit Rate · 15

3 pounds of apples cost $9.75 in all. What is the unit price in dollars per pound of apples?

Proportional Relationships & Unit Rate · 16

7 packs of gum cost $26.25 in all. What is the unit price in dollars per pack of gum?

Proportional Relationships & Unit Rate · 10

ANSWER

1.25

Proportional Relationships & Unit Rate · 9

ANSWER

5

Proportional Relationships & Unit Rate · 12

ANSWER

4

Proportional Relationships & Unit Rate · 11

ANSWER

3

Proportional Relationships & Unit Rate · 14

ANSWER

3.5

Proportional Relationships & Unit Rate · 13

ANSWER

4

Proportional Relationships & Unit Rate · 16

ANSWER

3.75

Proportional Relationships & Unit Rate · 15

ANSWER

3.25

Proportional Relationships & Unit Rate · 17

8 notebooks cost $6.00 in all. What is the unit price in dollars per notebook?

Proportional Relationships & Unit Rate · 18

The graph shows how far a runner goes. What is the unit rate in meters per second?

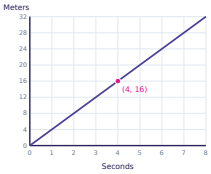

Proportional Relationships & Unit Rate · 19

6 notebooks cost $24.00 in all. What is the unit price in dollars per notebook?

Proportional Relationships & Unit Rate · 20

5 packs of gum cost $3.75 in all. What is the unit price in dollars per pack of gum?

Proportional Relationships & Unit Rate · 21

10 packs of gum cost $17.50 in all. What is the unit price in dollars per pack of gum?

Proportional Relationships & Unit Rate · 22

The graph shows how much Leo earns. What is the unit rate in dollars per hour?



Proportional Relationships & Unit Rate · 23

6 bottles of juice cost $10.50 in all. What is the unit price in dollars per bottle of juice?

Proportional Relationships & Unit Rate · 24

8 bottles of juice cost $26.00 in all. What is the unit price in dollars per bottle of juice?

Proportional Relationships & Unit Rate · 18

ANSWER

4

Proportional Relationships & Unit Rate · 17

ANSWER

0.75

Proportional Relationships & Unit Rate · 20

ANSWER

0.75

Proportional Relationships & Unit Rate · 19

ANSWER

4

Proportional Relationships & Unit Rate · 22

ANSWER

2

Proportional Relationships & Unit Rate · 21

ANSWER

1.75

Proportional Relationships & Unit Rate · 24

ANSWER

3.25

Proportional Relationships & Unit Rate · 23

ANSWER

1.75