Slope & Linear Equations · 1

Find the slope of the line through A(6, -4) and B(7, -9).

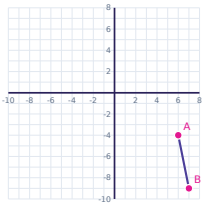

Slope & Linear Equations · 2

For the line y = 5x + 9, find y when x = -4.

Slope & Linear Equations · 3

Find the slope of the line through A(0, 0) and B(1, -6).

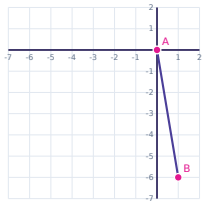

Slope & Linear Equations · 4

Find the slope of the line through A(-1, -4) and B(4, -34).

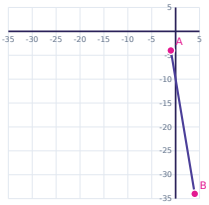

Slope & Linear Equations · 5

For the line y = -x - 7, find y when x = 5.

Slope & Linear Equations · 6

Find the slope of the line through A(6, -4) and B(7, -7).

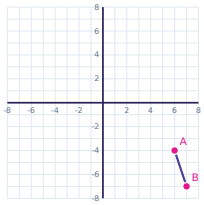

Slope & Linear Equations · 7

Find the slope of the line through A(4, 4) and B(7, 7).

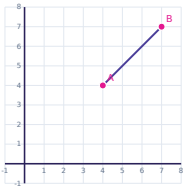

Slope & Linear Equations · 8

For the line y = -6x - 7, find y when x = -3.

Slope & Linear Equations · 2

ANSWER

-11

Slope & Linear Equations · 1

ANSWER

-5

Slope & Linear Equations · 4

ANSWER

-6

Slope & Linear Equations · 3

ANSWER

-6

Slope & Linear Equations · 6

ANSWER

-3

Slope & Linear Equations · 5

ANSWER

-12

Slope & Linear Equations · 8

ANSWER

11

Slope & Linear Equations · 7

ANSWER

1

Slope & Linear Equations · 9

Find the slope of the line through A(0, -7) and B(4, -27).

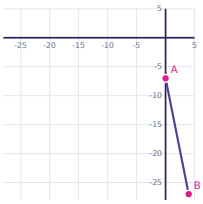

Slope & Linear Equations · 10

Find the slope of the line through A(-5, -2) and B(-1, 2).

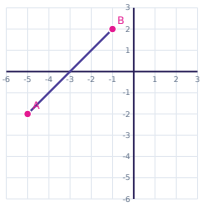

Slope & Linear Equations · 11

For the line y = 2x - 10, find y when x = 2.

Slope & Linear Equations · 12

Find the slope of the line through A(-5, -4) and B(-4, -10).

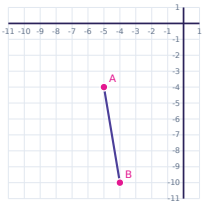

Slope & Linear Equations · 13

Find the slope of the line through A(0, -3) and B(2, 1).

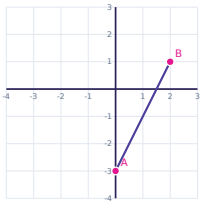

Slope & Linear Equations · 14

For the line y = 2x - 1, find y when x = -7.

Slope & Linear Equations · 15

Find the slope of the line through A(-4, 7) and B(-2, 11).

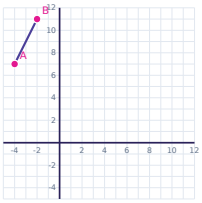

Slope & Linear Equations · 16

Find the slope of the line through A(4, 3) and B(7, -21).

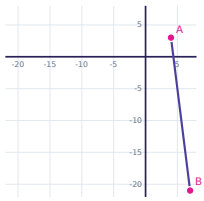

Slope & Linear Equations · 10

ANSWER

1

Slope & Linear Equations · 9

ANSWER

-5

Slope & Linear Equations · 12

ANSWER

-6

Slope & Linear Equations · 11

ANSWER

-6

Slope & Linear Equations · 14

ANSWER

-15

Slope & Linear Equations · 13

ANSWER

2

Slope & Linear Equations · 16

ANSWER

-8

Slope & Linear Equations · 15

ANSWER

2

Slope & Linear Equations · 17

For the line y = -2x + 6, find y when x = 4.

Slope & Linear Equations · 18

Find the slope of the line through A(8, -7) and B(13, 13).

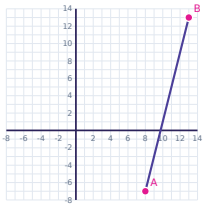

Slope & Linear Equations · 19

Find the slope of the line through A(-8, -4) and B(-7, -3).

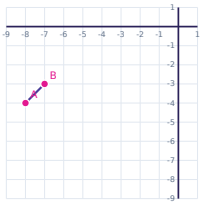

Slope & Linear Equations · 20

For the line y = -3x + 1, find y when x = -4.

Slope & Linear Equations · 21

Find the slope of the line through A(7, 1) and B(11, -3).

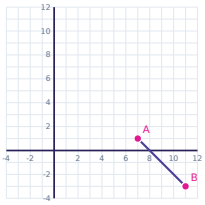

Slope & Linear Equations · 22

Find the slope of the line through A(2, 0) and B(3, -3).

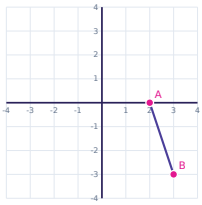

Slope & Linear Equations · 23

For the line y = 5x + 3, find y when x = -1.

Slope & Linear Equations · 24

Find the slope of the line through A(7, -6) and B(8, -9).

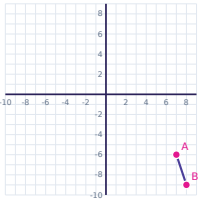

Slope & Linear Equations · 18

ANSWER

4

Slope & Linear Equations · 17

ANSWER

-2

Slope & Linear Equations · 20

ANSWER

13

Slope & Linear Equations · 19

ANSWER

1

Slope & Linear Equations · 22

ANSWER

-3

Slope & Linear Equations · 21

ANSWER

-1

Slope & Linear Equations · 24

ANSWER

-3

Slope & Linear Equations · 23

ANSWER

-2