Slope & Linear Equations · 1

Find the slope of the line through A(-8, 6) and B(-3, -4).

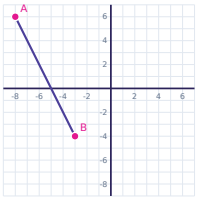

Slope & Linear Equations · 2

For the line y = -3x + 2, find y when x = -1.

Slope & Linear Equations · 3

Find the slope of the line through A(-6, -4) and B(-3, -13).

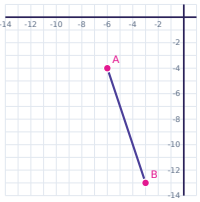

Slope & Linear Equations · 4

For the line y = 2x - 7, find y when x = -9.

Slope & Linear Equations · 5

Find the slope of the line through A(7, 3) and B(10, -3).

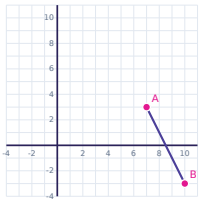

Slope & Linear Equations · 6

For the line y = 2x + 5, find y when x = 9.

Slope & Linear Equations · 7

Find the slope of the line through A(8, -4) and B(9, -6).

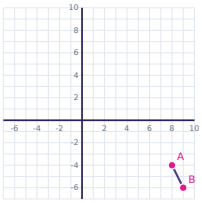

Slope & Linear Equations · 8

Find the slope of the line through A(-2, 3) and B(2, 11).

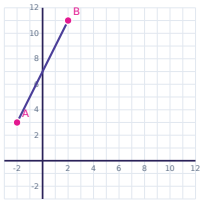

Slope & Linear Equations · 2

ANSWER

5

Slope & Linear Equations · 1

ANSWER

-2

Slope & Linear Equations · 4

ANSWER

-25

Slope & Linear Equations · 3

ANSWER

-3

Slope & Linear Equations · 6

ANSWER

23

Slope & Linear Equations · 5

ANSWER

-2

Slope & Linear Equations · 8

ANSWER

2

Slope & Linear Equations · 7

ANSWER

-2

Slope & Linear Equations · 9

For the line y = 4x - 3, find y when x = 4.

Slope & Linear Equations · 10

Find the slope of the line through A(6, -1) and B(8, 7).

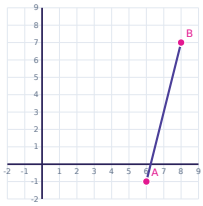

Slope & Linear Equations · 11

For the line y = -4x + 6, find y when x = 7.

Slope & Linear Equations · 12

Find the slope of the line through A(-6, 2) and B(-4, 4).

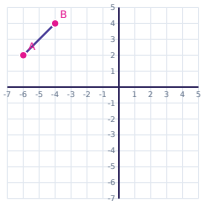

Slope & Linear Equations · 13

For the line y = -3x - 6, find y when x = 9.

Slope & Linear Equations · 14

Find the slope of the line through A(2, -8) and B(7, 12).

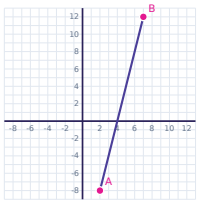

Slope & Linear Equations · 15

Find the slope of the line through A(-4, 4) and B(1, -11).

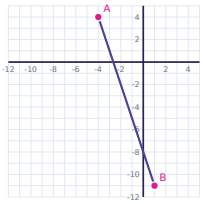

Slope & Linear Equations · 16

For the line y = x + 6, find y when x = 5.

Slope & Linear Equations · 10

ANSWER

4

Slope & Linear Equations · 9

ANSWER

13

Slope & Linear Equations · 12

ANSWER

1

Slope & Linear Equations · 11

ANSWER

-22

Slope & Linear Equations · 14

ANSWER

4

Slope & Linear Equations · 13

ANSWER

-33

Slope & Linear Equations · 16

ANSWER

11

Slope & Linear Equations · 15

ANSWER

-3

Slope & Linear Equations · 17

Find the slope of the line through A(-5, 6) and B(-1, 22).

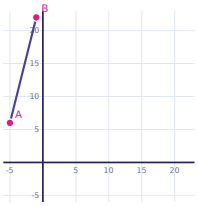

Slope & Linear Equations · 18

Find the slope of the line through A(7, 6) and B(12, 11).

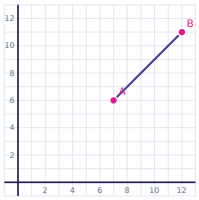

Slope & Linear Equations · 19

For the line y = -x + 5, find y when x = 4.

Slope & Linear Equations · 20

Find the slope of the line through A(1, 4) and B(3, 6).

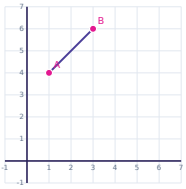

Slope & Linear Equations · 21

Find the slope of the line through A(0, -5) and B(5, -15).

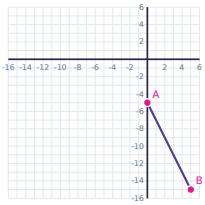

Slope & Linear Equations · 22

For the line y = 2x + 4, find y when x = 3.

Slope & Linear Equations · 23

Find the slope of the line through A(-8, -8) and B(-4, -4).

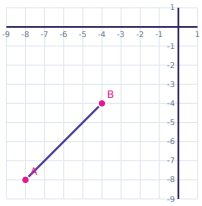

Slope & Linear Equations · 24

For the line y = -3x + 10, find y when x = 8.

Slope & Linear Equations · 18

ANSWER

1

Slope & Linear Equations · 17

ANSWER

4

Slope & Linear Equations · 20

ANSWER

1

Slope & Linear Equations · 19

ANSWER

1

Slope & Linear Equations · 22

ANSWER

10

Slope & Linear Equations · 21

ANSWER

-2

Slope & Linear Equations · 24

ANSWER

-14

Slope & Linear Equations · 23

ANSWER

1