Lines of Best Fit & Predictions · 1

The line of best fit is y = 9x + 8. Predict y when x = 5.

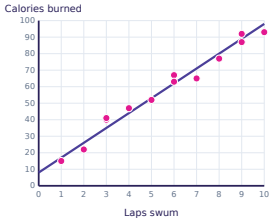

Lines of Best Fit & Predictions · 2

The line of best fit is y = 14x + 9. Predict y when x = 3.



Lines of Best Fit & Predictions · 3

The line of best fit is y = 8x + 11. What value of y does it predict when x = 0?



Lines of Best Fit & Predictions · 4

The line of best fit is y = -3x + 48. Predict y when x = 4.

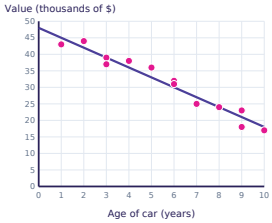

Lines of Best Fit & Predictions · 5

The line of best fit is y = 11x + 5. Predict y when x = 7.



Lines of Best Fit & Predictions · 6

The line of best fit is y = -3x + 63. What value of y does it predict when x = 0?

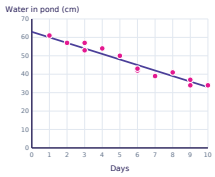

Lines of Best Fit & Predictions · 7

The line of best fit is y = 10x + 18. Predict y when x = 2.

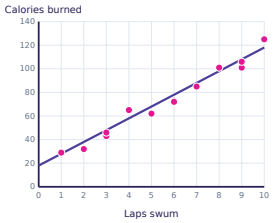

Lines of Best Fit & Predictions · 8

The line of best fit is y = 8x + 5. Predict y when x = 3.



Lines of Best Fit & Predictions · 2

ANSWER

51

Lines of Best Fit & Predictions · 1

ANSWER

53

Lines of Best Fit & Predictions · 4

ANSWER

36

Lines of Best Fit & Predictions · 3

ANSWER

11

Lines of Best Fit & Predictions · 6

ANSWER

63

Lines of Best Fit & Predictions · 5

ANSWER

82

Lines of Best Fit & Predictions · 8

ANSWER

29

Lines of Best Fit & Predictions · 7

ANSWER

38

Lines of Best Fit & Predictions · 9

The line of best fit is y = 12x + 14. What value of y does it predict when x = 0?



Lines of Best Fit & Predictions · 10

The line of best fit is y = -2x + 44. Predict y when x = 3.

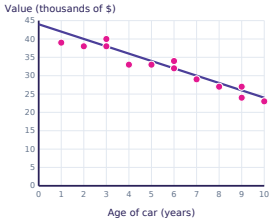

Lines of Best Fit & Predictions · 11

The line of best fit is y = -2x + 48. Predict y when x = 2.

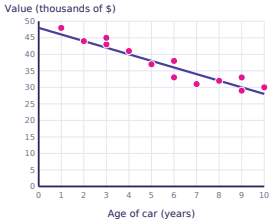

Lines of Best Fit & Predictions · 12

The line of best fit is y = 3x + 3. What value of y does it predict when x = 0?

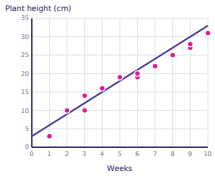

Lines of Best Fit & Predictions · 13

The line of best fit is y = 11x + 8. Predict y when x = 8.

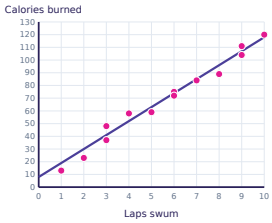

Lines of Best Fit & Predictions · 14

The line of best fit is y = 8x + 7. What value of y does it predict when x = 0?

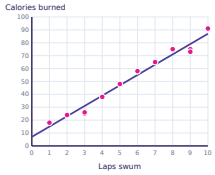

Lines of Best Fit & Predictions · 15

The line of best fit is y = x + 3. Predict y when x = 12.



Lines of Best Fit & Predictions · 16

The line of best fit is y = 14x + 13. Predict y when x = 8.



Lines of Best Fit & Predictions · 10

ANSWER

38

Lines of Best Fit & Predictions · 9

ANSWER

14

Lines of Best Fit & Predictions · 12

ANSWER

3

Lines of Best Fit & Predictions · 11

ANSWER

44

Lines of Best Fit & Predictions · 14

ANSWER

7

Lines of Best Fit & Predictions · 13

ANSWER

96

Lines of Best Fit & Predictions · 16

ANSWER

125

Lines of Best Fit & Predictions · 15

ANSWER

15

Lines of Best Fit & Predictions · 17

The line of best fit is y = 12x + 7. What value of y does it predict when x = 0?



Lines of Best Fit & Predictions · 18

The line of best fit is y = -2x + 43. Predict y when x = 14.

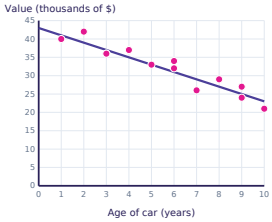

Lines of Best Fit & Predictions · 19

The line of best fit is y = -2x + 69. Predict y when x = 6.

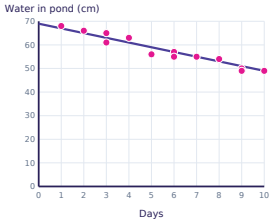

Lines of Best Fit & Predictions · 20

The line of best fit is y = 13x + 18. Predict y when x = 8.



Lines of Best Fit & Predictions · 21

The line of best fit is y = 11x + 6. What value of y does it predict when x = 0?



Lines of Best Fit & Predictions · 22

The line of best fit is y = -2x + 66. Predict y when x = 3.

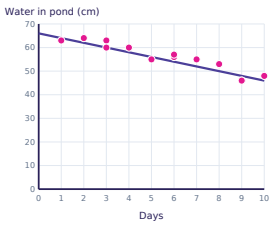

Lines of Best Fit & Predictions · 23

The line of best fit is y = -2x + 47. Predict y when x = 2.

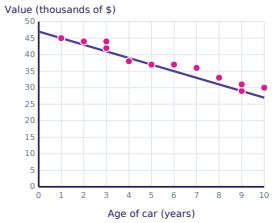

Lines of Best Fit & Predictions · 24

The line of best fit is y = 5x + 43. What value of y does it predict when x = 0?

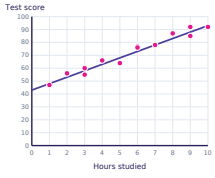

Lines of Best Fit & Predictions · 18

ANSWER

15

Lines of Best Fit & Predictions · 17

ANSWER

7

Lines of Best Fit & Predictions · 20

ANSWER

122

Lines of Best Fit & Predictions · 19

ANSWER

57

Lines of Best Fit & Predictions · 22

ANSWER

60

Lines of Best Fit & Predictions · 21

ANSWER

6

Lines of Best Fit & Predictions · 24

ANSWER

43

Lines of Best Fit & Predictions · 23

ANSWER

43