Task card 1 Increasing, Decreasing or Constant...

Is the function increasing, decreasing or constant from x = 2 to x = 5?

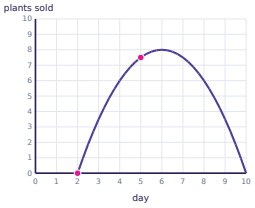

Task card 2 Increasing, Decreasing or Constant...

Is the function increasing, decreasing or constant from x = 7 to x = 8?

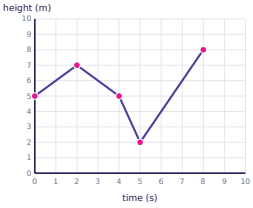

Task card 3 Increasing, Decreasing or Constant...

Is the function increasing, decreasing or constant from x = 4 to x = 6?

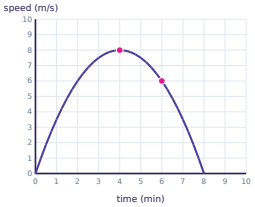

Task card 4 Increasing, Decreasing or Constant...

Is the function increasing, decreasing or constant from x = 0 to x = 2?

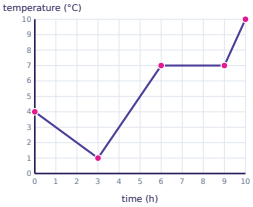

Task card 5 Increasing, Decreasing or Constant...

Is the function increasing, decreasing or constant from x = 0 to x = 2?

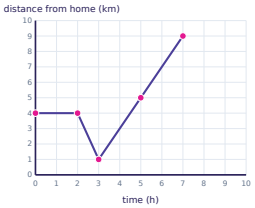

Task card 6 Increasing, Decreasing or Constant...

Is the function increasing, decreasing or constant from x = 7 to x = 8?

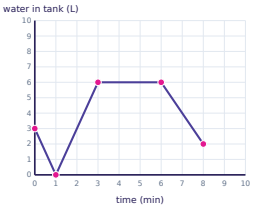

Task card 7 Increasing, Decreasing or Constant...

Is the function increasing, decreasing or constant from x = 1 to x = 2?

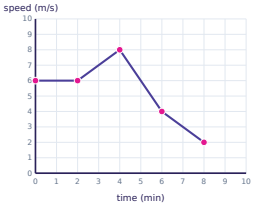

Task card 8 Increasing, Decreasing or Constant...

Is the function increasing, decreasing or constant from x = 2 to x = 3?

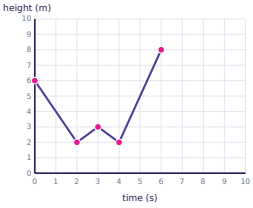

Task card 9 Increasing, Decreasing or Constant...

Is the function increasing, decreasing or constant from x = 6 to x = 7?

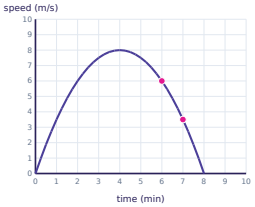

Task card 10 Increasing, Decreasing or Constant...

Is the function increasing, decreasing or constant from x = 4 to x = 5?

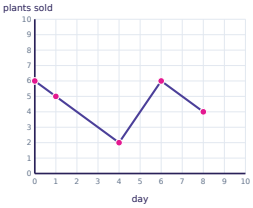

Task card 11 Increasing, Decreasing or Constant...

Is the function increasing, decreasing or constant from x = 2 to x = 3?

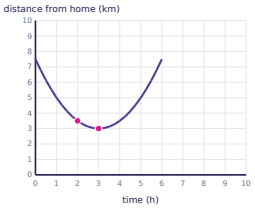

Task card 12 Increasing, Decreasing or Constant...

Is the function increasing, decreasing or constant from x = 5 to x = 6?

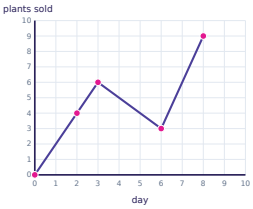

Task card 13 Increasing, Decreasing or Constant...

Is the function increasing, decreasing or constant from x = 4 to x = 5?

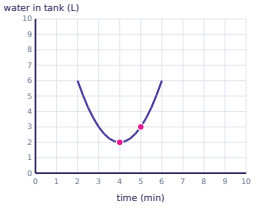

Task card 14 Increasing, Decreasing or Constant...

Is the function increasing, decreasing or constant from x = 2 to x = 3?

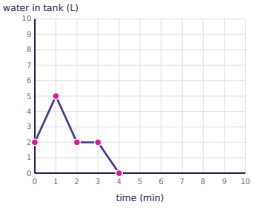

Task card 15 Increasing, Decreasing or Constant...

Is the function increasing, decreasing or constant from x = 3 to x = 5?

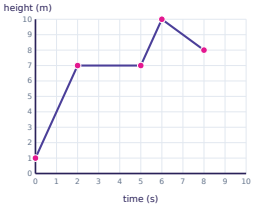

Task card 16 Increasing, Decreasing or Constant...

Is the function increasing, decreasing or constant from x = 5 to x = 6?

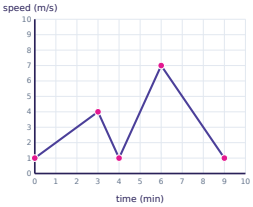

Task card 17 Increasing, Decreasing or Constant...

Is the function increasing, decreasing or constant from x = 1 to x = 2?

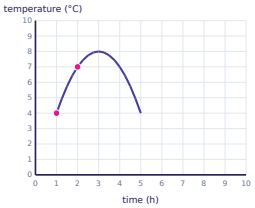

Task card 18 Increasing, Decreasing or Constant...

Is the function increasing, decreasing or constant from x = 7 to x = 8?

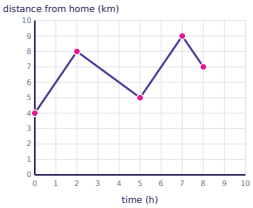

Task card 19 Increasing, Decreasing or Constant...

Is the function increasing, decreasing or constant from x = 9 to x = 10?

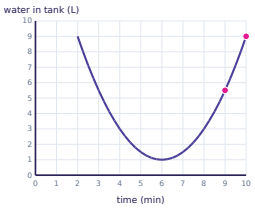

Task card 20 Increasing, Decreasing or Constant...

Is the function increasing, decreasing or constant from x = 2 to x = 3?

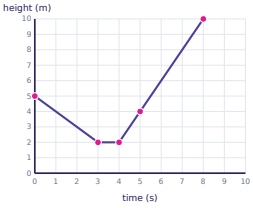

Task card 21 Increasing, Decreasing or Constant...

Is the function increasing, decreasing or constant from x = 7 to x = 8?

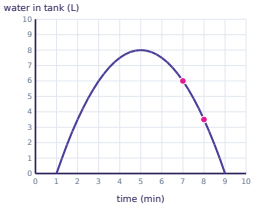

Task card 22 Increasing, Decreasing or Constant...

Is the function increasing, decreasing or constant from x = 0 to x = 1?

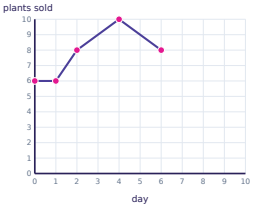

Task card 23 Increasing, Decreasing or Constant...

Is the function increasing, decreasing or constant from x = 2 to x = 4?

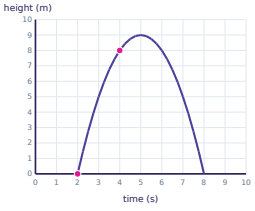

Task card 24 Increasing, Decreasing or Constant...

Is the function increasing, decreasing or constant from x = 5 to x = 6?

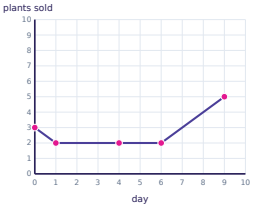

Increasing, Decreasing or Constant? (Reading Graphs) Task Cards

Recording sheet · Grade 8 · Use the graph. Write increasing, decreasing or constant.

Scan to check your answers

Name: _____ Date: _____

1	2	3	4
5	6	7	8
9	10	11	12
13	14	15	16
17	18	19	20
21	22	23	24

Increasing, Decreasing or Constant? (Reading Graphs) Task Cards: Answer Key

Grade 8 · Hard

The answers online

1. increasing	**2.** increasing	**3.** decreasing
4. decreasing	**5.** constant	**6.** decreasing
7. constant	**8.** increasing	**9.** decreasing
10. increasing	**11.** decreasing	**12.** decreasing
13. increasing	**14.** constant	**15.** constant
16. increasing	**17.** increasing	**18.** decreasing
19. increasing	**20.** decreasing	**21.** decreasing
22. constant	**23.** increasing	**24.** constant