Increasing, Decreasing or Constant? (Reading Graphs) · 1

Is the function increasing, decreasing or constant from x = 2 to x = 5?

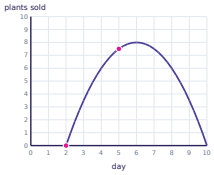

Increasing, Decreasing or Constant? (Reading Graphs) · 2

Is the function increasing, decreasing or constant from x = 7 to x = 8?

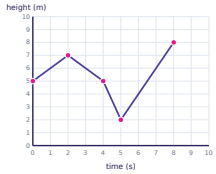

Increasing, Decreasing or Constant? (Reading Graphs) · 3

Is the function increasing, decreasing or constant from x = 4 to x = 6?

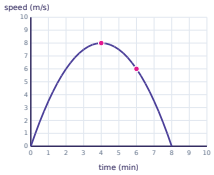

Increasing, Decreasing or Constant? (Reading Graphs) · 4

Is the function increasing, decreasing or constant from x = 0 to x = 2?

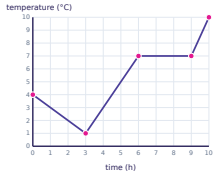

Increasing, Decreasing or Constant? (Reading Graphs) · 5

Is the function increasing, decreasing or constant from x = 0 to x = 2?

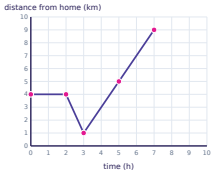

Increasing, Decreasing or Constant? (Reading Graphs) · 6

Is the function increasing, decreasing or constant from x = 7 to x = 8?

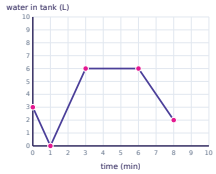

Increasing, Decreasing or Constant? (Reading Graphs) · 7

Is the function increasing, decreasing or constant from x = 1 to x = 2?

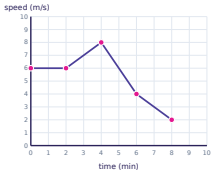

Increasing, Decreasing or Constant? (Reading Graphs) · 8

Is the function increasing, decreasing or constant from x = 2 to x = 3?

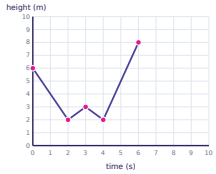

Increasing, Decreasing or Constant? (Reading Graphs) · 2

ANSWER

increasing

Increasing, Decreasing or Constant? (Reading Graphs) · 1

ANSWER

increasing

Increasing, Decreasing or Constant? (Reading Graphs) · 4

ANSWER

decreasing

Increasing, Decreasing or Constant? (Reading Graphs) · 3

ANSWER

decreasing

Increasing, Decreasing or Constant? (Reading Graphs) · 6

ANSWER

decreasing

Increasing, Decreasing or Constant? (Reading Graphs) · 5

ANSWER

constant

Increasing, Decreasing or Constant? (Reading Graphs) · 8

ANSWER

increasing

Increasing, Decreasing or Constant? (Reading Graphs) · 7

ANSWER

constant

Increasing, Decreasing or Constant? (Reading Graphs) · 9

Is the function increasing, decreasing or constant from x = 6 to x = 7?

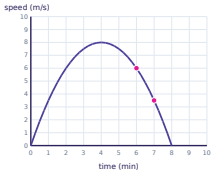

Increasing, Decreasing or Constant? (Reading Graphs) · 10

Is the function increasing, decreasing or constant from x = 4 to x = 5?

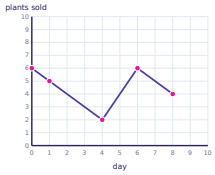

Increasing, Decreasing or Constant? (Reading Graphs) · 11

Is the function increasing, decreasing or constant from x = 2 to x = 3?

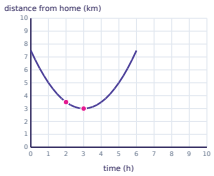

Increasing, Decreasing or Constant? (Reading Graphs) · 12

Is the function increasing, decreasing or constant from x = 5 to x = 6?

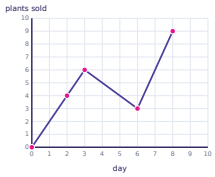

Increasing, Decreasing or Constant? (Reading Graphs) · 13

Is the function increasing, decreasing or constant from x = 4 to x = 5?

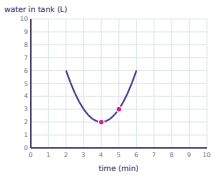

Increasing, Decreasing or Constant? (Reading Graphs) · 14

Is the function increasing, decreasing or constant from x = 2 to x = 3?

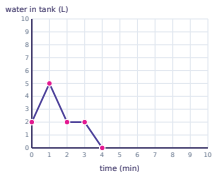

Increasing, Decreasing or Constant? (Reading Graphs) · 15

Is the function increasing, decreasing or constant from x = 3 to x = 5?

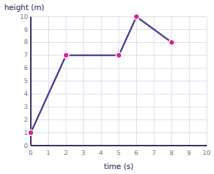

Increasing, Decreasing or Constant? (Reading Graphs) · 16

Is the function increasing, decreasing or constant from x = 5 to x = 6?

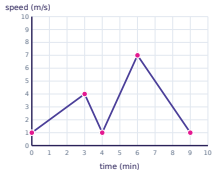

Increasing, Decreasing or Constant? (Reading Graphs) · 10

ANSWER

increasing

Increasing, Decreasing or Constant? (Reading Graphs) · 9

ANSWER

decreasing

Increasing, Decreasing or Constant? (Reading Graphs) · 12

ANSWER

decreasing

Increasing, Decreasing or Constant? (Reading Graphs) · 11

ANSWER

decreasing

Increasing, Decreasing or Constant? (Reading Graphs) · 14

ANSWER

constant

Increasing, Decreasing or Constant? (Reading Graphs) · 13

ANSWER

increasing

Increasing, Decreasing or Constant? (Reading Graphs) · 16

ANSWER

increasing

Increasing, Decreasing or Constant? (Reading Graphs) · 15

ANSWER

constant

Increasing, Decreasing or Constant? (Reading Graphs) · 17

Is the function increasing, decreasing or constant from x = 1 to x = 2?

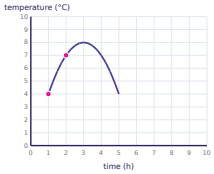

Increasing, Decreasing or Constant? (Reading Graphs) · 18

Is the function increasing, decreasing or constant from x = 7 to x = 8?

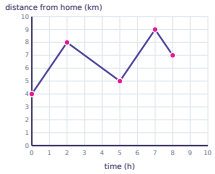

Increasing, Decreasing or Constant? (Reading Graphs) · 19

Is the function increasing, decreasing or constant from x = 9 to x = 10?

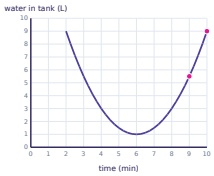

Increasing, Decreasing or Constant? (Reading Graphs) · 20

Is the function increasing, decreasing or constant from x = 2 to x = 3?

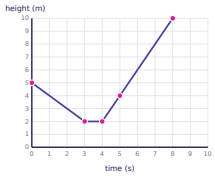

Increasing, Decreasing or Constant? (Reading Graphs) · 21

Is the function increasing, decreasing or constant from x = 7 to x = 8?

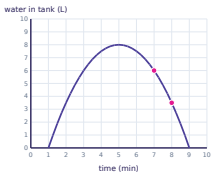

Increasing, Decreasing or Constant? (Reading Graphs) · 22

Is the function increasing, decreasing or constant from x = 0 to x = 1?

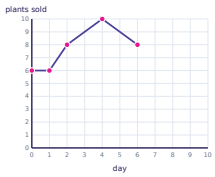

Increasing, Decreasing or Constant? (Reading Graphs) · 23

Is the function increasing, decreasing or constant from x = 2 to x = 4?

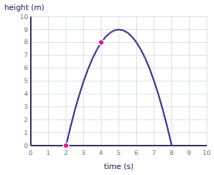

Increasing, Decreasing or Constant? (Reading Graphs) · 24

Is the function increasing, decreasing or constant from x = 5 to x = 6?

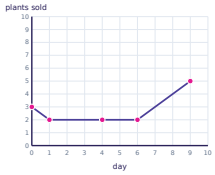

Increasing, Decreasing or Constant? (Reading Graphs) · 18

ANSWER

decreasing

Increasing, Decreasing or Constant? (Reading Graphs) · 17

ANSWER

increasing

Increasing, Decreasing or Constant? (Reading Graphs) · 20

ANSWER

decreasing

Increasing, Decreasing or Constant? (Reading Graphs) · 19

ANSWER

increasing

Increasing, Decreasing or Constant? (Reading Graphs) · 22

ANSWER

constant

Increasing, Decreasing or Constant? (Reading Graphs) · 21

ANSWER

decreasing

Increasing, Decreasing or Constant? (Reading Graphs) · 24

ANSWER

constant

Increasing, Decreasing or Constant? (Reading Graphs) · 23

ANSWER

increasing