Task card 1 Halloween Math

Ava orders 3 pumpkins online. Shipping costs $2.00, and the total is $26.00. Write and solve an equation to find the price of one pumpkin.

Task card 2 Halloween Math

A cylinder-shaped tin of cupcakes has a radius of 2 inches and a height of 3 inches. What is its volume in cubic inches?

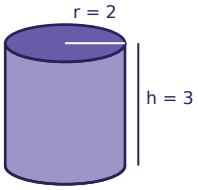

Task card 3 Halloween Math

A cylinder-shaped tin of cupcakes has a radius of 2 inches and a height of 5 inches. What is its volume in cubic inches?

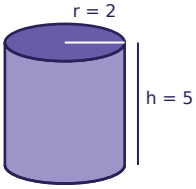

Task card 4 Halloween Math

Sam orders 3 bags of candy online. Shipping costs $8.00, and the total is $26.75. Write and solve an equation to find the price of one bag of candy.

Task card 5 Halloween Math

Leo has $15 saved for the Halloween party and adds $3 every week. How many dollars will Leo have after 6 weeks?

Task card 6 Halloween Math

A rectangular banner for the Halloween party is 12 feet long and 5 feet tall. Noah runs a string of lights straight across it, from one corner to the opposite corner. How many feet long is the string of lights?

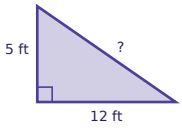

Task card 7 Halloween Math

Leo has $25 saved for the Halloween party and adds $4 every week. How many dollars will Leo have after 9 weeks?

Task card 8 Halloween Math

A rectangular banner for the Halloween party is 12 feet long and 5 feet tall. Omar runs a string of lights straight across it, from one corner to the opposite corner. How many feet long is the string of lights?

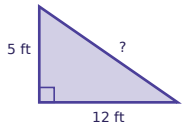

Task card 9 Halloween Math

A cylinder-shaped tin of spider cookies has a radius of 3 inches and a height of 6 inches. What is its volume in cubic inches?

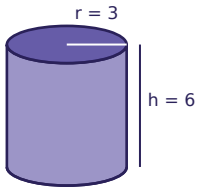

Task card 10 Halloween Math

A rectangular banner for the Halloween party is 4 feet long and 3 feet tall. Ella runs a string of lights straight across it, from one corner to the opposite corner. How many feet long is the string of lights?

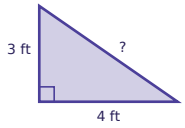

Task card 11 Halloween Math

Ella orders 5 costume masks online. Shipping costs $5.00, and the total is $32.50. Write and solve an equation to find the price of one costume mask.

Task card 12 Halloween Math

Ella has $30 saved for the Halloween party and adds $3 every week. How many dollars will Ella have after 4 weeks?

Task card 13 Halloween Math

A cylinder-shaped tin of spider cookies has a radius of 2 inches and a height of 3 inches. What is its volume in cubic inches?

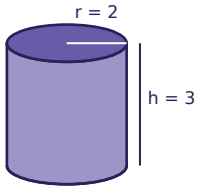

Task card 14 Halloween Math

Omar orders 5 bags of candy online. Shipping costs $7.00, and the total is $45.75. Write and solve an equation to find the price of one bag of candy.

Task card 15 Halloween Math

Ben has $20 saved for the Halloween party and adds $3 every week. How many dollars will Ben have after 3 weeks?

Task card 16 Halloween Math

A cylinder-shaped tin of pumpkin muffins has a radius of 3 inches and a height of 5 inches. What is its volume in cubic inches?

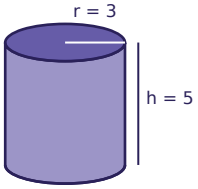

Task card 17 Halloween Math

A rectangular banner for the Halloween party is 12 feet long and 5 feet tall. Ava runs a string of lights straight across it, from one corner to the opposite corner. How many feet long is the string of lights?

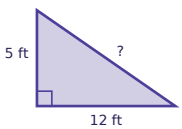

Task card 18 Halloween Math

Lily has $5 saved for the Halloween party and adds $2 every week. How many dollars will Lily have after 4 weeks?

Task card 19 Halloween Math

Omar has $15 saved for the Halloween party and adds $3 every week. How many dollars will Omar have after 5 weeks?

Task card 20 Halloween Math

A cylinder-shaped tin of cupcakes has a radius of 3 inches and a height of 6 inches. What is its volume in cubic inches?

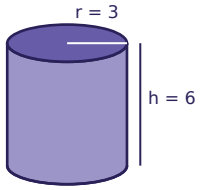

Task card 21 Halloween Math

Mia orders 2 pumpkins online. Shipping costs $7.00, and the total is $20.00. Write and solve an equation to find the price of one pumpkin.

Task card 22 Halloween Math

Mia orders 4 costume masks online. Shipping costs $5.00, and the total is $36.00. Write and solve an equation to find the price of one costume mask.

Task card 23 Halloween Math

Noah has $30 saved for the Halloween party and adds $4 every week. How many dollars will Noah have after 3 weeks?

Task card 24 Halloween Math

Zoe has $20 saved for the Halloween party and adds $4 every week. How many dollars will Zoe have after 6 weeks?

Halloween Math Task Cards

Recording sheet · Grade 8 · Read each story and solve. Write money like $3.75. Use 3.14 for π and round to the nearest tenth.

Name: _____ Date: _____

Scan to check your answers

1	2	3	4
5	6	7	8
9	10	11	12
13	14	15	16
17	18	19	20
21	22	23	24

Halloween Math Task Cards: Answer Key

Grade 8 · Easy

The answers online

1. $8.00	**2.** 37.7	**3.** 62.8
4. $6.25	**5.** 33	**6.** 13
7. 61	**8.** 13	**9.** 169.6
10. 5	**11.** $5.50	**12.** 42
13. 37.7	**14.** $7.75	**15.** 29
16. 141.3	**17.** 13	**18.** 13
19. 30	**20.** 169.6	**21.** $6.50
22. $7.75	**23.** 42	**24.** 44