Halloween Math · 1

Lily orders 4 bags of candy online. Shipping costs $2.00, and the total is $21.00. Write and solve an equation to find the price of one bag of candy.

Halloween Math · 2

Ben orders 4 costume masks online. Shipping costs $7.00, and the total is $30.00. Write and solve an equation to find the price of one costume mask.

Halloween Math · 3

Ava has $5 saved for the Halloween party and adds $4 every week. How many dollars will Ava have after 7 weeks?

Halloween Math · 4

A cylinder-shaped tin of spider cookies has a radius of 3 inches and a height of 4 inches. What is its volume in cubic inches?

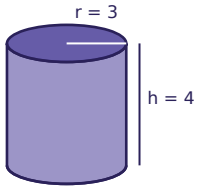

Halloween Math · 5

A cylinder-shaped tin of cupcakes has a radius of 3 inches and a height of 3 inches. What is its volume in cubic inches?

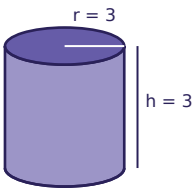

Halloween Math · 6

A rectangular banner for the Halloween party is 24 feet long and 7 feet tall. Mia runs a string of lights straight across it, from one corner to the opposite corner. How many feet long is the string of lights?

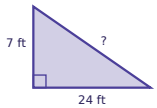

Halloween Math · 7

Ella has $15 saved for the Halloween party and adds $7 every week. How many dollars will Ella have after 5 weeks?

Halloween Math · 8

A rectangular banner for the Halloween party is 12 feet long and 9 feet tall. Ella runs a string of lights straight across it, from one corner to the opposite corner. How many feet long is the string of lights?

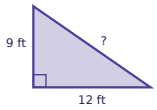

Halloween Math · 2

ANSWER

$5.75

Halloween Math · 1

ANSWER

$4.75

Halloween Math · 4

ANSWER

113

Halloween Math · 3

ANSWER

33

Halloween Math · 6

ANSWER

25

Halloween Math · 5

ANSWER

84.8

Halloween Math · 8

ANSWER

15

Halloween Math · 7

ANSWER

50

Halloween Math · 9

Omar runs a 25-foot string of lights straight across a rectangular banner for the Halloween party, from one corner to the opposite corner. The banner is 24 feet long. How tall is the banner?

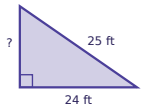

Halloween Math · 10

A rectangular banner for the Halloween party is 4 feet long and 3 feet tall. Ella runs a string of lights straight across it, from one corner to the opposite corner. How many feet long is the string of lights?

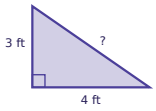

Halloween Math · 11

Omar has $5 saved for the Halloween party and adds $9 every week. After how many weeks will Omar have $59?

Halloween Math · 12

Mia orders 3 costume masks online. Shipping costs $5.50, and the total is $25.00. Write and solve an equation to find the price of one costume mask.

Halloween Math · 13

Leo orders 5 costume masks online. Shipping costs $5.50, and the total is $60.50. Write and solve an equation to find the price of one costume mask.

Halloween Math · 14

Ben has $15 saved for the Halloween party and adds $4 every week. After how many weeks will Ben have $39?

Halloween Math · 15

A cylinder-shaped tin of spider cookies has a radius of 4 inches and a height of 4 inches. What is its volume in cubic inches?

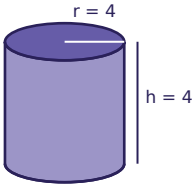

Halloween Math · 16

Mia has $15 saved for the Halloween party and adds $6 every week. How many dollars will Mia have after 6 weeks?

Halloween Math · 10

ANSWER

5

Halloween Math · 9

ANSWER

7

Halloween Math · 12

ANSWER

$6.50

Halloween Math · 11

ANSWER

6

Halloween Math · 14

ANSWER

6

Halloween Math · 13

ANSWER

$11.00

Halloween Math · 16

ANSWER

51

Halloween Math · 15

ANSWER

201

Halloween Math · 17

Leo orders 6 bags of candy online. Shipping costs $4.50, and the total is $27.00. Write and solve an equation to find the price of one bag of candy.

Halloween Math · 18

A cylinder-shaped tin of spider cookies has a radius of 2 inches and a height of 5 inches. What is its volume in cubic inches?

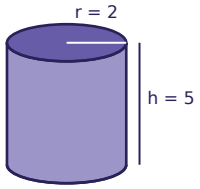

Halloween Math · 19

Lily runs a 10-foot string of lights straight across a rectangular banner for the Halloween party, from one corner to the opposite corner. The banner is 8 feet long. How tall is the banner?

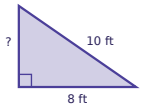

Halloween Math · 20

Sam runs a 10-foot string of lights straight across a rectangular banner for the Halloween party, from one corner to the opposite corner. The banner is 8 feet long. How tall is the banner?

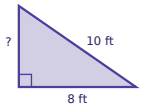

Halloween Math · 21

Noah orders 2 costume masks online. Shipping costs $5.50, and the total is $23.50. Write and solve an equation to find the price of one costume mask.

Halloween Math · 22

Noah has $5 saved for the Halloween party and adds $4 every week. After how many weeks will Noah have $37?

Halloween Math · 23

A cylinder-shaped tin of pumpkin muffins has a radius of 4 inches and a height of 6 inches. What is its volume in cubic inches?

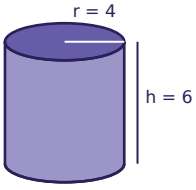

Halloween Math · 24

Ella orders 4 costume masks online. Shipping costs $7.00, and the total is $50.00. Write and solve an equation to find the price of one costume mask.

Halloween Math · 18

ANSWER

62.8

Halloween Math · 17

ANSWER

$3.75

Halloween Math · 20

ANSWER

6

Halloween Math · 19

ANSWER

6

Halloween Math · 22

ANSWER

8

Halloween Math · 21

ANSWER

$9.00

Halloween Math · 24

ANSWER

$10.75

Halloween Math · 23

ANSWER

301.4