Halloween Math · 1

A cylinder-shaped tin of spider cookies has a radius of 2 inches and a height of 7 inches. What is its volume in cubic inches?

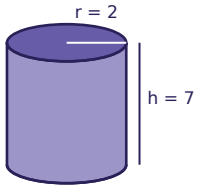

Halloween Math · 2

Ava has $10 saved for the Halloween party and adds $8 every week. How many dollars will Ava have after 10 weeks?

Halloween Math · 3

Sam runs a 13-foot string of lights straight across a rectangular banner for the Halloween party, from one corner to the opposite corner. The banner is 12 feet long. How tall is the banner?

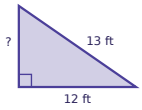

Halloween Math · 4

Zoe orders 2 costume masks online. Shipping costs $5.50, and the total is $21.50. Write and solve an equation to find the price of one costume mask.

Halloween Math · 5

A cylinder-shaped tin of spider cookies has a radius of 2 inches and a height of 10 inches. What is its volume in cubic inches?

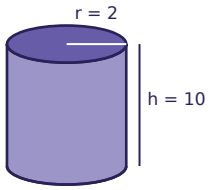

Halloween Math · 6

Ava runs a 13-foot string of lights straight across a rectangular banner for the Halloween party, from one corner to the opposite corner. The banner is 12 feet long. How tall is the banner?

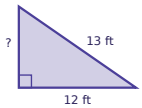

Halloween Math · 7

Noah orders 2 costume masks online. Shipping costs $6.00, and the total is $22.50. Write and solve an equation to find the price of one costume mask.

Halloween Math · 8

Zoe has $20 saved for the Halloween party and adds $5 every week. How many dollars will Zoe have after 7 weeks?

Halloween Math · 2

ANSWER

90

Halloween Math · 1

ANSWER

87.9

Halloween Math · 4

ANSWER

$8.00

Halloween Math · 3

ANSWER

5

Halloween Math · 6

ANSWER

5

Halloween Math · 5

ANSWER

125.6

Halloween Math · 8

ANSWER

55

Halloween Math · 7

ANSWER

$8.25

Halloween Math · 9

Sam runs a 5-foot string of lights straight across a rectangular banner for the Halloween party, from one corner to the opposite corner. The banner is 4 feet long. How tall is the banner?

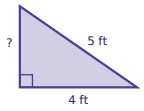

Halloween Math · 10

Ava orders 7 costume masks online. Shipping costs $7.00, and the total is $80.50. Write and solve an equation to find the price of one costume mask.

Halloween Math · 11

Zoe has $30 saved for the Halloween party and adds $12 every week. After how many weeks will Zoe have $114?

Halloween Math · 12

Ella runs a 15-foot string of lights straight across a rectangular banner for the Halloween party, from one corner to the opposite corner. The banner is 12 feet long. How tall is the banner?

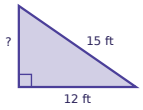

Halloween Math · 13

Noah has $10 saved for the Halloween party and adds $12 every week. How many dollars will Noah have after 10 weeks?

Halloween Math · 14

A cylinder-shaped tin of spider cookies has a radius of 6 inches and a height of 10 inches. What is its volume in cubic inches?

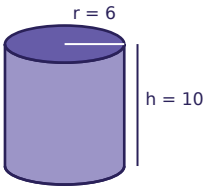

Halloween Math · 15

A cylinder-shaped tin of spider cookies has a radius of 5 inches and a height of 6 inches. What is its volume in cubic inches?

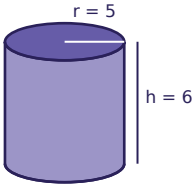

Halloween Math · 16

Ella orders 4 bags of candy online. Shipping costs $6.50, and the total is $35.50. Write and solve an equation to find the price of one bag of candy.

Halloween Math · 10

ANSWER

$10.50

Halloween Math · 9

ANSWER

3

Halloween Math · 12

ANSWER

9

Halloween Math · 11

ANSWER

7

Halloween Math · 14

ANSWER

1130.4

Halloween Math · 13

ANSWER

130

Halloween Math · 16

ANSWER

$7.25

Halloween Math · 15

ANSWER

471

Halloween Math · 17

Ella runs a 17-foot string of lights straight across a rectangular banner for the Halloween party, from one corner to the opposite corner. The banner is 15 feet long. How tall is the banner?

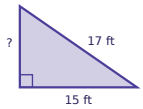

Halloween Math · 18

Ella runs a 5-foot string of lights straight across a rectangular banner for the Halloween party, from one corner to the opposite corner. The banner is 4 feet long. How tall is the banner?

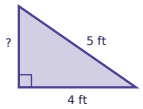

Halloween Math · 19

Ella has $15 saved for the Halloween party and adds $7 every week. How many dollars will Ella have after 6 weeks?

Halloween Math · 20

A cylinder-shaped tin of pumpkin muffins has a radius of 2 inches and a height of 9 inches. What is its volume in cubic inches?

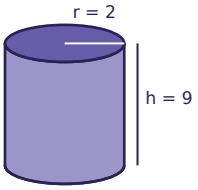

Halloween Math · 21

Lily has $15 saved for the Halloween party and adds $4 every week. How many dollars will Lily have after 7 weeks?

Halloween Math · 22

Sam orders 5 bags of candy online. Shipping costs $6.00, and the total is $29.75. Write and solve an equation to find the price of one bag of candy.

Halloween Math · 23

Noah orders 5 pumpkins online. Shipping costs $1.50, and the total is $39.00. Write and solve an equation to find the price of one pumpkin.

Halloween Math · 24

A cylinder-shaped tin of spider cookies has a radius of 5 inches and a height of 11 inches. What is its volume in cubic inches?

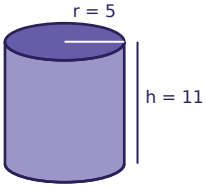

Halloween Math · 18

ANSWER

3

Halloween Math · 17

ANSWER

8

Halloween Math · 20

ANSWER

113

Halloween Math · 19

ANSWER

57

Halloween Math · 22

ANSWER

$4.75

Halloween Math · 21

ANSWER

43

Halloween Math · 24

ANSWER

863.5

Halloween Math · 23

ANSWER

$7.50