Halloween Math · 1

Ava orders 3 pumpkins online. Shipping costs $2.00, and the total is $26.00. Write and solve an equation to find the price of one pumpkin.

Halloween Math · 2

A cylinder-shaped tin of cupcakes has a radius of 2 inches and a height of 3 inches. What is its volume in cubic inches?

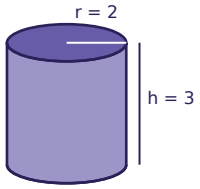

Halloween Math · 3

A cylinder-shaped tin of cupcakes has a radius of 2 inches and a height of 5 inches. What is its volume in cubic inches?

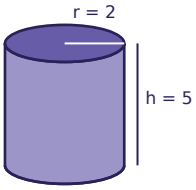

Halloween Math · 4

Sam orders 3 bags of candy online. Shipping costs $8.00, and the total is $26.75. Write and solve an equation to find the price of one bag of candy.

Halloween Math · 5

Leo has $15 saved for the Halloween party and adds $3 every week. How many dollars will Leo have after 6 weeks?

Halloween Math · 6

A rectangular banner for the Halloween party is 12 feet long and 5 feet tall. Noah runs a string of lights straight across it, from one corner to the opposite corner. How many feet long is the string of lights?

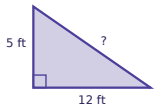

Halloween Math · 7

Leo has $25 saved for the Halloween party and adds $4 every week. How many dollars will Leo have after 9 weeks?

Halloween Math · 8

A rectangular banner for the Halloween party is 12 feet long and 5 feet tall. Omar runs a string of lights straight across it, from one corner to the opposite corner. How many feet long is the string of lights?

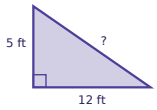

Halloween Math · 2

ANSWER

37.7

Halloween Math · 1

ANSWER

$8.00

Halloween Math · 4

ANSWER

$6.25

Halloween Math · 3

ANSWER

62.8

Halloween Math · 6

ANSWER

13

Halloween Math · 5

ANSWER

33

Halloween Math · 8

ANSWER

13

Halloween Math · 7

ANSWER

61

Halloween Math · 9

A cylinder-shaped tin of spider cookies has a radius of 3 inches and a height of 6 inches. What is its volume in cubic inches?

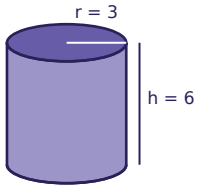

Halloween Math · 10

A rectangular banner for the Halloween party is 4 feet long and 3 feet tall. Ella runs a string of lights straight across it, from one corner to the opposite corner. How many feet long is the string of lights?

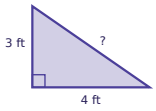

Halloween Math · 11

Ella orders 5 costume masks online. Shipping costs $5.00, and the total is $32.50. Write and solve an equation to find the price of one costume mask.

Halloween Math · 12

Ella has $30 saved for the Halloween party and adds $3 every week. How many dollars will Ella have after 4 weeks?

Halloween Math · 13

A cylinder-shaped tin of spider cookies has a radius of 2 inches and a height of 3 inches. What is its volume in cubic inches?

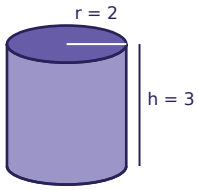

Halloween Math · 14

Omar orders 5 bags of candy online. Shipping costs $7.00, and the total is $45.75. Write and solve an equation to find the price of one bag of candy.

Halloween Math · 15

Ben has $20 saved for the Halloween party and adds $3 every week. How many dollars will Ben have after 3 weeks?

Halloween Math · 16

A cylinder-shaped tin of pumpkin muffins has a radius of 3 inches and a height of 5 inches. What is its volume in cubic inches?

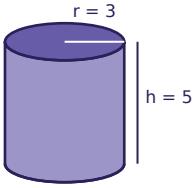

Halloween Math · 10

ANSWER

5

Halloween Math · 9

ANSWER

169.6

Halloween Math · 12

ANSWER

42

Halloween Math · 11

ANSWER

$5.50

Halloween Math · 14

ANSWER

$7.75

Halloween Math · 13

ANSWER

37.7

Halloween Math · 16

ANSWER

141.3

Halloween Math · 15

ANSWER

29

Halloween Math · 17

A rectangular banner for the Halloween party is 12 feet long and 5 feet tall. Ava runs a string of lights straight across it, from one corner to the opposite corner. How many feet long is the string of lights?

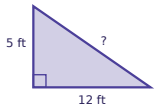

Halloween Math · 18

Lily has $5 saved for the Halloween party and adds $2 every week. How many dollars will Lily have after 4 weeks?

Halloween Math · 19

Omar has $15 saved for the Halloween party and adds $3 every week. How many dollars will Omar have after 5 weeks?

Halloween Math · 20

A cylinder-shaped tin of cupcakes has a radius of 3 inches and a height of 6 inches. What is its volume in cubic inches?

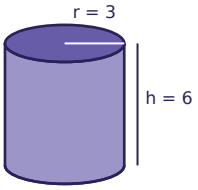

Halloween Math · 21

Mia orders 2 pumpkins online. Shipping costs $7.00, and the total is $20.00. Write and solve an equation to find the price of one pumpkin.

Halloween Math · 22

Mia orders 4 costume masks online. Shipping costs $5.00, and the total is $36.00. Write and solve an equation to find the price of one costume mask.

Halloween Math · 23

Noah has $30 saved for the Halloween party and adds $4 every week. How many dollars will Noah have after 3 weeks?

Halloween Math · 24

Zoe has $20 saved for the Halloween party and adds $4 every week. How many dollars will Zoe have after 6 weeks?

Halloween Math · 18

ANSWER

13

Halloween Math · 17

ANSWER

13

Halloween Math · 20

ANSWER

169.6

Halloween Math · 19

ANSWER

30

Halloween Math · 22

ANSWER

$7.75

Halloween Math · 21

ANSWER

$6.50

Halloween Math · 24

ANSWER

44

Halloween Math · 23

ANSWER

42