Task card 1 Graphing Points & Linear Relations...

Which quadrant is point P(7, 6) in? (I, II, III or IV)

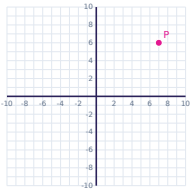

Task card 2 Graphing Points & Linear Relations...

For y = x + 1, find y when x = 0.

Task card 3 Graphing Points & Linear Relations...

Which quadrant is point P(6, -1) in? (I, II, III or IV)

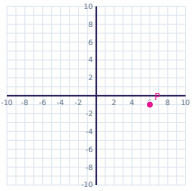

Task card 4 Graphing Points & Linear Relations...

For y = x + 2, find y when x = 2.

Task card 5 Graphing Points & Linear Relations...

Which quadrant is point P(-1, 10) in? (I, II, III or IV)

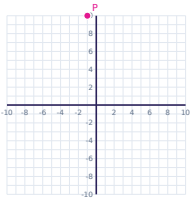

Task card 6 Graphing Points & Linear Relations...

For y = 2x - 4, find y when x = 5.

Task card 7 Graphing Points & Linear Relations...

Which quadrant is point P(-3, -9) in? (I, II, III or IV)

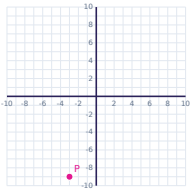

Task card 8 Graphing Points & Linear Relations...

For y = x, find y when x = 2.

Task card 9 Graphing Points & Linear Relations...

Which quadrant is point P(5, 5) in? (I, II, III or IV)

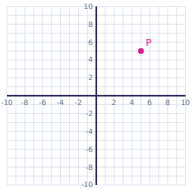

Task card 10 Graphing Points & Linear Relations...

For y = 2x - 1, find y when x = -3.

Task card 11 Graphing Points & Linear Relations...

Which quadrant is point P(-4, 3) in? (I, II, III or IV)

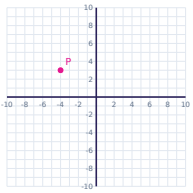

Task card 12 Graphing Points & Linear Relations...

For y = x + 5, find y when x = -1.

Task card 13 Graphing Points & Linear Relations...

Which quadrant is point P(4, -1) in? (I, II, III or IV)

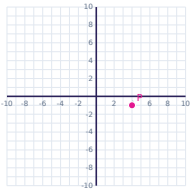

Task card 14 Graphing Points & Linear Relations...

For y = x + 5, find y when x = -4.

Task card 15 Graphing Points & Linear Relations...

Which quadrant is point P(5, -8) in? (I, II, III or IV)

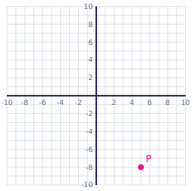

Task card 16 Graphing Points & Linear Relations...

For y = x + 2, find y when x = -5.

Task card 17 Graphing Points & Linear Relations...

Which quadrant is point P(-7, 1) in? (I, II, III or IV)

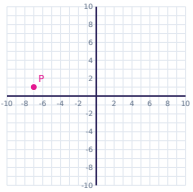

Task card 18 Graphing Points & Linear Relations...

For y = x + 3, find y when x = -4.

Task card 19 Graphing Points & Linear Relations...

Which quadrant is point P(-2, 6) in? (I, II, III or IV)

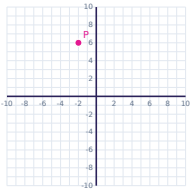

Task card 20 Graphing Points & Linear Relations...

For y = 2x + 5, find y when x = 0.

Task card 21 Graphing Points & Linear Relations...

Which quadrant is point P(7, -4) in? (I, II, III or IV)

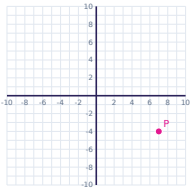

Task card 22 Graphing Points & Linear Relations...

For y = x - 3, find y when x = 1.

Task card 23 Graphing Points & Linear Relations...

Which quadrant is point P(-2, 2) in? (I, II, III or IV)

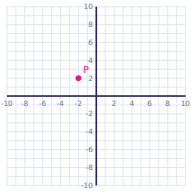

Task card 24 Graphing Points & Linear Relations...

For y = x, find y when x = -3.

Graphing Points & Linear Relationships Task Cards

Recording sheet · Grade 8 · Answer each question.

Scan to check your answers

Name: _____ Date: _____

1	2	3	4
5	6	7	8
9	10	11	12
13	14	15	16
17	18	19	20
21	22	23	24

Graphing Points & Linear Relationships Task Cards: Answer Key

Grade 8 · Easy

The answers online

1. I	**2.** 1	**3.** IV
4. 4	**5.** II	**6.** 6
7. III	**8.** 2	**9.** I
10. -7	**11.** II	**12.** 4
13. IV	**14.** 1	**15.** IV
16. -3	**17.** II	**18.** -1
19. II	**20.** 5	**21.** IV
22. -2	**23.** II	**24.** -3