Function Graphs: Increasing & Decreasing · 1

Is the function increasing, decreasing or constant from x = 0 to x = 1?

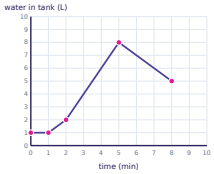

Function Graphs: Increasing & Decreasing · 2

Is the function increasing, decreasing or constant from x = 4 to x = 7?

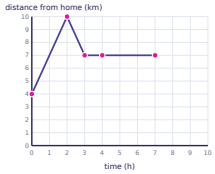

Function Graphs: Increasing & Decreasing · 3

Is the function increasing, decreasing or constant from x = 5 to x = 8?

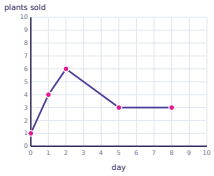

Function Graphs: Increasing & Decreasing · 4

Is the function increasing, decreasing or constant from x = 0 to x = 2?

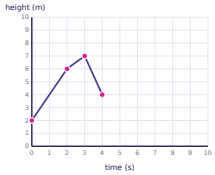

Function Graphs: Increasing & Decreasing · 5

What is the output when the input is 9?

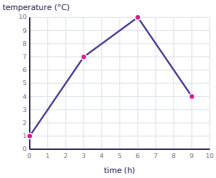

Function Graphs: Increasing & Decreasing · 6

What is the output when the input is 0?



Function Graphs: Increasing & Decreasing · 7

What is the output when the input is 4?

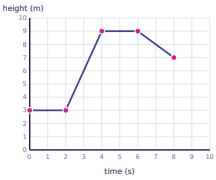

Function Graphs: Increasing & Decreasing · 8

Is the function increasing, decreasing or constant from x = 0 to x = 3?

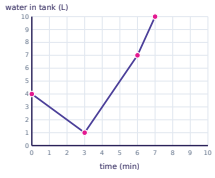

Function Graphs: Increasing & Decreasing · 2

ANSWER

constant

Function Graphs: Increasing & Decreasing · 1

ANSWER

constant

Function Graphs: Increasing & Decreasing · 4

ANSWER

increasing

Function Graphs: Increasing & Decreasing · 3

ANSWER

constant

Function Graphs: Increasing & Decreasing · 6

ANSWER

6

Function Graphs: Increasing & Decreasing · 5

ANSWER

4

Function Graphs: Increasing & Decreasing · 8

ANSWER

decreasing

Function Graphs: Increasing & Decreasing · 7

ANSWER

9

Function Graphs: Increasing & Decreasing · 9

What is the output when the input is 0?

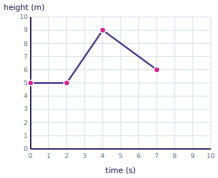

Function Graphs: Increasing & Decreasing · 10

Is the function increasing, decreasing or constant from x = 0 to x = 2?

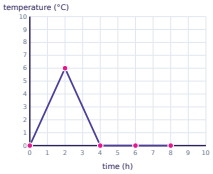

Function Graphs: Increasing & Decreasing · 11

Is the function increasing, decreasing or constant from x = 6 to x = 7?

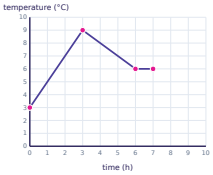

Function Graphs: Increasing & Decreasing · 12

Is the function increasing, decreasing or constant from x = 1 to x = 3?

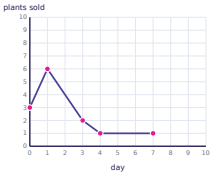

Function Graphs: Increasing & Decreasing · 13

Is the function increasing, decreasing or constant from x = 3 to x = 6?

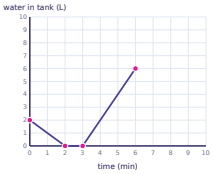

Function Graphs: Increasing & Decreasing · 14

Is the function increasing, decreasing or constant from x = 0 to x = 3?

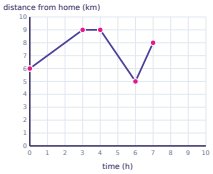

Function Graphs: Increasing & Decreasing · 15

What is the output when the input is 3?

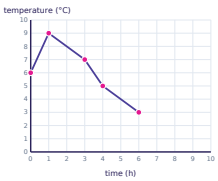

Function Graphs: Increasing & Decreasing · 16

What is the output when the input is 6?

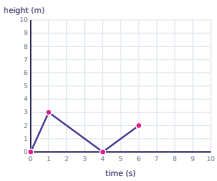

Function Graphs: Increasing & Decreasing · 10

ANSWER

increasing

Function Graphs: Increasing & Decreasing · 9

ANSWER

5

Function Graphs: Increasing & Decreasing · 12

ANSWER

decreasing

Function Graphs: Increasing & Decreasing · 11

ANSWER

constant

Function Graphs: Increasing & Decreasing · 14

ANSWER

increasing

Function Graphs: Increasing & Decreasing · 13

ANSWER

increasing

Function Graphs: Increasing & Decreasing · 16

ANSWER

2

Function Graphs: Increasing & Decreasing · 15

ANSWER

7

Function Graphs: Increasing & Decreasing · 17

What is the output when the input is 2?

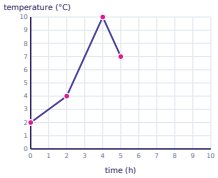

Function Graphs: Increasing & Decreasing · 18

What is the rate of change from x = 2 to x = 4?

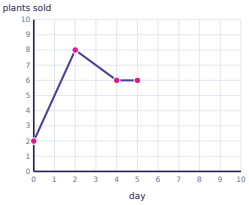

Function Graphs: Increasing & Decreasing · 19

What is the rate of change from x = 0 to x = 1?

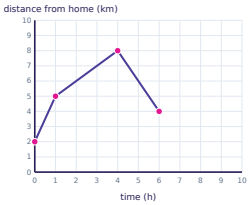

Function Graphs: Increasing & Decreasing · 20

What is the rate of change from x = 4 to x = 5?

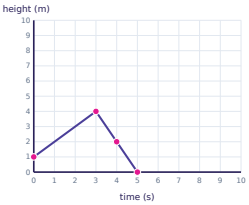

Function Graphs: Increasing & Decreasing · 21

What is the rate of change from x = 4 to x = 6?

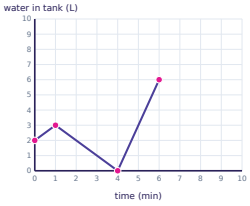

Function Graphs: Increasing & Decreasing · 22

Is the function increasing, decreasing or constant from x = 3 to x = 6?

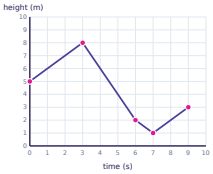

Function Graphs: Increasing & Decreasing · 23

What is the rate of change from x = 0 to x = 3?

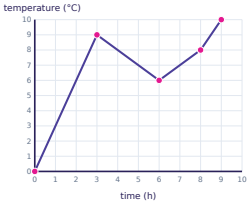

Function Graphs: Increasing & Decreasing · 24

Is the function increasing, decreasing or constant from x = 5 to x = 6?

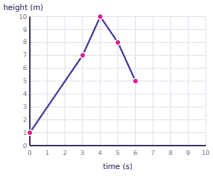

Function Graphs: Increasing & Decreasing · 18

ANSWER

-1

Function Graphs: Increasing & Decreasing · 17

ANSWER

4

Function Graphs: Increasing & Decreasing · 20

ANSWER

-2

Function Graphs: Increasing & Decreasing · 19

ANSWER

3

Function Graphs: Increasing & Decreasing · 22

ANSWER

decreasing

Function Graphs: Increasing & Decreasing · 21

ANSWER

3

Function Graphs: Increasing & Decreasing · 24

ANSWER

decreasing

Function Graphs: Increasing & Decreasing · 23

ANSWER

3