Task card 1 Easter Math

A cylinder-shaped tin of carrot muffins has a radius of 3 inches and a height of 3 inches. What is its volume in cubic inches?

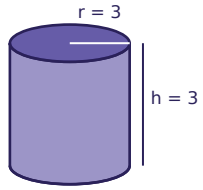

Task card 2 Easter Math

Noah orders 4 pots of tulips online. Shipping costs $2.00, and the total is $49.00. Write and solve an equation to find the price of one pot of tulips.

Task card 3 Easter Math

A cylinder-shaped tin of hot cross buns has a radius of 2 inches and a height of 7 inches. What is its volume in cubic inches?

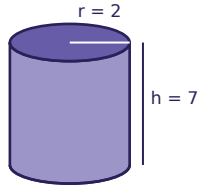

Task card 4 Easter Math

Noah has $20 saved for the Easter brunch and adds $6 every week. How many dollars will Noah have after 8 weeks?

Task card 5 Easter Math

A rectangular banner for the Easter brunch is 4 feet long and 3 feet tall. Sam runs a string of lights straight across it, from one corner to the opposite corner. How many feet long is the string of lights?

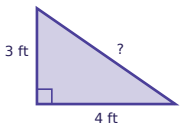

Task card 6 Easter Math

Zoe has $15 saved for the Easter brunch and adds $8 every week. How many dollars will Zoe have after 6 weeks?

Task card 7 Easter Math

A rectangular banner for the Easter brunch is 15 feet long and 8 feet tall. Sam runs a string of lights straight across it, from one corner to the opposite corner. How many feet long is the string of lights?

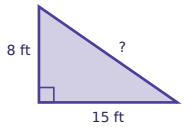

Task card 8 Easter Math

Omar orders 2 bags of jelly beans online. Shipping costs $3.00, and the total is $7.00. Write and solve an equation to find the price of one bag of jelly beans.

Task card 9 Easter Math

Ella has $25 saved for the Easter brunch and adds $2 every week. How many dollars will Ella have after 7 weeks?

Task card 10 Easter Math

Noah orders 3 chocolate bunnies online. Shipping costs $5.50, and the total is $19.75. Write and solve an equation to find the price of one chocolate bunny.

Task card 11 Easter Math

A rectangular banner for the Easter brunch is 8 feet long and 6 feet tall. Noah runs a string of lights straight across it, from one corner to the opposite corner. How many feet long is the string of lights?

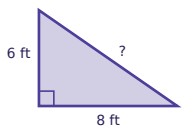

Task card 12 Easter Math

A cylinder-shaped tin of bunny cookies has a radius of 4 inches and a height of 9 inches. What is its volume in cubic inches?

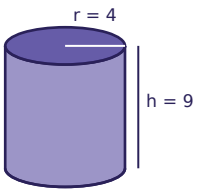

Task card 13 Easter Math

A rectangular banner for the Easter brunch is 15 feet long and 8 feet tall. Zoe runs a string of lights straight across it, from one corner to the opposite corner. How many feet long is the string of lights?

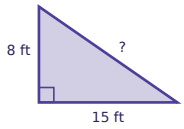

Task card 14 Easter Math

A cylinder-shaped tin of bunny cookies has a radius of 4 inches and a height of 4 inches. What is its volume in cubic inches?

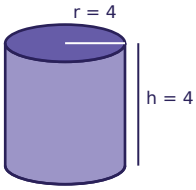

Task card 15 Easter Math

Lily has $15 saved for the Easter brunch and adds $2 every week. How many dollars will Lily have after 7 weeks?

Task card 16 Easter Math

Ava orders 4 pots of tulips online. Shipping costs $7.00, and the total is $33.00. Write and solve an equation to find the price of one pot of tulips.

Task card 17 Easter Math

Sam has $25 saved for the Easter brunch and adds $4 every week. How many dollars will Sam have after 3 weeks?

Task card 18 Easter Math

Zoe orders 5 bags of jelly beans online. Shipping costs $6.00, and the total is $16.00. Write and solve an equation to find the price of one bag of jelly beans.

Task card 19 Easter Math

Zoe has $20 saved for the Easter brunch and adds $3 every week. How many dollars will Zoe have after 7 weeks?

Task card 20 Easter Math

Noah orders 6 chocolate bunnies online. Shipping costs $7.50, and the total is $42.00. Write and solve an equation to find the price of one chocolate bunny.

Task card 21 Easter Math

Mia runs a 5-foot string of lights straight across a rectangular banner for the Easter brunch, from one corner to the opposite corner. The banner is 4 feet long. How tall is the banner?

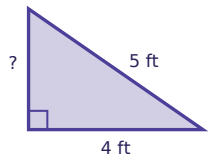

Task card 22 Easter Math

Mia runs a 13-foot string of lights straight across a rectangular banner for the Easter brunch, from one corner to the opposite corner. The banner is 12 feet long. How tall is the banner?

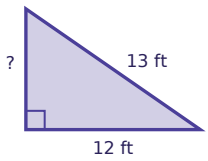

Task card 23 Easter Math

A cylinder-shaped tin of bunny cookies has a radius of 5 inches and a height of 6 inches. What is its volume in cubic inches?

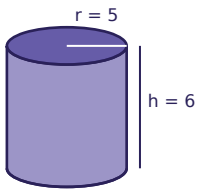

Task card 24 Easter Math

A cylinder-shaped tin of carrot muffins has a radius of 2 inches and a height of 9 inches. What is its volume in cubic inches?

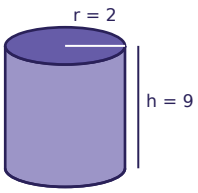

Easter Math Task Cards

Recording sheet · Grade 8 · Read each story and solve. Write money like $3.75. Use 3.14 for π and round to the nearest tenth.

Name: _____ Date: _____

Scan to check your answers

1	2	3	4
5	6	7	8
9	10	11	12
13	14	15	16
17	18	19	20
21	22	23	24

Easter Math Task Cards: Answer Key

Grade 8 · Medium

The answers online

1. 84.8	**2.** $11.75	**3.** 87.9
4. 68	**5.** 5	**6.** 63
7. 17	**8.** $2.00	**9.** 39
10. $4.75	**11.** 10	**12.** 452.2
13. 17	**14.** 201	**15.** 29
16. $6.50	**17.** 37	**18.** $2.00
19. 41	**20.** $5.75	**21.** 3
22. 5	**23.** 471	**24.** 113