Task card 1 Easter Math

Leo orders 7 chocolate bunnies online. Shipping costs $7.50, and the total is $37.25. Write and solve an equation to find the price of one chocolate bunny.

Task card 2 Easter Math

Sam orders 5 pots of tulips online. Shipping costs $6.50, and the total is $34.00. Write and solve an equation to find the price of one pot of tulips.

Task card 3 Easter Math

A cylinder-shaped tin of hot cross buns has a radius of 2 inches and a height of 6 inches. What is its volume in cubic inches?

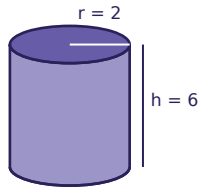

Task card 4 Easter Math

Ella has $30 saved for the Easter brunch and adds $3 every week. How many dollars will Ella have after 9 weeks?

Task card 5 Easter Math

Ella runs a 25-foot string of lights straight across a rectangular banner for the Easter brunch, from one corner to the opposite corner. The banner is 24 feet long. How tall is the banner?

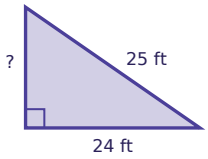

Task card 6 Easter Math

A cylinder-shaped tin of bunny cookies has a radius of 4 inches and a height of 8 inches. What is its volume in cubic inches?

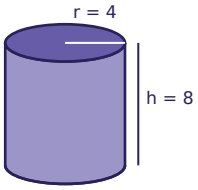

Task card 7 Easter Math

Mia has $30 saved for the Easter brunch and adds $4 every week. After how many weeks will Mia have $58?

Task card 8 Easter Math

A rectangular banner for the Easter brunch is 15 feet long and 8 feet tall. Ben runs a string of lights straight across it, from one corner to the opposite corner. How many feet long is the string of lights?

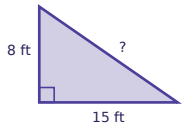

Task card 9 Easter Math

Zoe orders 7 bags of jelly beans online. Shipping costs $2.50, and the total is $16.50. Write and solve an equation to find the price of one bag of jelly beans.

Task card 10 Easter Math

A cylinder-shaped tin of carrot muffins has a radius of 6 inches and a height of 6 inches. What is its volume in cubic inches?

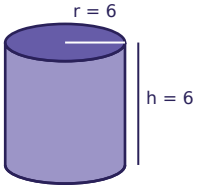

Task card 11 Easter Math

Noah orders 5 bags of jelly beans online. Shipping costs $2.00, and the total is $22.00. Write and solve an equation to find the price of one bag of jelly beans.

Task card 12 Easter Math

Leo has $25 saved for the Easter brunch and adds $3 every week. How many dollars will Leo have after 6 weeks?

Task card 13 Easter Math

A rectangular banner for the Easter brunch is 24 feet long and 7 feet tall. Omar runs a string of lights straight across it, from one corner to the opposite corner. How many feet long is the string of lights?

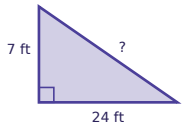

Task card 14 Easter Math

A cylinder-shaped tin of hot cross buns has a radius of 3 inches and a height of 11 inches. What is its volume in cubic inches?

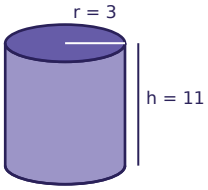

Task card 15 Easter Math

Ella has $15 saved for the Easter brunch and adds $10 every week. After how many weeks will Ella have $55?

Task card 16 Easter Math

A rectangular banner for the Easter brunch is 12 feet long and 9 feet tall. Ben runs a string of lights straight across it, from one corner to the opposite corner. How many feet long is the string of lights?

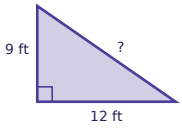

Task card 17 Easter Math

A cylinder-shaped tin of carrot muffins has a radius of 2 inches and a height of 8 inches. What is its volume in cubic inches?

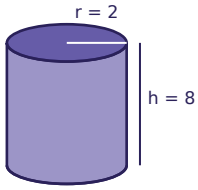

Task card 18 Easter Math

Ella orders 7 pots of tulips online. Shipping costs $4.50, and the total is $55.25. Write and solve an equation to find the price of one pot of tulips.

Task card 19 Easter Math

Omar runs a 25-foot string of lights straight across a rectangular banner for the Easter brunch, from one corner to the opposite corner. The banner is 24 feet long. How tall is the banner?

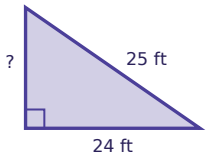

Task card 20 Easter Math

Lily has $5 saved for the Easter brunch and adds $5 every week. How many dollars will Lily have after 10 weeks?

Task card 21 Easter Math

A cylinder-shaped tin of hot cross buns has a radius of 2 inches and a height of 10 inches. What is its volume in cubic inches?

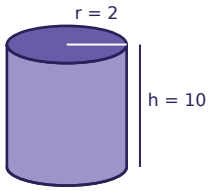

Task card 22 Easter Math

Ava orders 4 pots of tulips online. Shipping costs $6.50, and the total is $44.50. Write and solve an equation to find the price of one pot of tulips.

Task card 23 Easter Math

Zoe has $10 saved for the Easter brunch and adds $5 every week. How many dollars will Zoe have after 8 weeks?

Task card 24 Easter Math

Zoe runs a 17-foot string of lights straight across a rectangular banner for the Easter brunch, from one corner to the opposite corner. The banner is 15 feet long. How tall is the banner?

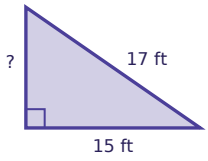

Easter Math Task Cards

Recording sheet · Grade 8 · Read each story and solve. Write money like $3.75. Use 3.14 for π and round to the nearest tenth.

Name: _____ Date: _____

Scan to check your answers

1	2	3	4
5	6	7	8
9	10	11	12
13	14	15	16
17	18	19	20
21	22	23	24

Easter Math Task Cards: Answer Key

Grade 8 · Hard

The answers online

1. $4.25	**2.** $5.50	**3.** 75.4
4. 57	**5.** 7	**6.** 401.9
7. 7	**8.** 17	**9.** $2.00
10. 678.2	**11.** $4.00	**12.** 43
13. 25	**14.** 310.9	**15.** 4
16. 15	**17.** 100.5	**18.** $7.25
19. 7	**20.** 55	**21.** 125.6
22. $9.50	**23.** 50	**24.** 8