Easter Math · 1

A cylinder-shaped tin of carrot muffins has a radius of 3 inches and a height of 3 inches. What is its volume in cubic inches?

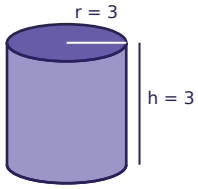

Easter Math · 2

Noah orders 4 pots of tulips online. Shipping costs $2.00, and the total is $49.00. Write and solve an equation to find the price of one pot of tulips.

Easter Math · 3

A cylinder-shaped tin of hot cross buns has a radius of 2 inches and a height of 7 inches. What is its volume in cubic inches?

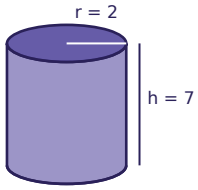

Easter Math · 4

Noah has $20 saved for the Easter brunch and adds $6 every week. How many dollars will Noah have after 8 weeks?

Easter Math · 5

A rectangular banner for the Easter brunch is 4 feet long and 3 feet tall. Sam runs a string of lights straight across it, from one corner to the opposite corner. How many feet long is the string of lights?

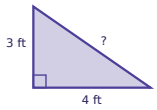

Easter Math · 6

Zoe has $15 saved for the Easter brunch and adds $8 every week. How many dollars will Zoe have after 6 weeks?

Easter Math · 7

A rectangular banner for the Easter brunch is 15 feet long and 8 feet tall. Sam runs a string of lights straight across it, from one corner to the opposite corner. How many feet long is the string of lights?

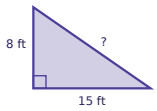

Easter Math · 8

Omar orders 2 bags of jelly beans online. Shipping costs $3.00, and the total is $7.00. Write and solve an equation to find the price of one bag of jelly beans.

Easter Math · 2

ANSWER

$11.75

Easter Math · 1

ANSWER

84.8

Easter Math · 4

ANSWER

68

Easter Math · 3

ANSWER

87.9

Easter Math · 6

ANSWER

63

Easter Math · 5

ANSWER

5

Easter Math · 8

ANSWER

$2.00

Easter Math · 7

ANSWER

17

Easter Math · 9

Ella has $25 saved for the Easter brunch and adds $2 every week. How many dollars will Ella have after 7 weeks?

Easter Math · 10

Noah orders 3 chocolate bunnies online. Shipping costs $5.50, and the total is $19.75. Write and solve an equation to find the price of one chocolate bunny.

Easter Math · 11

A rectangular banner for the Easter brunch is 8 feet long and 6 feet tall. Noah runs a string of lights straight across it, from one corner to the opposite corner. How many feet long is the string of lights?

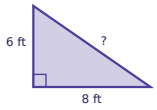

Easter Math · 12

A cylinder-shaped tin of bunny cookies has a radius of 4 inches and a height of 9 inches. What is its volume in cubic inches?

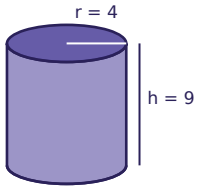

Easter Math · 13

A rectangular banner for the Easter brunch is 15 feet long and 8 feet tall. Zoe runs a string of lights straight across it, from one corner to the opposite corner. How many feet long is the string of lights?

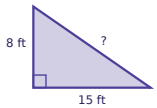

Easter Math · 14

A cylinder-shaped tin of bunny cookies has a radius of 4 inches and a height of 4 inches. What is its volume in cubic inches?

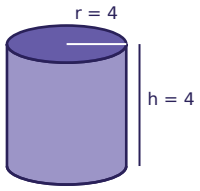

Easter Math · 15

Lily has $15 saved for the Easter brunch and adds $2 every week. How many dollars will Lily have after 7 weeks?

Easter Math · 16

Ava orders 4 pots of tulips online. Shipping costs $7.00, and the total is $33.00. Write and solve an equation to find the price of one pot of tulips.

Easter Math · 10

ANSWER

$4.75

Easter Math · 9

ANSWER

39

Easter Math · 12

ANSWER

452.2

Easter Math · 11

ANSWER

10

Easter Math · 14

ANSWER

201

Easter Math · 13

ANSWER

17

Easter Math · 16

ANSWER

$6.50

Easter Math · 15

ANSWER

29

Easter Math · 17

Sam has $25 saved for the Easter brunch and adds $4 every week. How many dollars will Sam have after 3 weeks?

Easter Math · 18

Zoe orders 5 bags of jelly beans online. Shipping costs $6.00, and the total is $16.00. Write and solve an equation to find the price of one bag of jelly beans.

Easter Math · 19

Zoe has $20 saved for the Easter brunch and adds $3 every week. How many dollars will Zoe have after 7 weeks?

Easter Math · 20

Noah orders 6 chocolate bunnies online. Shipping costs $7.50, and the total is $42.00. Write and solve an equation to find the price of one chocolate bunny.

Easter Math · 21

Mia runs a 5-foot string of lights straight across a rectangular banner for the Easter brunch, from one corner to the opposite corner. The banner is 4 feet long. How tall is the banner?

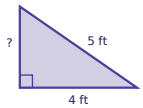

Easter Math · 22

Mia runs a 13-foot string of lights straight across a rectangular banner for the Easter brunch, from one corner to the opposite corner. The banner is 12 feet long. How tall is the banner?

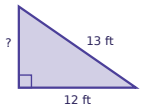

Easter Math · 23

A cylinder-shaped tin of bunny cookies has a radius of 5 inches and a height of 6 inches. What is its volume in cubic inches?

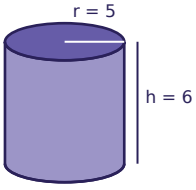

Easter Math · 24

A cylinder-shaped tin of carrot muffins has a radius of 2 inches and a height of 9 inches. What is its volume in cubic inches?

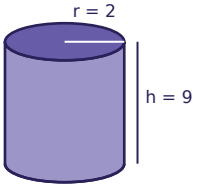

Easter Math · 18

ANSWER

$2.00

Easter Math · 17

ANSWER

37

Easter Math · 20

ANSWER

$5.75

Easter Math · 19

ANSWER

41

Easter Math · 22

ANSWER

5

Easter Math · 21

ANSWER

3

Easter Math · 24

ANSWER

113

Easter Math · 23

ANSWER

471