Easter Math · 1

Leo orders 2 chocolate bunnies online. Shipping costs $6.00, and the total is $15.50. Write and solve an equation to find the price of one chocolate bunny.

Easter Math · 2

Ben has $10 saved for the Easter brunch and adds $3 every week. How many dollars will Ben have after 6 weeks?

Easter Math · 3

Mia orders 3 bags of jelly beans online. Shipping costs $6.00, and the total is $15.00. Write and solve an equation to find the price of one bag of jelly beans.

Easter Math · 4

Omar has $5 saved for the Easter brunch and adds $2 every week. How many dollars will Omar have after 5 weeks?

Easter Math · 5

A rectangular banner for the Easter brunch is 4 feet long and 3 feet tall. Lily runs a string of lights straight across it, from one corner to the opposite corner. How many feet long is the string of lights?

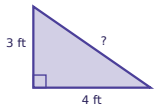


Easter Math · 6

A cylinder-shaped tin of carrot muffins has a radius of 2 inches and a height of 3 inches. What is its volume in cubic inches?

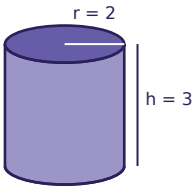


Easter Math · 7

A rectangular banner for the Easter brunch is 4 feet long and 3 feet tall. Ava runs a string of lights straight across it, from one corner to the opposite corner. How many feet long is the string of lights?

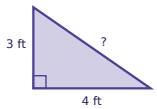


Easter Math · 8

A cylinder-shaped tin of hot cross buns has a radius of 2 inches and a height of 5 inches. What is its volume in cubic inches?

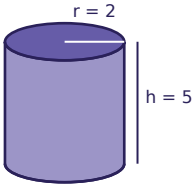

Easter Math · 2

**ANSWER**

**28**

Easter Math · 1

**ANSWER**

**$4.75**

Easter Math · 4

**ANSWER**

**15**

Easter Math · 3

**ANSWER**

**$3.00**

Easter Math · 6

**ANSWER**

**37.7**

Easter Math · 5

**ANSWER**

**5**

Easter Math · 8

**ANSWER**

**62.8**

Easter Math · 7

**ANSWER**

**5**

Easter Math · 9

A cylinder-shaped tin of hot cross buns has a radius of 2 inches and a height of 4 inches. What is its volume in cubic inches?

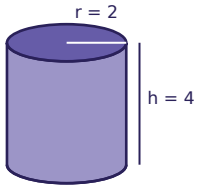


Easter Math · 10

Omar orders 2 chocolate bunnies online. Shipping costs $5.00, and the total is $19.50. Write and solve an equation to find the price of one chocolate bunny.

Easter Math · 11

A rectangular banner for the Easter brunch is 12 feet long and 5 feet tall. Lily runs a string of lights straight across it, from one corner to the opposite corner. How many feet long is the string of lights?

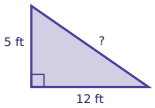


Easter Math · 12

Ava has $5 saved for the Easter brunch and adds $6 every week. How many dollars will Ava have after 3 weeks?

Easter Math · 13

A cylinder-shaped tin of bunny cookies has a radius of 2 inches and a height of 5 inches. What is its volume in cubic inches?

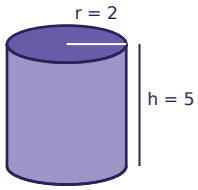


Easter Math · 14

Sam orders 5 pots of tulips online. Shipping costs $8.00, and the total is $63.00. Write and solve an equation to find the price of one pot of tulips.

Easter Math · 15

Lily has $30 saved for the Easter brunch and adds $6 every week. How many dollars will Lily have after 5 weeks?

Easter Math · 16

A rectangular banner for the Easter brunch is 12 feet long and 5 feet tall. Ava runs a string of lights straight across it, from one corner to the opposite corner. How many feet long is the string of lights?

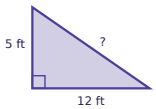

Easter Math · 10

**ANSWER**

# $7.25

Easter Math · 9

**ANSWER**

# 50.2

Easter Math · 12

**ANSWER**

# 23

Easter Math · 11

**ANSWER**

# 13

Easter Math · 14

**ANSWER**

# $11.00

Easter Math · 13

**ANSWER**

# 62.8

Easter Math · 16

**ANSWER**

# 13

Easter Math · 15

**ANSWER**

# 60

Easter Math · 17

Omar orders 4 bags of jelly beans online. Shipping costs $3.00, and the total is $14.00. Write and solve an equation to find the price of one bag of jelly beans.

Easter Math · 18

A cylinder-shaped tin of carrot muffins has a radius of 3 inches and a height of 6 inches. What is its volume in cubic inches?

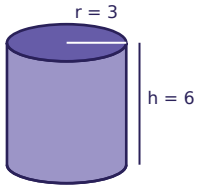


Easter Math · 19

A rectangular banner for the Easter brunch is 12 feet long and 5 feet tall. Ben runs a string of lights straight across it, from one corner to the opposite corner. How many feet long is the string of lights?

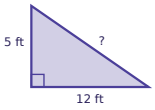


Easter Math · 20

Ben orders 5 bags of jelly beans online. Shipping costs $7.00, and the total is $29.50. Write and solve an equation to find the price of one bag of jelly beans.

Easter Math · 21

Mia has $30 saved for the Easter brunch and adds $7 every week. How many dollars will Mia have after 10 weeks?

Easter Math · 22

Omar has $20 saved for the Easter brunch and adds $2 every week. How many dollars will Omar have after 4 weeks?

Easter Math · 23

A rectangular banner for the Easter brunch is 12 feet long and 5 feet tall. Leo runs a string of lights straight across it, from one corner to the opposite corner. How many feet long is the string of lights?

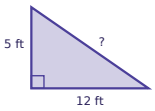


Easter Math · 24

Noah orders 2 pots of tulips online. Shipping costs $6.00, and the total is $28.50. Write and solve an equation to find the price of one pot of tulips.

Easter Math · 18

**ANSWER**

**169.6**

Easter Math · 17

**ANSWER**

**$2.75**

Easter Math · 20

**ANSWER**

**$4.50**

Easter Math · 19

**ANSWER**

**13**

Easter Math · 22

**ANSWER**

**28**

Easter Math · 21

**ANSWER**

**100**

Easter Math · 24

**ANSWER**

**$11.25**

Easter Math · 23

**ANSWER**

**13**