Task card 1 Domain and Range of Relations

Find the domain of the relation in the mapping diagram.

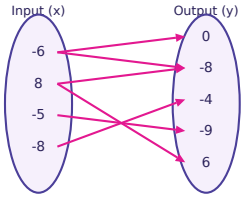

Task card 2 Domain and Range of Relations

Find the range of the relation in the mapping diagram.

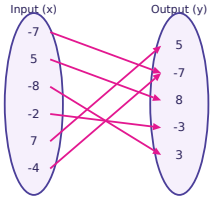

Task card 3 Domain and Range of Relations

Find the domain of the relation in the mapping diagram.

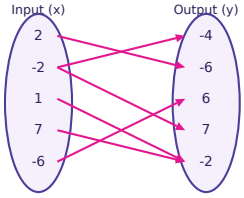

Task card 4 Domain and Range of Relations

Find the range of the relation in the mapping diagram.

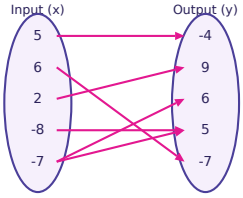

Task card 5 Domain and Range of Relations

Find the domain of the relation in the mapping diagram.

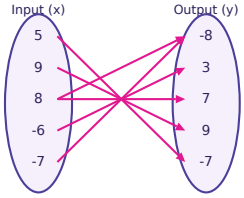

Task card 6 Domain and Range of Relations

Find the range of the relation in the mapping diagram.

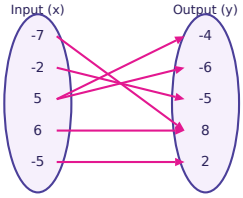

Task card 7 Domain and Range of Relations

Find the domain of the relation in the mapping diagram.

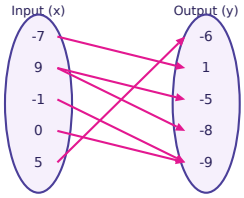

Task card 8 Domain and Range of Relations

Find the range of the relation in the mapping diagram.

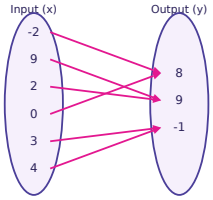

Task card 9 Domain and Range of Relations

Find the domain of the relation in the mapping diagram.

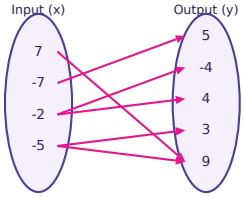

Task card 10 Domain and Range of Relations

Find the range of the relation in the mapping diagram.

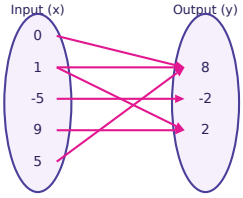

Task card 11 Domain and Range of Relations

Find the domain of the relation in the mapping diagram.

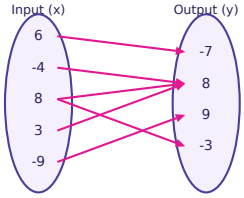

Task card 12 Domain and Range of Relations

Find the range of the relation in the mapping diagram.

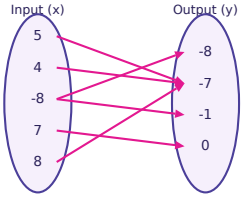

Task card 13 Domain and Range of Relations

Find the domain of the relation in the mapping diagram.

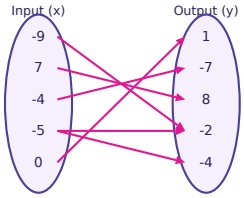

Task card 14 Domain and Range of Relations

Find the range of the relation in the mapping diagram.

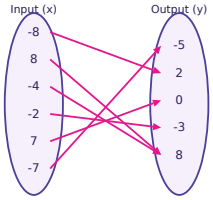

Task card 15 Domain and Range of Relations

Find the domain of the relation in the mapping diagram.

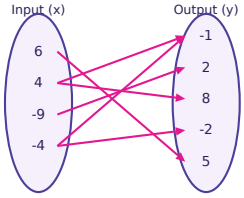

Task card 16 Domain and Range of Relations

Find the range of the relation in the mapping diagram.

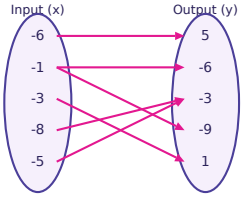

Task card 17 Domain and Range of Relations

Find the domain of the relation in the mapping diagram.

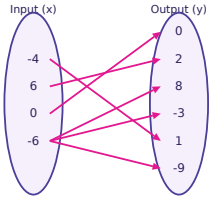

Task card 18 Domain and Range of Relations

Find the range of the relation in the mapping diagram.

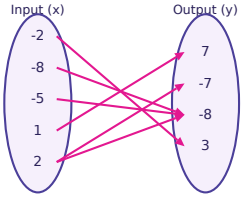

Task card 19 Domain and Range of Relations

Find the domain of the relation in the mapping diagram.

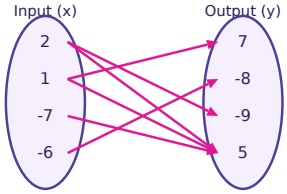

Task card 20 Domain and Range of Relations

Find the range of the relation in the mapping diagram.

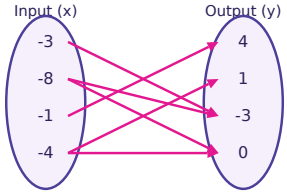

Task card 21 Domain and Range of Relations

Find the domain of the relation in the mapping diagram.

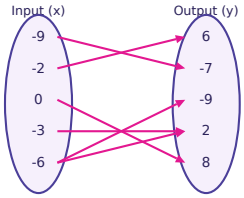

Task card 22 Domain and Range of Relations

Find the range of the relation in the mapping diagram.

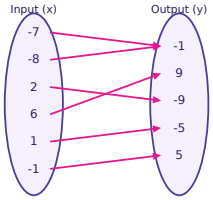

Task card 23 Domain and Range of Relations

Find the domain of the relation in the mapping diagram.

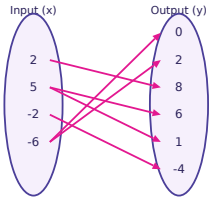

Task card 24 Domain and Range of Relations

Find the range of the relation in the mapping diagram.

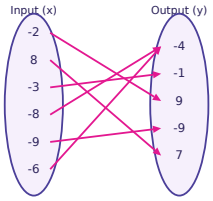

Domain and Range of Relations Task Cards

Recording sheet · Grade 8 · List each domain or range from least to greatest, separated by commas, like -3, 1, 4. Write a value that appears more than once only once.

Scan to check your answers

Name: _____ Date: _____

1	2	3	4
5	6	7	8
9	10	11	12
13	14	15	16
17	18	19	20
21	22	23	24

Domain and Range of Relations Task Cards: Answer Key

Grade 8 · Hard

The answers online

1. -8, -6, -5, 8	**2.** -7, -3, 3, 5, 8	**3.** -6, -2, 1, 2, 7
4. -7, -4, 5, 6, 9	**5.** -7, -6, 5, 8, 9	**6.** -6, -5, -4, 2, 8
7. -7, -1, 0, 5, 9	**8.** -1, 8, 9	**9.** -7, -5, -2, 7
10. -2, 2, 8	**11.** -9, -4, 3, 6, 8	**12.** -8, -7, -1, 0
13. -9, -5, -4, 0, 7	**14.** -5, -3, 0, 2, 8	**15.** -9, -4, 4, 6
16. -9, -6, -3, 1, 5	**17.** -6, -4, 0, 6	**18.** -8, -7, 3, 7
19. -7, -6, 1, 2	**20.** -3, 0, 1, 4	**21.** -9, -6, -3, -2, 0
22. -9, -5, -1, 5, 9	**23.** -6, -2, 2, 5	**24.** -9, -4, -1, 7, 9