Domain and Range of Relations · 1

Find the domain of the relation in the mapping diagram.

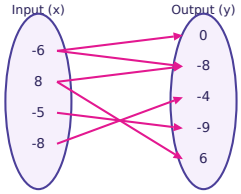

Domain and Range of Relations · 2

Find the range of the relation in the mapping diagram.

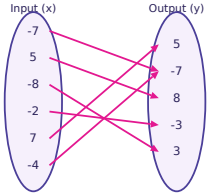

Domain and Range of Relations · 3

Find the domain of the relation in the mapping diagram.

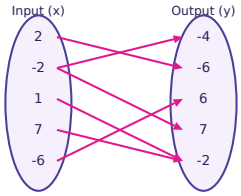

Domain and Range of Relations · 4

Find the range of the relation in the mapping diagram.

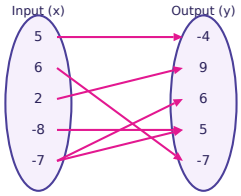

Domain and Range of Relations · 5

Find the domain of the relation in the mapping diagram.

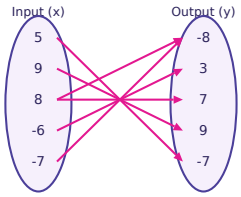

Domain and Range of Relations · 6

Find the range of the relation in the mapping diagram.

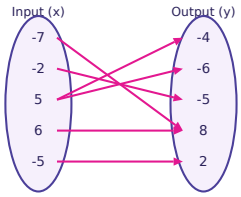

Domain and Range of Relations · 7

Find the domain of the relation in the mapping diagram.

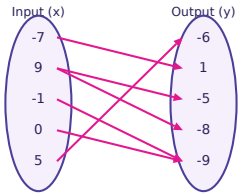

Domain and Range of Relations · 8

Find the range of the relation in the mapping diagram.

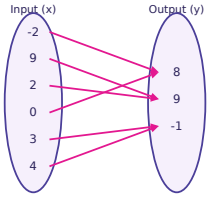

Domain and Range of Relations · 2

ANSWER

-7, -3, 3, 5, 8

Domain and Range of Relations · 1

ANSWER

-8, -6, -5, 8

Domain and Range of Relations · 4

ANSWER

-7, -4, 5, 6, 9

Domain and Range of Relations · 3

ANSWER

-6, -2, 1, 2, 7

Domain and Range of Relations · 6

ANSWER

-6, -5, -4, 2, 8

Domain and Range of Relations · 5

ANSWER

-7, -6, 5, 8, 9

Domain and Range of Relations · 8

ANSWER

-1, 8, 9

Domain and Range of Relations · 7

ANSWER

-7, -1, 0, 5, 9

Domain and Range of Relations · 9

Find the domain of the relation in the mapping diagram.

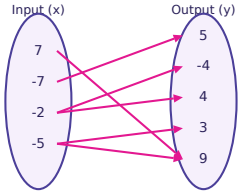

Domain and Range of Relations · 10

Find the range of the relation in the mapping diagram.

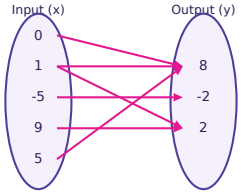

Domain and Range of Relations · 11

Find the domain of the relation in the mapping diagram.

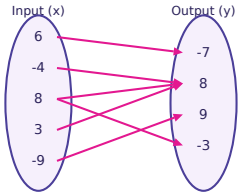

Domain and Range of Relations · 12

Find the range of the relation in the mapping diagram.

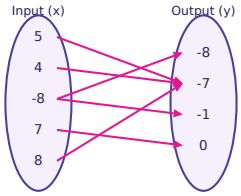

Domain and Range of Relations · 13

Find the domain of the relation in the mapping diagram.

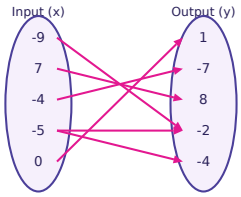

Domain and Range of Relations · 14

Find the range of the relation in the mapping diagram.

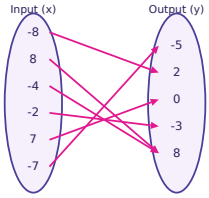

Domain and Range of Relations · 15

Find the domain of the relation in the mapping diagram.

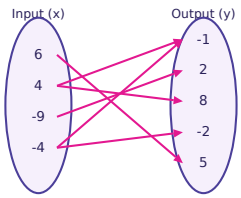

Domain and Range of Relations · 16

Find the range of the relation in the mapping diagram.

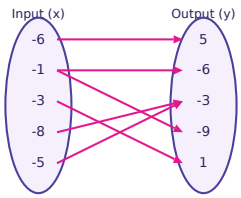

Domain and Range of Relations · 10

ANSWER

-2, 2, 8

Domain and Range of Relations · 9

ANSWER

-7, -5, -2, 7

Domain and Range of Relations · 12

ANSWER

-8, -7, -1, 0

Domain and Range of Relations · 11

ANSWER

-9, -4, 3, 6, 8

Domain and Range of Relations · 14

ANSWER

-5, -3, 0, 2, 8

Domain and Range of Relations · 13

ANSWER

-9, -5, -4, 0, 7

Domain and Range of Relations · 16

ANSWER

-9, -6, -3, 1, 5

Domain and Range of Relations · 15

ANSWER

-9, -4, 4, 6

Domain and Range of Relations · 17

Find the domain of the relation in the mapping diagram.

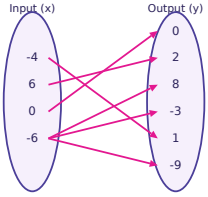

Domain and Range of Relations · 18

Find the range of the relation in the mapping diagram.

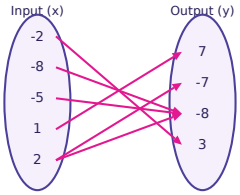

Domain and Range of Relations · 19

Find the domain of the relation in the mapping diagram.

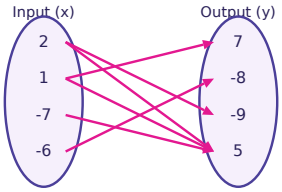

Domain and Range of Relations · 20

Find the range of the relation in the mapping diagram.

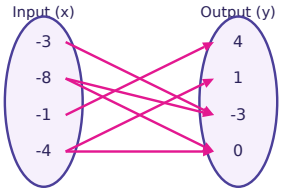

Domain and Range of Relations · 21

Find the domain of the relation in the mapping diagram.

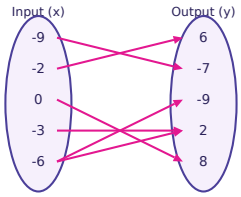

Domain and Range of Relations · 22

Find the range of the relation in the mapping diagram.

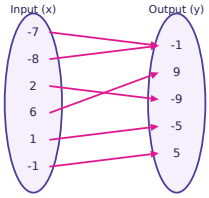

Domain and Range of Relations · 23

Find the domain of the relation in the mapping diagram.

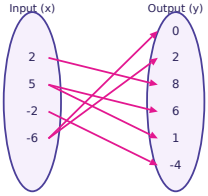

Domain and Range of Relations · 24

Find the range of the relation in the mapping diagram.

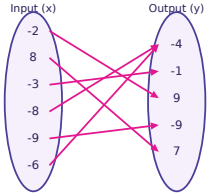

Domain and Range of Relations · 18

ANSWER

-8, -7, 3, 7

Domain and Range of Relations · 17

ANSWER

-6, -4, 0, 6

Domain and Range of Relations · 20

ANSWER

-3, 0, 1, 4

Domain and Range of Relations · 19

ANSWER

-7, -6, 1, 2

Domain and Range of Relations · 22

ANSWER

-9, -5, -1, 5, 9

Domain and Range of Relations · 21

ANSWER

-9, -6, -3, -2, 0

Domain and Range of Relations · 24

ANSWER

-9, -4, -1, 7, 9

Domain and Range of Relations · 23

ANSWER

-6, -2, 2, 5