Distance on the Coordinate Plane · 1

Find the distance between A(-4, -6) and B(20, -13).

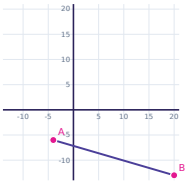

Distance on the Coordinate Plane · 2

Find the distance between A(7, 8) and B(31, 15).

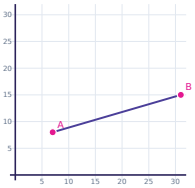

Distance on the Coordinate Plane · 3

Find the distance between A(7, 8) and B(19, -1).

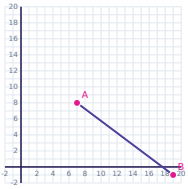

Distance on the Coordinate Plane · 4

Find the distance between A(-10, -9) and B(-6, -12).

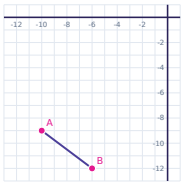

Distance on the Coordinate Plane · 5

Find the distance between A(-1, -7) and B(-10, -19).

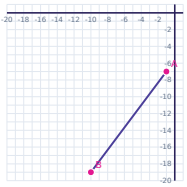

Distance on the Coordinate Plane · 6

Find the distance between A(-5, -8) and B(-17, -3).

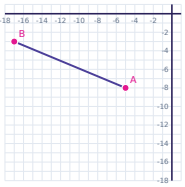

Distance on the Coordinate Plane · 7

Find the distance between A(0, 9) and B(9, 21).

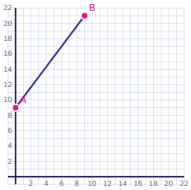

Distance on the Coordinate Plane · 8

Find the distance between A(-6, 9) and B(-3, 13).

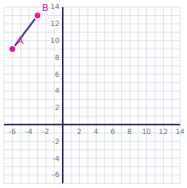

Distance on the Coordinate Plane · 2

ANSWER

25

Distance on the Coordinate Plane · 1

ANSWER

25

Distance on the Coordinate Plane · 4

ANSWER

5

Distance on the Coordinate Plane · 3

ANSWER

15

Distance on the Coordinate Plane · 6

ANSWER

13

Distance on the Coordinate Plane · 5

ANSWER

15

Distance on the Coordinate Plane · 8

ANSWER

5

Distance on the Coordinate Plane · 7

ANSWER

15

Distance on the Coordinate Plane · 9

Find the distance between A(2, -9) and B(6, -12).

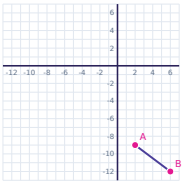

Distance on the Coordinate Plane · 10

Find the distance between A(6, -6) and B(-2, 0).

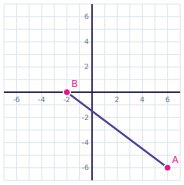

Distance on the Coordinate Plane · 11

Find the distance between A(7, 1) and B(10, -3).

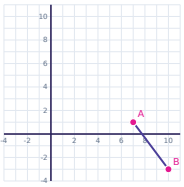

Distance on the Coordinate Plane · 12

Find the distance between A(-4, -1) and B(-16, 15).

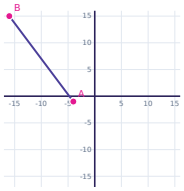

Distance on the Coordinate Plane · 13

Find the distance between A(1, 3) and B(-15, -9).

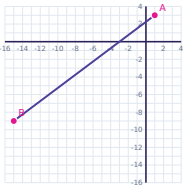

Distance on the Coordinate Plane · 14

Find the distance between A(9, -8) and B(3, -16).

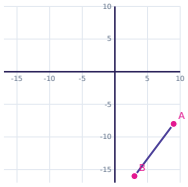

Distance on the Coordinate Plane · 15

Find the distance between A(-1, -4) and B(23, -11).

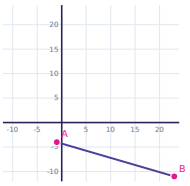

Distance on the Coordinate Plane · 16

Find the distance between A(0, -4) and B(6, -12).

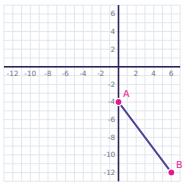

Distance on the Coordinate Plane · 10

ANSWER

10

Distance on the Coordinate Plane · 9

ANSWER

5

Distance on the Coordinate Plane · 12

ANSWER

20

Distance on the Coordinate Plane · 11

ANSWER

5

Distance on the Coordinate Plane · 14

ANSWER

10

Distance on the Coordinate Plane · 13

ANSWER

20

Distance on the Coordinate Plane · 16

ANSWER

10

Distance on the Coordinate Plane · 15

ANSWER

25

Distance on the Coordinate Plane · 17

Find the distance between A(-5, -3) and B(2, -27).

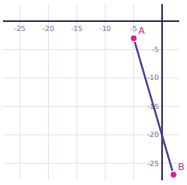

Distance on the Coordinate Plane · 18

Find the distance between A(2, -5) and B(10, -20).

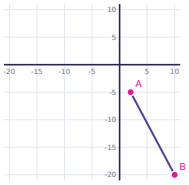

Distance on the Coordinate Plane · 19

Find the distance between A(10, -9) and B(31, -29).

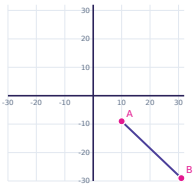

Distance on the Coordinate Plane · 20

Find the distance between A(3, 2) and B(7, -1).

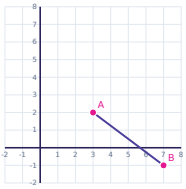

Distance on the Coordinate Plane · 21

Find the distance between A(4, -9) and B(20, 3).

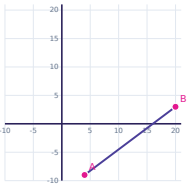

Distance on the Coordinate Plane · 22

Find the distance between A(10, 1) and B(22, -4).

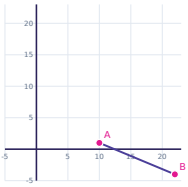

Distance on the Coordinate Plane · 23

Find the distance between A(5, 9) and B(25, 30).

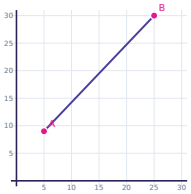

Distance on the Coordinate Plane · 24

Find the distance between A(10, 7) and B(-10, -14).

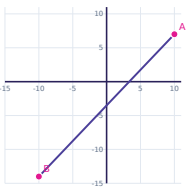

Distance on the Coordinate Plane · 18

ANSWER

17

Distance on the Coordinate Plane · 17

ANSWER

25

Distance on the Coordinate Plane · 20

ANSWER

5

Distance on the Coordinate Plane · 19

ANSWER

29

Distance on the Coordinate Plane · 22

ANSWER

13

Distance on the Coordinate Plane · 21

ANSWER

20

Distance on the Coordinate Plane · 24

ANSWER

29

Distance on the Coordinate Plane · 23

ANSWER

29