Distance on the Coordinate Plane · 1

Find the distance between A(-6, -4) and B(-18, 5).

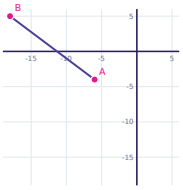

Distance on the Coordinate Plane · 2

Find the distance between A(-5, 7) and B(-17, 16).

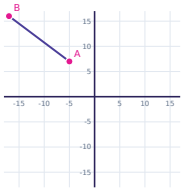

Distance on the Coordinate Plane · 3

Find the distance between A(3, 7) and B(-9, 16).

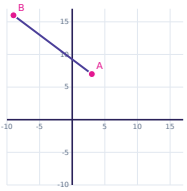

Distance on the Coordinate Plane · 4

Find the distance between A(-6, -5) and B(-22, -17).

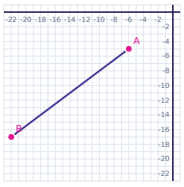

Distance on the Coordinate Plane · 5

Find the distance between A(-4, 4) and B(8, 20).

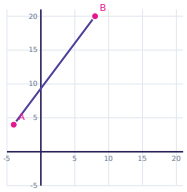

Distance on the Coordinate Plane · 6

Find the distance between A(-3, -10) and B(-11, -25).

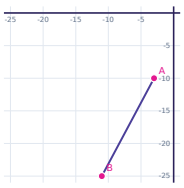

Distance on the Coordinate Plane · 7

Find the distance between A(4, -5) and B(16, 0).

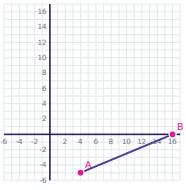

Distance on the Coordinate Plane · 8

Find the distance between A(-10, 1) and B(-26, 13).

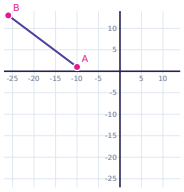

Distance on the Coordinate Plane · 2

ANSWER

15

Distance on the Coordinate Plane · 1

ANSWER

15

Distance on the Coordinate Plane · 4

ANSWER

20

Distance on the Coordinate Plane · 3

ANSWER

15

Distance on the Coordinate Plane · 6

ANSWER

17

Distance on the Coordinate Plane · 5

ANSWER

20

Distance on the Coordinate Plane · 8

ANSWER

20

Distance on the Coordinate Plane · 7

ANSWER

13

Distance on the Coordinate Plane · 9

Find the distance between A(5, 2) and B(-10, 10).

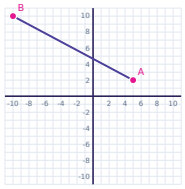

Distance on the Coordinate Plane · 10

Find the distance between A(-3, -7) and B(21, 0).

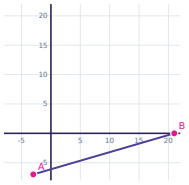

Distance on the Coordinate Plane · 11

Find the distance between A(-5, 7) and B(2, 31).



Distance on the Coordinate Plane · 12

Find the distance between A(8, 7) and B(-1, 19).

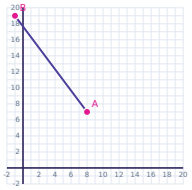

Distance on the Coordinate Plane · 13

Find the distance between A(-2, 6) and B(22, 13).

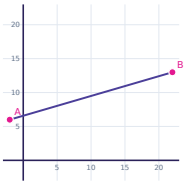

Distance on the Coordinate Plane · 14

Find the distance between A(3, -5) and B(-6, -17).

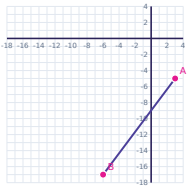

Distance on the Coordinate Plane · 15

Find the distance between A(10, -7) and B(7, -3).

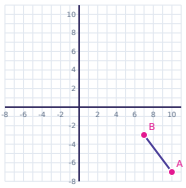

Distance on the Coordinate Plane · 16

Find the distance between A(-3, 6) and B(3, -2).

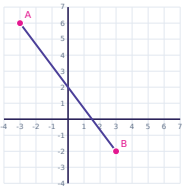

Distance on the Coordinate Plane · 10

ANSWER

25

Distance on the Coordinate Plane · 9

ANSWER

17

Distance on the Coordinate Plane · 12

ANSWER

15

Distance on the Coordinate Plane · 11

ANSWER

25

Distance on the Coordinate Plane · 14

ANSWER

15

Distance on the Coordinate Plane · 13

ANSWER

25

Distance on the Coordinate Plane · 16

ANSWER

10

Distance on the Coordinate Plane · 15

ANSWER

5

Distance on the Coordinate Plane · 17

Find the distance between A(10, -9) and B(-6, -21).

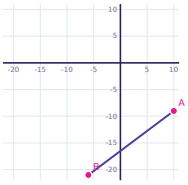

Distance on the Coordinate Plane · 18

Find the distance between A(-8, 1) and B(4, 10).

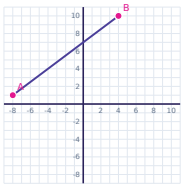

Distance on the Coordinate Plane · 19

Find the distance between A(-7, 2) and B(2, 14).

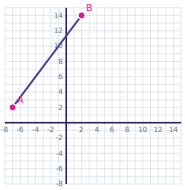

Distance on the Coordinate Plane · 20

Find the distance between A(3, -8) and B(18, 0).

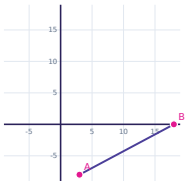

Distance on the Coordinate Plane · 21

Find the distance between A(6, 9) and B(14, 3).

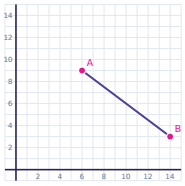

Distance on the Coordinate Plane · 22

Find the distance between A(3, 1) and B(9, 9).

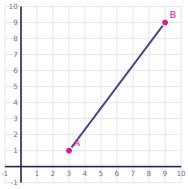

Distance on the Coordinate Plane · 23

Find the distance between A(1, 4) and B(21, -17).

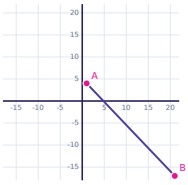

Distance on the Coordinate Plane · 24

Find the distance between A(5, -1) and B(-10, -9).

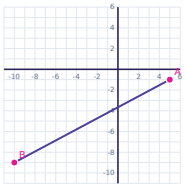

Distance on the Coordinate Plane · 18

ANSWER

15

Distance on the Coordinate Plane · 17

ANSWER

20

Distance on the Coordinate Plane · 20

ANSWER

17

Distance on the Coordinate Plane · 19

ANSWER

15

Distance on the Coordinate Plane · 22

ANSWER

10

Distance on the Coordinate Plane · 21

ANSWER

10

Distance on the Coordinate Plane · 24

ANSWER

17

Distance on the Coordinate Plane · 23

ANSWER

29