Distance on the Coordinate Plane · 1

Find the distance between A(-5, 0) and B(-1, -3).

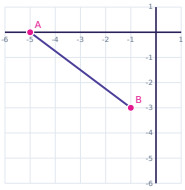

Distance on the Coordinate Plane · 2

Find the distance between A(-9, -1) and B(-12, -5).

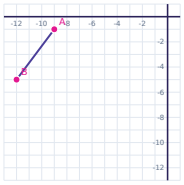

Distance on the Coordinate Plane · 3

Find the distance between A(0, -6) and B(5, 6).

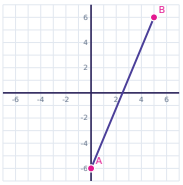

Distance on the Coordinate Plane · 4

Find the distance between A(9, -10) and B(14, -22).

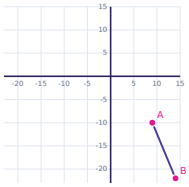

Distance on the Coordinate Plane · 5

Find the distance between A(-3, -8) and B(1, -11).

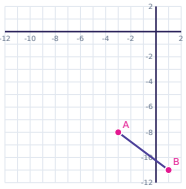

Distance on the Coordinate Plane · 6

Find the distance between A(0, -1) and B(-8, 5).

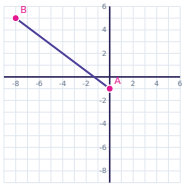

Distance on the Coordinate Plane · 7

Find the distance between A(-5, -9) and B(7, -14).

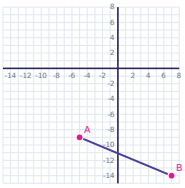

Distance on the Coordinate Plane · 8

Find the distance between A(5, 0) and B(10, -12).

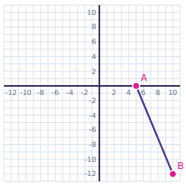

Distance on the Coordinate Plane · 2

ANSWER

5

Distance on the Coordinate Plane · 1

ANSWER

5

Distance on the Coordinate Plane · 4

ANSWER

13

Distance on the Coordinate Plane · 3

ANSWER

13

Distance on the Coordinate Plane · 6

ANSWER

10

Distance on the Coordinate Plane · 5

ANSWER

5

Distance on the Coordinate Plane · 8

ANSWER

13

Distance on the Coordinate Plane · 7

ANSWER

13

Distance on the Coordinate Plane · 9

Find the distance between A(-9, 6) and B(-12, 10).

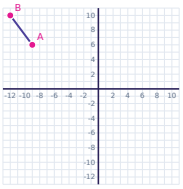

Distance on the Coordinate Plane · 10

Find the distance between A(7, -3) and B(16, -15).

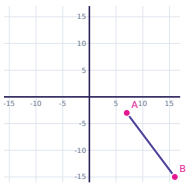

Distance on the Coordinate Plane · 11

Find the distance between A(0, 10) and B(-12, 19).

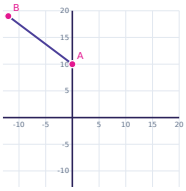

Distance on the Coordinate Plane · 12

Find the distance between A(-8, 8) and B(-11, 12).

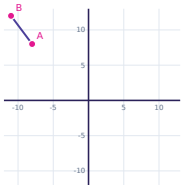

Distance on the Coordinate Plane · 13

Find the distance between A(-6, -7) and B(-2, -4).

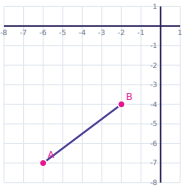

Distance on the Coordinate Plane · 14

Find the distance between A(7, -5) and B(-2, -17).

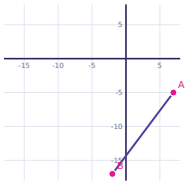

Distance on the Coordinate Plane · 15

Find the distance between A(0, -2) and B(-12, 7).

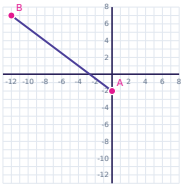

Distance on the Coordinate Plane · 16

Find the distance between A(8, -5) and B(20, 0).

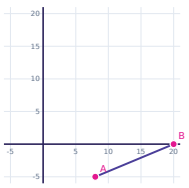

Distance on the Coordinate Plane · 10

ANSWER

15

Distance on the Coordinate Plane · 9

ANSWER

5

Distance on the Coordinate Plane · 12

ANSWER

5

Distance on the Coordinate Plane · 11

ANSWER

15

Distance on the Coordinate Plane · 14

ANSWER

15

Distance on the Coordinate Plane · 13

ANSWER

5

Distance on the Coordinate Plane · 16

ANSWER

13

Distance on the Coordinate Plane · 15

ANSWER

15

Distance on the Coordinate Plane · 17

Find the distance between A(6, 9) and B(12, 1).

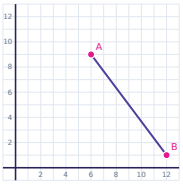

Distance on the Coordinate Plane · 18

Find the distance between A(10, 7) and B(4, -1).

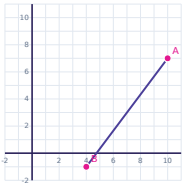

Distance on the Coordinate Plane · 19

Find the distance between A(-9, -2) and B(-4, -14).

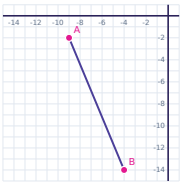

Distance on the Coordinate Plane · 20

Find the distance between A(-4, 1) and B(0, 4).

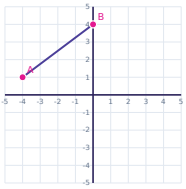

Distance on the Coordinate Plane · 21

Find the distance between A(4, 9) and B(-4, -6).

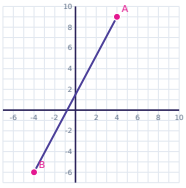

Distance on the Coordinate Plane · 22

Find the distance between A(-4, 2) and B(4, -4).

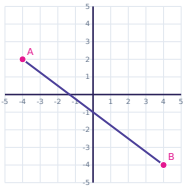

Distance on the Coordinate Plane · 23

Find the distance between A(-4, -2) and B(11, 6).

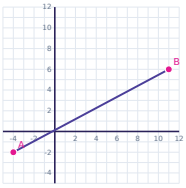

Distance on the Coordinate Plane · 24

Find the distance between A(6, 5) and B(-2, -10).

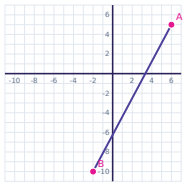

Distance on the Coordinate Plane · 18

ANSWER

10

Distance on the Coordinate Plane · 17

ANSWER

10

Distance on the Coordinate Plane · 20

ANSWER

5

Distance on the Coordinate Plane · 19

ANSWER

13

Distance on the Coordinate Plane · 22

ANSWER

10

Distance on the Coordinate Plane · 21

ANSWER

17

Distance on the Coordinate Plane · 24

ANSWER

17

Distance on the Coordinate Plane · 23

ANSWER

17