Back to School Math · 1

Lily has $5 saved for the back-to-school picnic and adds $4 every week. How many dollars will Lily have after 5 weeks?

Back to School Math · 2

A cylinder-shaped tin of granola bars has a radius of 2 inches and a height of 6 inches. What is its volume in cubic inches?

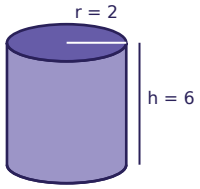

Back to School Math · 3

A cylinder-shaped tin of granola bars has a radius of 3 inches and a height of 4 inches. What is its volume in cubic inches?

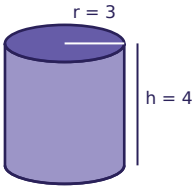

Back to School Math · 4

Ava has $15 saved for the back-to-school picnic and adds $8 every week. How many dollars will Ava have after 10 weeks?

Back to School Math · 5

Sam orders 2 notebooks online. Shipping costs $3.00, and the total is $5.50. Write and solve an equation to find the price of one notebook.

Back to School Math · 6

Mia orders 6 backpacks online. Shipping costs $8.00, and the total is $87.50. Write and solve an equation to find the price of one backpack.

Back to School Math · 7

Lily runs a 10-foot string of lights straight across a rectangular banner for the back-to-school picnic, from one corner to the opposite corner. The banner is 8 feet long. How tall is the banner?

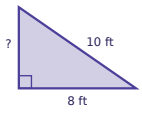

Back to School Math · 8

Ava has $10 saved for the back-to-school picnic and adds $8 every week. After how many weeks will Ava have $50?

Back to School Math · 2

ANSWER

75.4

Back to School Math · 1

ANSWER

25

Back to School Math · 4

ANSWER

95

Back to School Math · 3

ANSWER

113

Back to School Math · 6

ANSWER

$13.25

Back to School Math · 5

ANSWER

$1.25

Back to School Math · 8

ANSWER

5

Back to School Math · 7

ANSWER

6

Back to School Math · 9

Zoe orders 8 boxes of crayons online. Shipping costs $7.00, and the total is $29.00. Write and solve an equation to find the price of one box of crayons.

Back to School Math · 10

A cylinder-shaped tin of oatmeal cookies has a radius of 2 inches and a height of 6 inches. What is its volume in cubic inches?

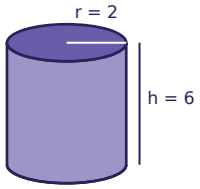

Back to School Math · 11

Ben orders 2 boxes of crayons online. Shipping costs $5.00, and the total is $10.50. Write and solve an equation to find the price of one box of crayons.

Back to School Math · 12

Leo has $20 saved for the back-to-school picnic and adds $6 every week. After how many weeks will Leo have $50?

Back to School Math · 13

A cylinder-shaped tin of oatmeal cookies has a radius of 3 inches and a height of 7 inches. What is its volume in cubic inches?

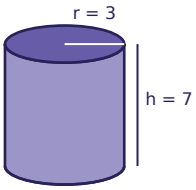

Back to School Math · 14

A cylinder-shaped tin of granola bars has a radius of 3 inches and a height of 8 inches. What is its volume in cubic inches?

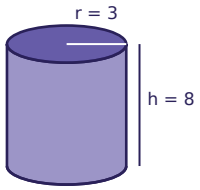

Back to School Math · 15

Omar has $15 saved for the back-to-school picnic and adds $2 every week. How many dollars will Omar have after 3 weeks?

Back to School Math · 16

Ella orders 2 backpacks online. Shipping costs $3.00, and the total is $33.00. Write and solve an equation to find the price of one backpack.

Back to School Math · 10

ANSWER

75.4

Back to School Math · 9

ANSWER

$2.75

Back to School Math · 12

ANSWER

5

Back to School Math · 11

ANSWER

$2.75

Back to School Math · 14

ANSWER

226.1

Back to School Math · 13

ANSWER

197.8

Back to School Math · 16

ANSWER

$15.00

Back to School Math · 15

ANSWER

21

Back to School Math · 17

Ella runs a 20-foot string of lights straight across a rectangular banner for the back-to-school picnic, from one corner to the opposite corner. The banner is 16 feet long. How tall is the banner?

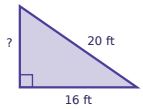

Back to School Math · 18

Sam runs a 25-foot string of lights straight across a rectangular banner for the back-to-school picnic, from one corner to the opposite corner. The banner is 24 feet long. How tall is the banner?

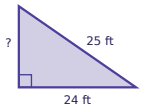

Back to School Math · 19

Sam has $20 saved for the back-to-school picnic and adds $6 every week. How many dollars will Sam have after 8 weeks?

Back to School Math · 20

Leo orders 2 boxes of crayons online. Shipping costs $4.50, and the total is $14.50. Write and solve an equation to find the price of one box of crayons.

Back to School Math · 21

A cylinder-shaped tin of granola bars has a radius of 5 inches and a height of 10 inches. What is its volume in cubic inches?

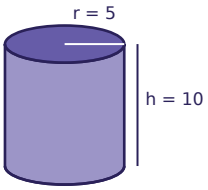

Back to School Math · 22

Leo has $30 saved for the back-to-school picnic and adds $8 every week. How many dollars will Leo have after 3 weeks?

Back to School Math · 23

Ella orders 2 backpacks online. Shipping costs $7.00, and the total is $35.50. Write and solve an equation to find the price of one backpack.

Back to School Math · 24

Lily has $5 saved for the back-to-school picnic and adds $2 every week. How many dollars will Lily have after 5 weeks?

Back to School Math · 18

ANSWER

7

Back to School Math · 17

ANSWER

12

Back to School Math · 20

ANSWER

$5.00

Back to School Math · 19

ANSWER

68

Back to School Math · 22

ANSWER

54

Back to School Math · 21

ANSWER

785

Back to School Math · 24

ANSWER

15

Back to School Math · 23

ANSWER

$14.25