Back to School Math · 1

Ava has $15 saved for the back-to-school picnic and adds $3 every week. How many dollars will Ava have after 8 weeks?

Back to School Math · 2

A cylinder-shaped tin of muffins has a radius of 2 inches and a height of 5 inches. What is its volume in cubic inches?

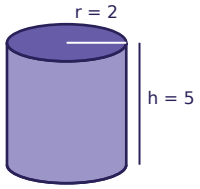

Back to School Math · 3

Zoe has $30 saved for the back-to-school picnic and adds $2 every week. How many dollars will Zoe have after 8 weeks?

Back to School Math · 4

Noah orders 2 backpacks online. Shipping costs $3.00, and the total is $32.50. Write and solve an equation to find the price of one backpack.

Back to School Math · 5

A cylinder-shaped tin of granola bars has a radius of 2 inches and a height of 3 inches. What is its volume in cubic inches?

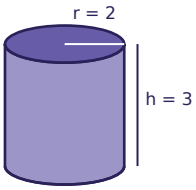

Back to School Math · 6

Sam orders 2 backpacks online. Shipping costs $3.00, and the total is $39.50. Write and solve an equation to find the price of one backpack.

Back to School Math · 7

A cylinder-shaped tin of granola bars has a radius of 3 inches and a height of 5 inches. What is its volume in cubic inches?

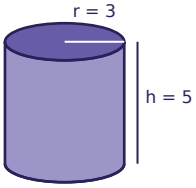

Back to School Math · 8

A cylinder-shaped tin of oatmeal cookies has a radius of 3 inches and a height of 5 inches. What is its volume in cubic inches?

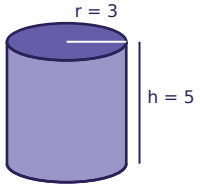

Back to School Math · 2

ANSWER

62.8

Back to School Math · 1

ANSWER

39

Back to School Math · 4

ANSWER

$14.75

Back to School Math · 3

ANSWER

46

Back to School Math · 6

ANSWER

$18.25

Back to School Math · 5

ANSWER

37.7

Back to School Math · 8

ANSWER

141.3

Back to School Math · 7

ANSWER

141.3

Back to School Math · 9

Ella orders 3 backpacks online. Shipping costs $3.00, and the total is $42.00. Write and solve an equation to find the price of one backpack.

Back to School Math · 10

Leo has $10 saved for the back-to-school picnic and adds $2 every week. How many dollars will Leo have after 4 weeks?

Back to School Math · 11

Leo orders 4 backpacks online. Shipping costs $3.00, and the total is $76.00. Write and solve an equation to find the price of one backpack.

Back to School Math · 12

Ava has $10 saved for the back-to-school picnic and adds $2 every week. How many dollars will Ava have after 5 weeks?

Back to School Math · 13

A cylinder-shaped tin of muffins has a radius of 2 inches and a height of 3 inches. What is its volume in cubic inches?

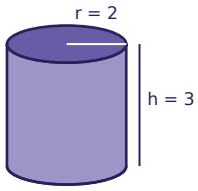

Back to School Math · 14

Zoe has $25 saved for the back-to-school picnic and adds $2 every week. How many dollars will Zoe have after 9 weeks?

Back to School Math · 15

A cylinder-shaped tin of muffins has a radius of 3 inches and a height of 5 inches. What is its volume in cubic inches?

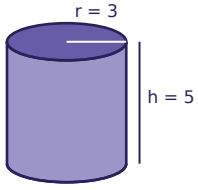

Back to School Math · 16

Noah has $5 saved for the back-to-school picnic and adds $6 every week. How many dollars will Noah have after 7 weeks?

Back to School Math · 10

ANSWER

18

Back to School Math · 9

ANSWER

$13.00

Back to School Math · 12

ANSWER

20

Back to School Math · 11

ANSWER

$18.25

Back to School Math · 14

ANSWER

43

Back to School Math · 13

ANSWER

37.7

Back to School Math · 16

ANSWER

47

Back to School Math · 15

ANSWER

141.3

Back to School Math · 17

Ben orders 5 notebooks online. Shipping costs $5.00, and the total is $17.50. Write and solve an equation to find the price of one notebook.

Back to School Math · 18

Noah orders 5 notebooks online. Shipping costs $7.00, and the total is $13.25. Write and solve an equation to find the price of one notebook.

Back to School Math · 19

Ava has $15 saved for the back-to-school picnic and adds $2 every week. How many dollars will Ava have after 5 weeks?

Back to School Math · 20

Ava has $30 saved for the back-to-school picnic and adds $3 every week. How many dollars will Ava have after 7 weeks?

Back to School Math · 21

Noah orders 2 backpacks online. Shipping costs $4.00, and the total is $30.00. Write and solve an equation to find the price of one backpack.

Back to School Math · 22

Ella orders 2 notebooks online. Shipping costs $3.00, and the total is $7.50. Write and solve an equation to find the price of one notebook.

Back to School Math · 23

A cylinder-shaped tin of oatmeal cookies has a radius of 2 inches and a height of 3 inches. What is its volume in cubic inches?

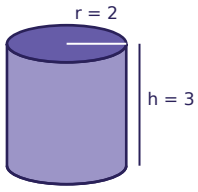

Back to School Math · 24

A cylinder-shaped tin of muffins has a radius of 3 inches and a height of 6 inches. What is its volume in cubic inches?

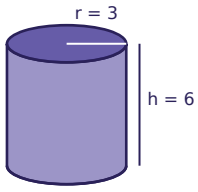

Back to School Math · 18

ANSWER

$1.25

Back to School Math · 17

ANSWER

$2.50

Back to School Math · 20

ANSWER

51

Back to School Math · 19

ANSWER

25

Back to School Math · 22

ANSWER

$2.25

Back to School Math · 21

ANSWER

$13.00

Back to School Math · 24

ANSWER

169.6

Back to School Math · 23

ANSWER

37.7