100th Day of School Math · 1

Leo has $25 saved for the 100th Day party and adds $3 every week. How many dollars will Leo have after 7 weeks?

100th Day of School Math · 2

A rectangular banner for the 100th Day party is 12 feet long and 5 feet tall. Ava runs a string of lights straight across it, from one corner to the opposite corner. How many feet long is the string of lights?

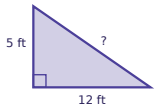

100th Day of School Math · 3

Ella orders 6 boxes of crayons online. Shipping costs $3.00, and the total is $18.00. Write and solve an equation to find the price of one box of crayons.

100th Day of School Math · 4

Mia has $25 saved for the 100th Day party and adds $6 every week. How many dollars will Mia have after 8 weeks?

100th Day of School Math · 5

A rectangular banner for the 100th Day party is 4 feet long and 3 feet tall. Sam runs a string of lights straight across it, from one corner to the opposite corner. How many feet long is the string of lights?

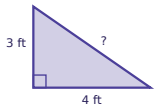

100th Day of School Math · 6

A cylinder-shaped tin of pretzels has a radius of 2 inches and a height of 8 inches. What is its volume in cubic inches?

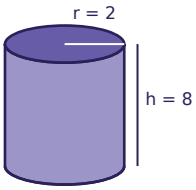

100th Day of School Math · 7

A cylinder-shaped tin of pretzels has a radius of 3 inches and a height of 4 inches. What is its volume in cubic inches?

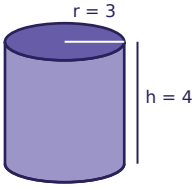

100th Day of School Math · 8

Omar orders 5 party hats online. Shipping costs $2.00, and the total is $15.75. Write and solve an equation to find the price of one party hat.

100th Day of School Math · 2

ANSWER

13

100th Day of School Math · 1

ANSWER

46

100th Day of School Math · 4

ANSWER

73

100th Day of School Math · 3

ANSWER

$2.50

100th Day of School Math · 6

ANSWER

100.5

100th Day of School Math · 5

ANSWER

5

100th Day of School Math · 8

ANSWER

$2.75

100th Day of School Math · 7

ANSWER

113

100th Day of School Math · 9

Mia orders 4 boxes of crayons online. Shipping costs $3.50, and the total is $12.50. Write and solve an equation to find the price of one box of crayons.

100th Day of School Math · 10

Mia orders 5 boxes of crayons online. Shipping costs $2.50, and the total is $15.00. Write and solve an equation to find the price of one box of crayons.

100th Day of School Math · 11

Omar has $15 saved for the 100th Day party and adds $7 every week. How many dollars will Omar have after 5 weeks?

100th Day of School Math · 12

A cylinder-shaped tin of pretzels has a radius of 4 inches and a height of 8 inches. What is its volume in cubic inches?

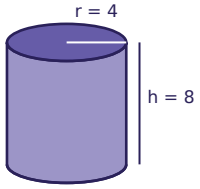

100th Day of School Math · 13

Mia has $20 saved for the 100th Day party and adds $7 every week. How many dollars will Mia have after 9 weeks?

100th Day of School Math · 14

Ben runs a 13-foot string of lights straight across a rectangular banner for the 100th Day party, from one corner to the opposite corner. The banner is 12 feet long. How tall is the banner?

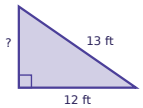

100th Day of School Math · 15

A cylinder-shaped tin of cupcakes has a radius of 3 inches and a height of 4 inches. What is its volume in cubic inches?

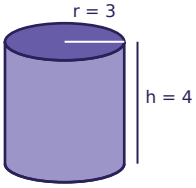

100th Day of School Math · 16

Ella runs a 15-foot string of lights straight across a rectangular banner for the 100th Day party, from one corner to the opposite corner. The banner is 12 feet long. How tall is the banner?

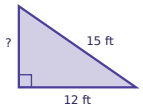

100th Day of School Math · 10

ANSWER

$2.50

100th Day of School Math · 9

ANSWER

$2.25

100th Day of School Math · 12

ANSWER

401.9

100th Day of School Math · 11

ANSWER

50

100th Day of School Math · 14

ANSWER

5

100th Day of School Math · 13

ANSWER

83

100th Day of School Math · 16

ANSWER

9

100th Day of School Math · 15

ANSWER

113

100th Day of School Math · 17

Noah has $20 saved for the 100th Day party and adds $5 every week. How many dollars will Noah have after 4 weeks?

100th Day of School Math · 18

A cylinder-shaped tin of pretzels has a radius of 2 inches and a height of 7 inches. What is its volume in cubic inches?

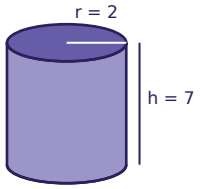

100th Day of School Math · 19

Noah orders 3 party hats online. Shipping costs $2.50, and the total is $9.25. Write and solve an equation to find the price of one party hat.

100th Day of School Math · 20

Zoe orders 7 boxes of crayons online. Shipping costs $3.00, and the total is $25.75. Write and solve an equation to find the price of one box of crayons.

100th Day of School Math · 21

A cylinder-shaped tin of cookies has a radius of 3 inches and a height of 8 inches. What is its volume in cubic inches?

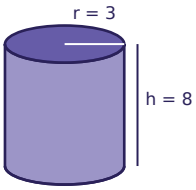

100th Day of School Math · 22

A rectangular banner for the 100th Day party is 12 feet long and 5 feet tall. Zoe runs a string of lights straight across it, from one corner to the opposite corner. How many feet long is the string of lights?

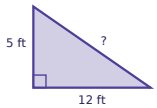

100th Day of School Math · 23

Ella has $5 saved for the 100th Day party and adds $10 every week. How many dollars will Ella have after 10 weeks?

100th Day of School Math · 24

Ava runs a 5-foot string of lights straight across a rectangular banner for the 100th Day party, from one corner to the opposite corner. The banner is 4 feet long. How tall is the banner?

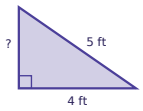

100th Day of School Math · 18

ANSWER

87.9

100th Day of School Math · 17

ANSWER

40

100th Day of School Math · 20

ANSWER

$3.25

100th Day of School Math · 19

ANSWER

$2.25

100th Day of School Math · 22

ANSWER

13

100th Day of School Math · 21

ANSWER

226.1

100th Day of School Math · 24

ANSWER

3

100th Day of School Math · 23

ANSWER

105