100th Day of School Math · 1

A cylinder-shaped tin of pretzels has a radius of 2 inches and a height of 4 inches. What is its volume in cubic inches?

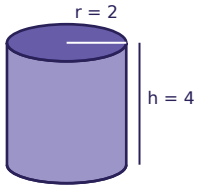


100th Day of School Math · 2

Noah has $15 saved for the 100th Day party and adds $3 every week. How many dollars will Noah have after 9 weeks?

100th Day of School Math · 3

A cylinder-shaped tin of pretzels has a radius of 2 inches and a height of 3 inches. What is its volume in cubic inches?

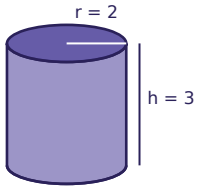


100th Day of School Math · 4

Lily has $25 saved for the 100th Day party and adds $2 every week. How many dollars will Lily have after 3 weeks?

100th Day of School Math · 5

A rectangular banner for the 100th Day party is 8 feet long and 6 feet tall. Ella runs a string of lights straight across it, from one corner to the opposite corner. How many feet long is the string of lights?

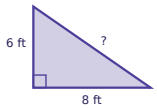


100th Day of School Math · 6

Ella orders 2 party hats online. Shipping costs $6.00, and the total is $11.50. Write and solve an equation to find the price of one party hat.

100th Day of School Math · 7

A rectangular banner for the 100th Day party is 4 feet long and 3 feet tall. Noah runs a string of lights straight across it, from one corner to the opposite corner. How many feet long is the string of lights?

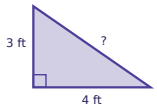


100th Day of School Math · 8

Noah orders 2 party hats online. Shipping costs $8.00, and the total is $13.50. Write and solve an equation to find the price of one party hat.

100th Day of School Math · 2

**ANSWER**

# 42

100th Day of School Math · 1

**ANSWER**

# 50.2

100th Day of School Math · 4

**ANSWER**

# 31

100th Day of School Math · 3

**ANSWER**

# 37.7

100th Day of School Math · 6

**ANSWER**

# $2.75

100th Day of School Math · 5

**ANSWER**

# 10

100th Day of School Math · 8

**ANSWER**

# $2.75

100th Day of School Math · 7

**ANSWER**

# 5

100th Day of School Math · 9

A cylinder-shaped tin of cookies has a radius of 2 inches and a height of 6 inches. What is its volume in cubic inches?

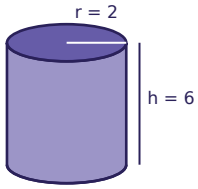


100th Day of School Math · 10

A rectangular banner for the 100th Day party is 4 feet long and 3 feet tall. Omar runs a string of lights straight across it, from one corner to the opposite corner. How many feet long is the string of lights?

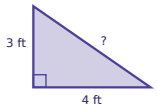


100th Day of School Math · 11

A cylinder-shaped tin of pretzels has a radius of 3 inches and a height of 6 inches. What is its volume in cubic inches?

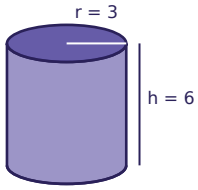


100th Day of School Math · 12

Leo has $30 saved for the 100th Day party and adds $4 every week. How many dollars will Leo have after 6 weeks?

100th Day of School Math · 13

Ben orders 3 party hats online. Shipping costs $3.00, and the total is $6.00. Write and solve an equation to find the price of one party hat.

100th Day of School Math · 14

Mia orders 5 party hats online. Shipping costs $4.00, and the total is $15.25. Write and solve an equation to find the price of one party hat.

100th Day of School Math · 15

Noah has $15 saved for the 100th Day party and adds $3 every week. How many dollars will Noah have after 8 weeks?

100th Day of School Math · 16

A rectangular banner for the 100th Day party is 12 feet long and 5 feet tall. Omar runs a string of lights straight across it, from one corner to the opposite corner. How many feet long is the string of lights?

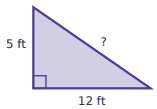

100th Day of School Math · 10

**ANSWER**

**5**

100th Day of School Math · 9

**ANSWER**

**75.4**

100th Day of School Math · 12

**ANSWER**

**54**

100th Day of School Math · 11

**ANSWER**

**169.6**

100th Day of School Math · 14

**ANSWER**

**$2.25**

100th Day of School Math · 13

**ANSWER**

**$1.00**

100th Day of School Math · 16

**ANSWER**

**13**

100th Day of School Math · 15

**ANSWER**

**39**

100th Day of School Math · 17

A rectangular banner for the 100th Day party is 8 feet long and 6 feet tall. Ben runs a string of lights straight across it, from one corner to the opposite corner. How many feet long is the string of lights?

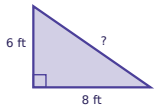


100th Day of School Math · 18

A cylinder-shaped tin of cupcakes has a radius of 3 inches and a height of 7 inches. What is its volume in cubic inches?

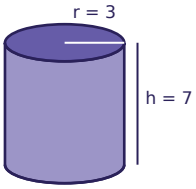


100th Day of School Math · 19

Ava has $20 saved for the 100th Day party and adds $7 every week. How many dollars will Ava have after 10 weeks?

100th Day of School Math · 20

Noah has $10 saved for the 100th Day party and adds $6 every week. How many dollars will Noah have after 10 weeks?

100th Day of School Math · 21

A cylinder-shaped tin of cupcakes has a radius of 3 inches and a height of 3 inches. What is its volume in cubic inches?

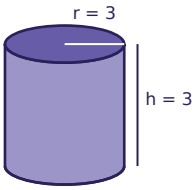


100th Day of School Math · 22

Ben orders 5 party hats online. Shipping costs $4.00, and the total is $9.00. Write and solve an equation to find the price of one party hat.

100th Day of School Math · 23

Ben orders 3 party hats online. Shipping costs $5.00, and the total is $8.00. Write and solve an equation to find the price of one party hat.

100th Day of School Math · 24

A rectangular banner for the 100th Day party is 12 feet long and 5 feet tall. Mia runs a string of lights straight across it, from one corner to the opposite corner. How many feet long is the string of lights?

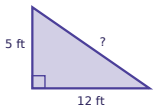

100th Day of School Math · 18

**ANSWER**

# 197.8

100th Day of School Math · 17

**ANSWER**

# 10

100th Day of School Math · 20

**ANSWER**

# 70

100th Day of School Math · 19

**ANSWER**

# 90

100th Day of School Math · 22

**ANSWER**

# $1.00

100th Day of School Math · 21

**ANSWER**

# 84.8

100th Day of School Math · 24

**ANSWER**

# 13

100th Day of School Math · 23

**ANSWER**

# $1.00