Vertical & Adjacent Angles · 1

Find the value of x.

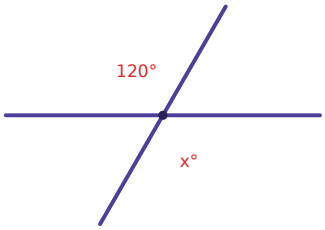

Vertical & Adjacent Angles · 2

Find the value of x.

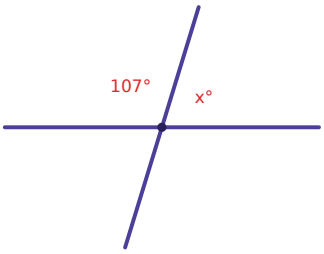

Vertical & Adjacent Angles · 3

Are ∠1 and ∠2 vertical angles or adjacent angles?

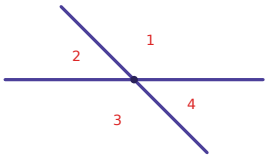

Vertical & Adjacent Angles · 4

Find the value of x.

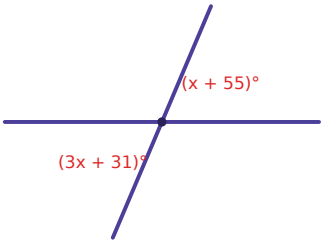

Vertical & Adjacent Angles · 5

Find the value of x.

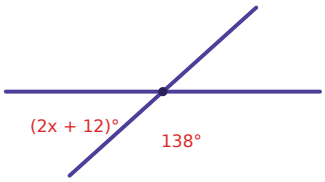

Vertical & Adjacent Angles · 6

Are ∠2 and ∠4 vertical angles or adjacent angles?

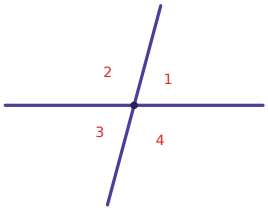

Vertical & Adjacent Angles · 7

Find the value of x.

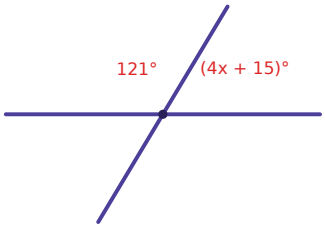

Vertical & Adjacent Angles · 8

Find the value of x.

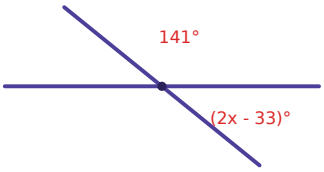

Vertical & Adjacent Angles · 2

ANSWER

73

Vertical & Adjacent Angles · 1

ANSWER

120

Vertical & Adjacent Angles · 4

ANSWER

12

Vertical & Adjacent Angles · 3

ANSWER

Adjacent

Vertical & Adjacent Angles · 6

ANSWER

Vertical

Vertical & Adjacent Angles · 5

ANSWER

15

Vertical & Adjacent Angles · 8

ANSWER

36

Vertical & Adjacent Angles · 7

ANSWER

11

Vertical & Adjacent Angles · 9

Find the value of x.

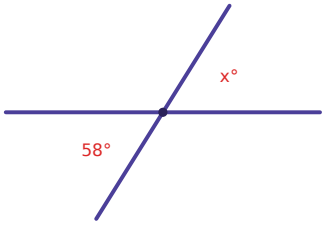

Vertical & Adjacent Angles · 10

Find the value of x.

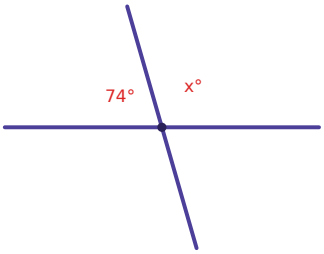

Vertical & Adjacent Angles · 11

Are ∠2 and ∠3 vertical angles or adjacent angles?

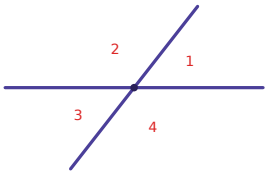

Vertical & Adjacent Angles · 12

Find the value of x.

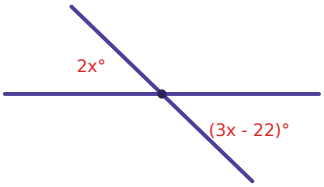

Vertical & Adjacent Angles · 13

Find the value of x.

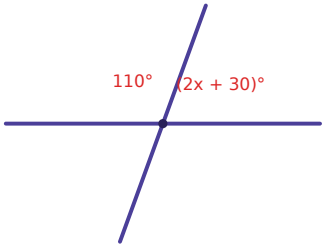

Vertical & Adjacent Angles · 14

Are ∠2 and ∠4 vertical angles or adjacent angles?

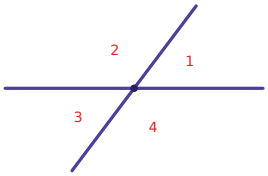

Vertical & Adjacent Angles · 15

Find the value of x.

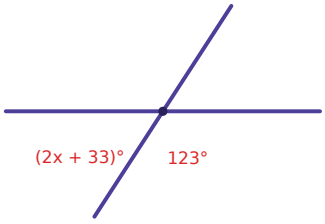

Vertical & Adjacent Angles · 16

Find the value of x.

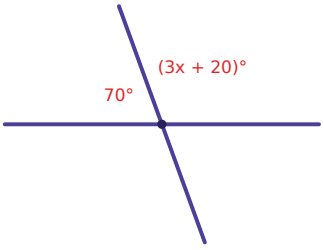

Vertical & Adjacent Angles · 10

ANSWER

106

Vertical & Adjacent Angles · 9

ANSWER

58

Vertical & Adjacent Angles · 12

ANSWER

22

Vertical & Adjacent Angles · 11

ANSWER

Adjacent

Vertical & Adjacent Angles · 14

ANSWER

Vertical

Vertical & Adjacent Angles · 13

ANSWER

20

Vertical & Adjacent Angles · 16

ANSWER

30

Vertical & Adjacent Angles · 15

ANSWER

12

Vertical & Adjacent Angles · 17

Find the value of x.

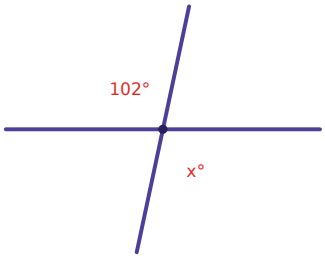

Vertical & Adjacent Angles · 18

Find the value of x.

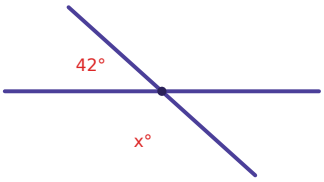

Vertical & Adjacent Angles · 19

Are ∠1 and ∠4 vertical angles or adjacent angles?

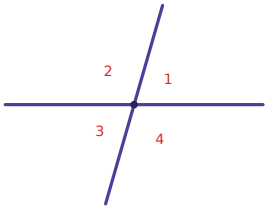

Vertical & Adjacent Angles · 20

Find the value of x.

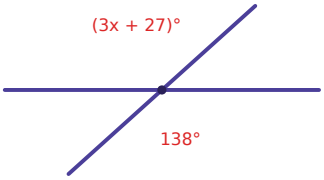

Vertical & Adjacent Angles · 21

Find the value of x.

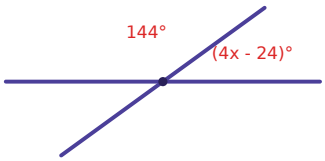

Vertical & Adjacent Angles · 22

Are ∠1 and ∠3 vertical angles or adjacent angles?

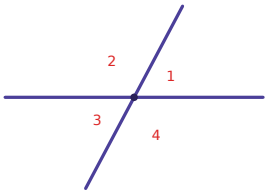

Vertical & Adjacent Angles · 23

Find the value of x.

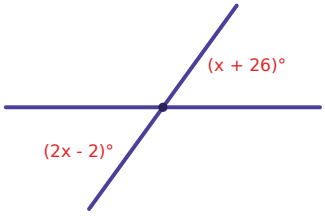

Vertical & Adjacent Angles · 24

Find the value of x.

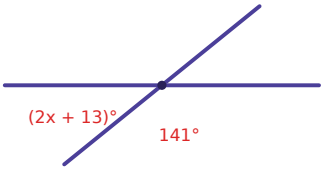

Vertical & Adjacent Angles · 18

ANSWER

138

Vertical & Adjacent Angles · 17

ANSWER

102

Vertical & Adjacent Angles · 20

ANSWER

37

Vertical & Adjacent Angles · 19

ANSWER

Adjacent

Vertical & Adjacent Angles · 22

ANSWER

Vertical

Vertical & Adjacent Angles · 21

ANSWER

15

Vertical & Adjacent Angles · 24

ANSWER

13

Vertical & Adjacent Angles · 23

ANSWER

28