Task card 1 Thanksgiving Math

Lily uses 5 cups of pumpkin puree to make 4 corn muffins. How many cups of pumpkin puree are needed for 3 corn muffins?

Task card 2 Thanksgiving Math

A pumpkin pie costs $16.00. It is 10% off, and then 5% sales tax is added to the sale price. What is the total price?

Task card 3 Thanksgiving Math

Omar uses 5 cups of pumpkin puree to make 4 corn muffins. How many cups of pumpkin puree are needed for 23 corn muffins?

Task card 4 Thanksgiving Math

A grab bag at Thanksgiving dinner holds 6 paper leaves, 1 pinecone and 7 mini pumpkins. Mia takes one without looking. What is the probability that it is a mini pumpkin?

Task card 5 Thanksgiving Math

A round table at Thanksgiving dinner is 3 feet across (its diameter). Omar puts ribbon once around its edge. How many feet of ribbon is that?

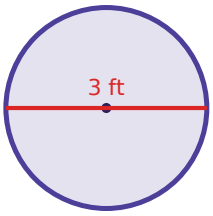

Task card 6 Thanksgiving Math

A round tablecloth for Thanksgiving dinner has a radius of 2 feet. What is its area in square feet?

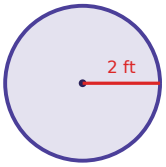

Task card 7 Thanksgiving Math

A grab bag at Thanksgiving dinner holds 5 paper leaves, 1 pinecone and 2 mini pumpkins. Lily takes one without looking. What is the probability that it is a mini pumpkin?

Task card 8 Thanksgiving Math

A jar of cranberry sauce costs $5.00. It is 20% off, and then 6% sales tax is added to the sale price. What is the total price?

Task card 9 Thanksgiving Math

Noah uses 4 cups of pumpkin puree to make 12 corn muffins. How many cups of pumpkin puree are needed for 9 corn muffins?

Task card 10 Thanksgiving Math

Lily uses 4 cups of pumpkin puree to make 8 cranberry tarts. How many cups of pumpkin puree are needed for 18 cranberry tarts?

Task card 11 Thanksgiving Math

A bag of rolls costs $14.00. It is 10% off, and then 8% sales tax is added to the sale price. What is the total price?

Task card 12 Thanksgiving Math

A jar of cranberry sauce costs $8.00. It is 20% off, and then 6% sales tax is added to the sale price. What is the total price?

Task card 13 Thanksgiving Math

A round tablecloth for Thanksgiving dinner has a radius of 7 feet. What is its area in square feet?

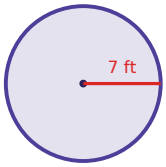

Task card 14 Thanksgiving Math

A round table at Thanksgiving dinner is 7 feet across (its diameter). Ben puts ribbon once around its edge. How many feet of ribbon is that?

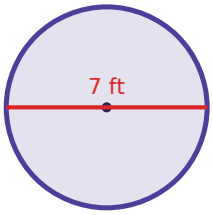

Task card 15 Thanksgiving Math

A grab bag at Thanksgiving dinner holds 8 paper leaves, 9 pinecones and 8 mini pumpkins. Leo takes one without looking. What is the probability that it is a paper leaf?

Task card 16 Thanksgiving Math

A grab bag at Thanksgiving dinner holds 6 paper leaves, 8 pinecones and 6 mini pumpkins. Leo takes one without looking. What is the probability that it is a pinecone?

Task card 17 Thanksgiving Math

A round tablecloth for Thanksgiving dinner has a radius of 4 feet. What is its area in square feet?

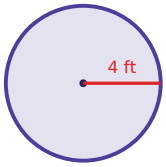

Task card 18 Thanksgiving Math

Zoe uses 5 cups of pumpkin puree to make 6 corn muffins. How many cups of pumpkin puree are needed for 28 corn muffins?

Task card 19 Thanksgiving Math

A round table at Thanksgiving dinner is 9 feet across (its diameter). Ben puts ribbon once around its edge. How many feet of ribbon is that?

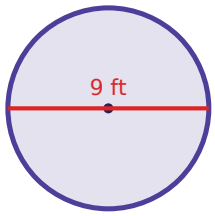

Task card 20 Thanksgiving Math

Sam uses 5 cups of pumpkin puree to make 4 corn muffins. How many cups of pumpkin puree are needed for 18 corn muffins?

Task card 21 Thanksgiving Math

A jar of cranberry sauce costs $10.00. It is 10% off, and then 8% sales tax is added to the sale price. What is the total price?

Task card 22 Thanksgiving Math

A grab bag at Thanksgiving dinner holds 1 paper leaf, 2 pinecones and 6 mini pumpkins. Omar takes one without looking. What is the probability that it is a paper leaf?

Task card 23 Thanksgiving Math

A grab bag at Thanksgiving dinner holds 9 paper leaves, 3 pinecones and 3 mini pumpkins. Leo takes one without looking. What is the probability that it is a paper leaf?

Task card 24 Thanksgiving Math

A pumpkin pie costs $21.00. It is 10% off, and then 6% sales tax is added to the sale price. What is the total price?

Thanksgiving Math Task Cards

Recording sheet · Grade 7 · Read each story and solve. Write money like $12.60 and probabilities as fractions in simplest form. Use 3.14 for π and round to the nearest tenth.

Scan to check your answers

Name: _____ Date: _____

1	2	3	4
5	6	7	8
9	10	11	12
13	14	15	16
17	18	19	20
21	22	23	24

Thanksgiving Math Task Cards: Answer Key

Grade 7 · Hard

The answers online

1. $3\frac{3}{4}$	**2.** $15.12	**3.** $28\frac{3}{4}$
4. $\frac{1}{2}$	**5.** 9.4	**6.** 12.6
7. $\frac{1}{4}$	**8.** $4.24	**9.** 3
10. 9	**11.** $13.61	**12.** $6.78
13. 153.9	**14.** 22	**15.** $\frac{8}{25}$
16. $\frac{2}{5}$	**17.** 50.2	**18.** $23\frac{1}{3}$
19. 28.3	**20.** $22\frac{1}{2}$	**21.** $9.72
22. $\frac{1}{9}$	**23.** $\frac{3}{5}$	**24.** $20.03