Task card 1 Thanksgiving Math

A grab bag at Thanksgiving dinner holds 2 paper leaves, 1 pinecone and 1 mini pumpkin. Lily takes one without looking. What is the probability that it is a mini pumpkin?

Task card 2 Thanksgiving Math

A round tablecloth for Thanksgiving dinner has a radius of 2 feet. What is its area in square feet?

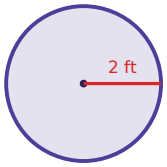

Task card 3 Thanksgiving Math

A grab bag at Thanksgiving dinner holds 2 paper leaves, 3 pinecones and 3 mini pumpkins. Sam takes one without looking. What is the probability that it is a paper leaf?

Task card 4 Thanksgiving Math

A round table at Thanksgiving dinner is 5 feet across (its diameter). Ben puts ribbon once around its edge. How many feet of ribbon is that?

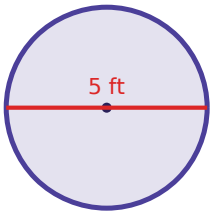

Task card 5 Thanksgiving Math

A bag of rolls costs $5.00. It is on sale for 20% off. What is the sale price?

Task card 6 Thanksgiving Math

Omar uses 3 cups of pumpkin puree to make 4 rolls. How many cups of pumpkin puree are needed for 15 rolls?

Task card 7 Thanksgiving Math

Leo uses 1 cup of pumpkin puree to make 8 rolls. How many cups of pumpkin puree are needed for 14 rolls?

Task card 8 Thanksgiving Math

A bag of rolls costs $15.00. It is on sale for 40% off. What is the sale price?

Task card 9 Thanksgiving Math

A pumpkin pie costs $18.00. It is on sale for 50% off. What is the sale price?

Task card 10 Thanksgiving Math

A round tablecloth for Thanksgiving dinner has a radius of 3 feet. What is its area in square feet?

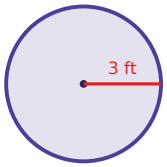

Task card 11 Thanksgiving Math

Ella uses 3 cups of pumpkin puree to make 8 cranberry tarts. How many cups of pumpkin puree are needed for 4 cranberry tarts?

Task card 12 Thanksgiving Math

A jar of cranberry sauce costs $11.00. It is on sale for 10% off. What is the sale price?

Task card 13 Thanksgiving Math

Lily uses 2 cups of pumpkin puree to make 4 corn muffins. How many cups of pumpkin puree are needed for 22 corn muffins?

Task card 14 Thanksgiving Math

A grab bag at Thanksgiving dinner holds 5 paper leaves, 3 pinecones and 1 mini pumpkin. Ella takes one without looking. What is the probability that it is a pinecone?

Task card 15 Thanksgiving Math

A grab bag at Thanksgiving dinner holds 3 paper leaves, 2 pinecones and 5 mini pumpkins. Ava takes one without looking. What is the probability that it is a mini pumpkin?

Task card 16 Thanksgiving Math

Lily uses 3 cups of pumpkin puree to make 4 rolls. How many cups of pumpkin puree are needed for 14 rolls?

Task card 17 Thanksgiving Math

A grab bag at Thanksgiving dinner holds 5 paper leaves, 5 pinecones and 6 mini pumpkins. Lily takes one without looking. What is the probability that it is a paper leaf?

Task card 18 Thanksgiving Math

A jar of cranberry sauce costs $7.00. It is on sale for 10% off. What is the sale price?

Task card 19 Thanksgiving Math

A grab bag at Thanksgiving dinner holds 5 paper leaves, 1 pinecone and 2 mini pumpkins. Noah takes one without looking. What is the probability that it is a pinecone?

Task card 20 Thanksgiving Math

A pumpkin pie costs $12.00. It is on sale for 25% off. What is the sale price?

Task card 21 Thanksgiving Math

Lily uses 1 cup of pumpkin puree to make 12 corn muffins. How many cups of pumpkin puree are needed for 21 corn muffins?

Task card 22 Thanksgiving Math

Sam uses 3 cups of pumpkin puree to make 12 corn muffins. How many cups of pumpkin puree are needed for 33 corn muffins?

Task card 23 Thanksgiving Math

A jar of cranberry sauce costs $6.00. It is on sale for 20% off. What is the sale price?

Task card 24 Thanksgiving Math

A grab bag at Thanksgiving dinner holds 1 paper leaf, 1 pinecone and 2 mini pumpkins. Omar takes one without looking. What is the probability that it is a pinecone?

Thanksgiving Math Task Cards

Recording sheet · Grade 7 · Read each story and solve. Write money like $12.60 and probabilities as fractions in simplest form. Use 3.14 for π and round to the nearest tenth.

Scan to check your answers

Name: _____ Date: _____

1	2	3	4
5	6	7	8
9	10	11	12
13	14	15	16
17	18	19	20
21	22	23	24

Thanksgiving Math Task Cards: Answer Key

Grade 7 · Easy

The answers online

1. $\frac{1}{4}$	**2.** 12.6	**3.** $\frac{1}{4}$
4. 15.7	**5.** $4.00	**6.** $11\frac{1}{4}$
7. $1\frac{3}{4}$	**8.** $9.00	**9.** $9.00
10. 28.3	**11.** $1\frac{1}{2}$	**12.** $9.90
13. 11	**14.** $\frac{1}{3}$	**15.** $\frac{1}{2}$
16. $10\frac{1}{2}$	**17.** $\frac{5}{16}$	**18.** $6.30
19. $\frac{1}{8}$	**20.** $9.00	**21.** $1\frac{3}{4}$
22. $8\frac{1}{4}$	**23.** $4.80	**24.** $\frac{1}{4}$