Thanksgiving Math · 1

Lily uses 5 cups of pumpkin puree to make 4 corn muffins. How many cups of pumpkin puree are needed for 3 corn muffins?

Thanksgiving Math · 2

A pumpkin pie costs $16.00. It is 10% off, and then 5% sales tax is added to the sale price. What is the total price?

Thanksgiving Math · 3

Omar uses 5 cups of pumpkin puree to make 4 corn muffins. How many cups of pumpkin puree are needed for 23 corn muffins?

Thanksgiving Math · 4

A grab bag at Thanksgiving dinner holds 6 paper leaves, 1 pinecone and 7 mini pumpkins. Mia takes one without looking. What is the probability that it is a mini pumpkin?

Thanksgiving Math · 5

A round table at Thanksgiving dinner is 3 feet across (its diameter). Omar puts ribbon once around its edge. How many feet of ribbon is that?

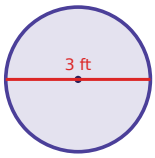

Thanksgiving Math · 6

A round tablecloth for Thanksgiving dinner has a radius of 2 feet. What is its area in square feet?

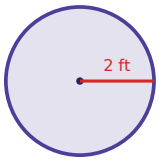

Thanksgiving Math · 7

A grab bag at Thanksgiving dinner holds 5 paper leaves, 1 pinecone and 2 mini pumpkins. Lily takes one without looking. What is the probability that it is a mini pumpkin?

Thanksgiving Math · 8

A jar of cranberry sauce costs $5.00. It is 20% off, and then 6% sales tax is added to the sale price. What is the total price?

Thanksgiving Math · 2

ANSWER

$15.12

Thanksgiving Math · 1

ANSWER

$$3\frac{3}{4}$$

Thanksgiving Math · 4

ANSWER

$$\frac{1}{2}$$

Thanksgiving Math · 3

ANSWER

$$28\frac{3}{4}$$

Thanksgiving Math · 6

ANSWER

12.6

Thanksgiving Math · 5

ANSWER

9.4

Thanksgiving Math · 8

ANSWER

$4.24

Thanksgiving Math · 7

ANSWER

$$\frac{1}{4}$$

Thanksgiving Math · 9

Noah uses 4 cups of pumpkin puree to make 12 corn muffins. How many cups of pumpkin puree are needed for 9 corn muffins?

Thanksgiving Math · 10

Lily uses 4 cups of pumpkin puree to make 8 cranberry tarts. How many cups of pumpkin puree are needed for 18 cranberry tarts?

Thanksgiving Math · 11

A bag of rolls costs $14.00. It is 10% off, and then 8% sales tax is added to the sale price. What is the total price?

Thanksgiving Math · 12

A jar of cranberry sauce costs $8.00. It is 20% off, and then 6% sales tax is added to the sale price. What is the total price?

Thanksgiving Math · 13

A round tablecloth for Thanksgiving dinner has a radius of 7 feet. What is its area in square feet?

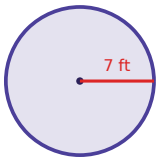

Thanksgiving Math · 14

A round table at Thanksgiving dinner is 7 feet across (its diameter). Ben puts ribbon once around its edge. How many feet of ribbon is that?

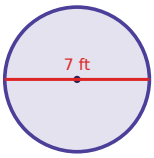

Thanksgiving Math · 15

A grab bag at Thanksgiving dinner holds 8 paper leaves, 9 pinecones and 8 mini pumpkins. Leo takes one without looking. What is the probability that it is a paper leaf?

Thanksgiving Math · 16

A grab bag at Thanksgiving dinner holds 6 paper leaves, 8 pinecones and 6 mini pumpkins. Leo takes one without looking. What is the probability that it is a pinecone?

Thanksgiving Math · 10

ANSWER

9

Thanksgiving Math · 9

ANSWER

3

Thanksgiving Math · 12

ANSWER

$6.78

Thanksgiving Math · 11

ANSWER

$13.61

Thanksgiving Math · 14

ANSWER

22

Thanksgiving Math · 13

ANSWER

153.9

Thanksgiving Math · 16

ANSWER

$$\frac{2}{5}$$

Thanksgiving Math · 15

ANSWER

$$\frac{8}{25}$$

Thanksgiving Math · 17

A round tablecloth for Thanksgiving dinner has a radius of 4 feet. What is its area in square feet?

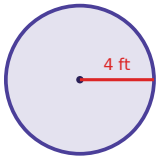

Thanksgiving Math · 18

Zoe uses 5 cups of pumpkin puree to make 6 corn muffins. How many cups of pumpkin puree are needed for 28 corn muffins?

Thanksgiving Math · 19

A round table at Thanksgiving dinner is 9 feet across (its diameter). Ben puts ribbon once around its edge. How many feet of ribbon is that?

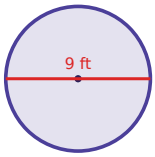

Thanksgiving Math · 20

Sam uses 5 cups of pumpkin puree to make 4 corn muffins. How many cups of pumpkin puree are needed for 18 corn muffins?

Thanksgiving Math · 21

A jar of cranberry sauce costs $10.00. It is 10% off, and then 8% sales tax is added to the sale price. What is the total price?

Thanksgiving Math · 22

A grab bag at Thanksgiving dinner holds 1 paper leaf, 2 pinecones and 6 mini pumpkins. Omar takes one without looking. What is the probability that it is a paper leaf?

Thanksgiving Math · 23

A grab bag at Thanksgiving dinner holds 9 paper leaves, 3 pinecones and 3 mini pumpkins. Leo takes one without looking. What is the probability that it is a paper leaf?

Thanksgiving Math · 24

A pumpkin pie costs $21.00. It is 10% off, and then 6% sales tax is added to the sale price. What is the total price?

Thanksgiving Math · 18

ANSWER

$23\frac{1}{3}$

Thanksgiving Math · 17

ANSWER

50.2

Thanksgiving Math · 20

ANSWER

$22\frac{1}{2}$

Thanksgiving Math · 19

ANSWER

28.3

Thanksgiving Math · 22

ANSWER

$\frac{1}{9}$

Thanksgiving Math · 21

ANSWER

$9.72

Thanksgiving Math · 24

ANSWER

$20.03

Thanksgiving Math · 23

ANSWER

$\frac{3}{5}$