Thanksgiving Math · 1

A grab bag at Thanksgiving dinner holds 1 paper leaf, 6 pinecones and 3 mini pumpkins. Lily takes one without looking. What is the probability that it is a paper leaf?

Thanksgiving Math · 2

Lily uses 1 cup of pumpkin puree to make 8 corn muffins. How many cups of pumpkin puree are needed for 6 corn muffins?

Thanksgiving Math · 3

A grab bag at Thanksgiving dinner holds 5 paper leaves, 5 pinecones and 3 mini pumpkins. Ella takes one without looking. What is the probability that it is a mini pumpkin?

Thanksgiving Math · 4

A pumpkin pie costs $13.00. It is on sale for 20% off. What is the sale price?

Thanksgiving Math · 5

A round table at Thanksgiving dinner is 5 feet across (its diameter). Ben puts ribbon once around its edge. How many feet of ribbon is that?

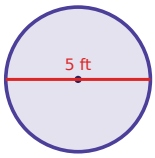

Thanksgiving Math · 6

Leo uses 1 cup of pumpkin puree to make 4 cranberry tarts. How many cups of pumpkin puree are needed for 23 cranberry tarts?

Thanksgiving Math · 7

A bag of rolls costs $15.00. It is on sale for 40% off. What is the sale price?

Thanksgiving Math · 8

A round table at Thanksgiving dinner is 7 feet across (its diameter). Lily puts ribbon once around its edge. How many feet of ribbon is that?

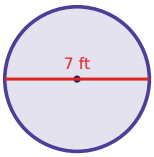

Thanksgiving Math · 2

ANSWER

$\frac{3}{4}$

Thanksgiving Math · 1

ANSWER

$\frac{1}{10}$

Thanksgiving Math · 4

ANSWER

$10.40

Thanksgiving Math · 3

ANSWER

$\frac{3}{13}$

Thanksgiving Math · 6

ANSWER

$5\frac{3}{4}$

Thanksgiving Math · 5

ANSWER

15.7

Thanksgiving Math · 8

ANSWER

22

Thanksgiving Math · 7

ANSWER

$9.00

Thanksgiving Math · 9

Leo uses 4 cups of pumpkin puree to make 6 rolls. How many cups of pumpkin puree are needed for 16 rolls?

Thanksgiving Math · 10

A grab bag at Thanksgiving dinner holds 7 paper leaves, 6 pinecones and 8 mini pumpkins. Mia takes one without looking. What is the probability that it is a paper leaf?

Thanksgiving Math · 11

A pumpkin pie costs $15.00. It is 40% off, and then 8% sales tax is added to the sale price. What is the total price?

Thanksgiving Math · 12

A round table at Thanksgiving dinner is 9 feet across (its diameter). Ava puts ribbon once around its edge. How many feet of ribbon is that?

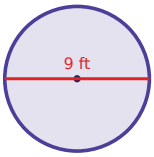

Thanksgiving Math · 13

Sam uses 3 cups of pumpkin puree to make 12 corn muffins. How many cups of pumpkin puree are needed for 15 corn muffins?

Thanksgiving Math · 14

A pumpkin pie costs $11.00. It is 30% off, and then 8% sales tax is added to the sale price. What is the total price?

Thanksgiving Math · 15

A grab bag at Thanksgiving dinner holds 4 paper leaves, 8 pinecones and 1 mini pumpkin. Ben takes one without looking. What is the probability that it is a pinecone?

Thanksgiving Math · 16

A round tablecloth for Thanksgiving dinner has a radius of 3 feet. What is its area in square feet?

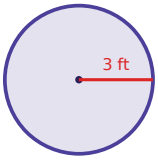

Thanksgiving Math · 10

ANSWER

$\frac{1}{3}$

Thanksgiving Math · 9

ANSWER

$10\frac{2}{3}$

Thanksgiving Math · 12

ANSWER

28.3

Thanksgiving Math · 11

ANSWER

$9.72

Thanksgiving Math · 14

ANSWER

$8.32

Thanksgiving Math · 13

ANSWER

$3\frac{3}{4}$

Thanksgiving Math · 16

ANSWER

28.3

Thanksgiving Math · 15

ANSWER

$\frac{8}{13}$

Thanksgiving Math · 17

A round tablecloth for Thanksgiving dinner has a radius of 6 feet. What is its area in square feet?

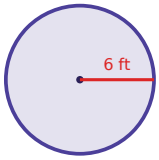

Thanksgiving Math · 18

Ava uses 3 cups of pumpkin puree to make 6 cranberry tarts. How many cups of pumpkin puree are needed for 5 cranberry tarts?

Thanksgiving Math · 19

Ben uses 3 cups of pumpkin puree to make 4 cranberry tarts. How many cups of pumpkin puree are needed for 5 cranberry tarts?

Thanksgiving Math · 20

A grab bag at Thanksgiving dinner holds 3 paper leaves, 7 pinecones and 9 mini pumpkins. Leo takes one without looking. What is the probability that it is a mini pumpkin?

Thanksgiving Math · 21

A jar of cranberry sauce costs $4.00. It is 10% off, and then 6% sales tax is added to the sale price. What is the total price?

Thanksgiving Math · 22

A grab bag at Thanksgiving dinner holds 1 paper leaf, 2 pinecones and 7 mini pumpkins. Ava takes one without looking. What is the probability that it is a pinecone?

Thanksgiving Math · 23

A bag of rolls costs $7.00. It is 25% off, and then 5% sales tax is added to the sale price. What is the total price?

Thanksgiving Math · 24

A grab bag at Thanksgiving dinner holds 1 paper leaf, 5 pinecones and 5 mini pumpkins. Ella takes one without looking. What is the probability that it is a paper leaf?

Thanksgiving Math · 18

ANSWER

$2\frac{1}{2}$

Thanksgiving Math · 17

ANSWER

113

Thanksgiving Math · 20

ANSWER

$\frac{9}{19}$

Thanksgiving Math · 19

ANSWER

$3\frac{3}{4}$

Thanksgiving Math · 22

ANSWER

$\frac{1}{5}$

Thanksgiving Math · 21

ANSWER

$3.82

Thanksgiving Math · 24

ANSWER

$\frac{1}{11}$

Thanksgiving Math · 23

ANSWER

$5.51