Thanksgiving Math · 1

A grab bag at Thanksgiving dinner holds 2 paper leaves, 1 pinecone and 1 mini pumpkin. Lily takes one without looking. What is the probability that it is a mini pumpkin?

Thanksgiving Math · 2

A round tablecloth for Thanksgiving dinner has a radius of 2 feet. What is its area in square feet?

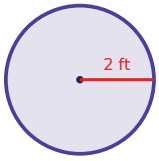

Thanksgiving Math · 3

A grab bag at Thanksgiving dinner holds 2 paper leaves, 3 pinecones and 3 mini pumpkins. Sam takes one without looking. What is the probability that it is a paper leaf?

Thanksgiving Math · 4

A round table at Thanksgiving dinner is 5 feet across (its diameter). Ben puts ribbon once around its edge. How many feet of ribbon is that?

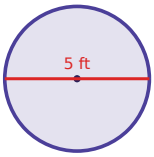

Thanksgiving Math · 5

A bag of rolls costs $5.00. It is on sale for 20% off. What is the sale price?

Thanksgiving Math · 6

Omar uses 3 cups of pumpkin puree to make 4 rolls. How many cups of pumpkin puree are needed for 15 rolls?

Thanksgiving Math · 7

Leo uses 1 cup of pumpkin puree to make 8 rolls. How many cups of pumpkin puree are needed for 14 rolls?

Thanksgiving Math · 8

A bag of rolls costs $15.00. It is on sale for 40% off. What is the sale price?

Thanksgiving Math · 2

ANSWER

12.6

Thanksgiving Math · 1

ANSWER

$$\frac{1}{4}$$

Thanksgiving Math · 4

ANSWER

15.7

Thanksgiving Math · 3

ANSWER

$$\frac{1}{4}$$

Thanksgiving Math · 6

ANSWER

$$11\ \frac{1}{4}$$

Thanksgiving Math · 5

ANSWER

$4.00

Thanksgiving Math · 8

ANSWER

$9.00

Thanksgiving Math · 7

ANSWER

$$1\ \frac{3}{4}$$

Thanksgiving Math · 9

A pumpkin pie costs $18.00. It is on sale for 50% off. What is the sale price?

Thanksgiving Math · 10

A round tablecloth for Thanksgiving dinner has a radius of 3 feet. What is its area in square feet?

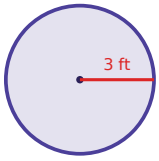

Thanksgiving Math · 11

Ella uses 3 cups of pumpkin puree to make 8 cranberry tarts. How many cups of pumpkin puree are needed for 4 cranberry tarts?

Thanksgiving Math · 12

A jar of cranberry sauce costs $11.00. It is on sale for 10% off. What is the sale price?

Thanksgiving Math · 13

Lily uses 2 cups of pumpkin puree to make 4 corn muffins. How many cups of pumpkin puree are needed for 22 corn muffins?

Thanksgiving Math · 14

A grab bag at Thanksgiving dinner holds 5 paper leaves, 3 pinecones and 1 mini pumpkin. Ella takes one without looking. What is the probability that it is a pinecone?

Thanksgiving Math · 15

A grab bag at Thanksgiving dinner holds 3 paper leaves, 2 pinecones and 5 mini pumpkins. Ava takes one without looking. What is the probability that it is a mini pumpkin?

Thanksgiving Math · 16

Lily uses 3 cups of pumpkin puree to make 4 rolls. How many cups of pumpkin puree are needed for 14 rolls?

Thanksgiving Math · 10

ANSWER

28.3

Thanksgiving Math · 9

ANSWER

$9.00

Thanksgiving Math · 12

ANSWER

$9.90

Thanksgiving Math · 11

ANSWER

$$1\frac{1}{2}$$

Thanksgiving Math · 14

ANSWER

$$\frac{1}{3}$$

Thanksgiving Math · 13

ANSWER

11

Thanksgiving Math · 16

ANSWER

$$10\frac{1}{2}$$

Thanksgiving Math · 15

ANSWER

$$\frac{1}{2}$$

Thanksgiving Math · 17

A grab bag at Thanksgiving dinner holds 5 paper leaves, 5 pinecones and 6 mini pumpkins. Lily takes one without looking. What is the probability that it is a paper leaf?

Thanksgiving Math · 18

A jar of cranberry sauce costs $7.00. It is on sale for 10% off. What is the sale price?

Thanksgiving Math · 19

A grab bag at Thanksgiving dinner holds 5 paper leaves, 1 pinecone and 2 mini pumpkins. Noah takes one without looking. What is the probability that it is a pinecone?

Thanksgiving Math · 20

A pumpkin pie costs $12.00. It is on sale for 25% off. What is the sale price?

Thanksgiving Math · 21

Lily uses 1 cup of pumpkin puree to make 12 corn muffins. How many cups of pumpkin puree are needed for 21 corn muffins?

Thanksgiving Math · 22

Sam uses 3 cups of pumpkin puree to make 12 corn muffins. How many cups of pumpkin puree are needed for 33 corn muffins?

Thanksgiving Math · 23

A jar of cranberry sauce costs $6.00. It is on sale for 20% off. What is the sale price?

Thanksgiving Math · 24

A grab bag at Thanksgiving dinner holds 1 paper leaf, 1 pinecone and 2 mini pumpkins. Omar takes one without looking. What is the probability that it is a pinecone?

Thanksgiving Math · 18

ANSWER

$6.30

Thanksgiving Math · 17

ANSWER

$$\frac{5}{16}$$

Thanksgiving Math · 20

ANSWER

$9.00

Thanksgiving Math · 19

ANSWER

$$\frac{1}{8}$$

Thanksgiving Math · 22

ANSWER

$$8\ \frac{1}{4}$$

Thanksgiving Math · 21

ANSWER

$$1\ \frac{3}{4}$$

Thanksgiving Math · 24

ANSWER

$$\frac{1}{4}$$

Thanksgiving Math · 23

ANSWER

$4.80