Task card 1 Surface Area & Volume of Prisms (M...

Find the volume of a rectangular prism with length 8, width 5, and height 4.

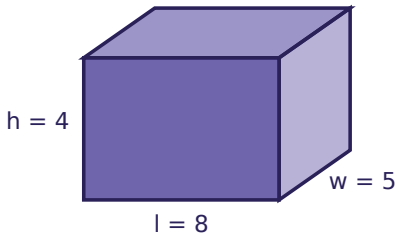

Task card 2 Surface Area & Volume of Prisms (M...

Find the surface area of a rectangular prism with length 7, width 3, and height 7.

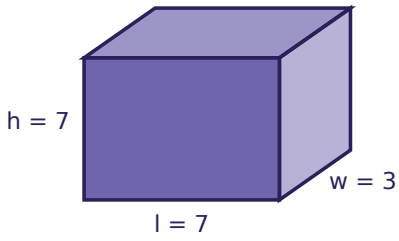

Task card 3 Surface Area & Volume of Prisms (M...

Find the volume of a triangular prism with a triangular base of base 4 and height 4, and a prism length of 4.

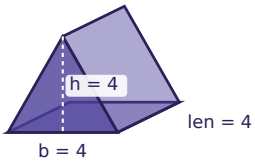

Task card 4 Surface Area & Volume of Prisms (M...

Find the volume of a rectangular prism with length 4, width 6, and height 6.

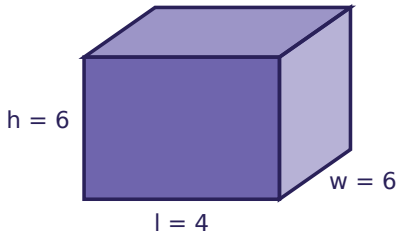

Task card 5 Surface Area & Volume of Prisms (M...

Find the surface area of a rectangular prism with length 3, width 4, and height 3.

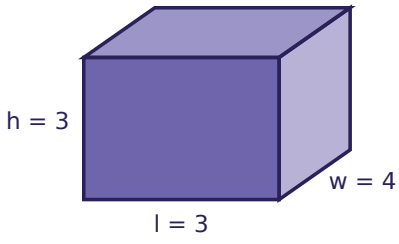

Task card 6 Surface Area & Volume of Prisms (M...

Find the volume of a triangular prism with a triangular base of base 8 and height 4, and a prism length of 5.

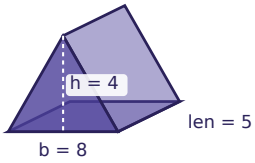

Task card 7 Surface Area & Volume of Prisms (M...

Find the volume of a rectangular prism with length 2, width 4, and height 3.

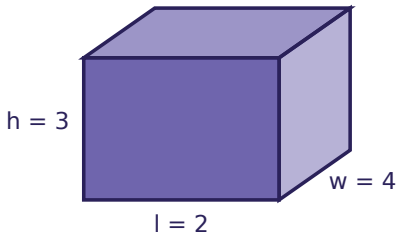

Task card 8 Surface Area & Volume of Prisms (M...

Find the surface area of a rectangular prism with length 3, width 7, and height 3.

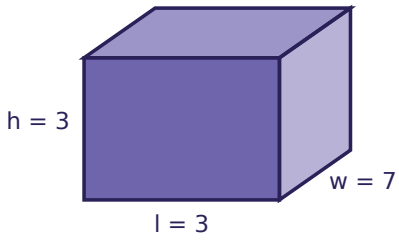

Task card 9 Surface Area & Volume of Prisms (M...

Find the volume of a rectangular prism with length 4, width 9, and height 3.

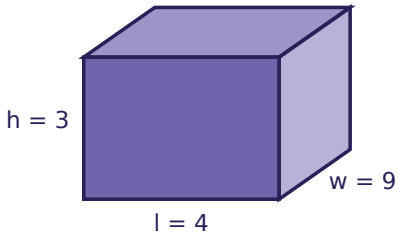

Task card 10 Surface Area & Volume of Prisms (M...

Find the surface area of a rectangular prism with length 4, width 9, and height 2.

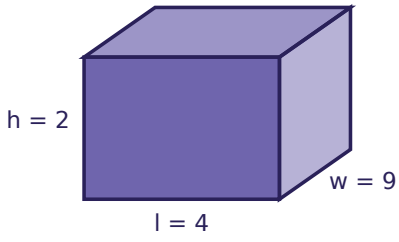

Task card 11 Surface Area & Volume of Prisms (M...

Find the volume of a triangular prism with a triangular base of base 4 and height 2, and a prism length of 4.

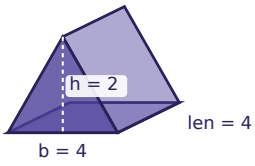

Task card 12 Surface Area & Volume of Prisms (M...

Find the volume of a rectangular prism with length 5, width 2, and height 9.

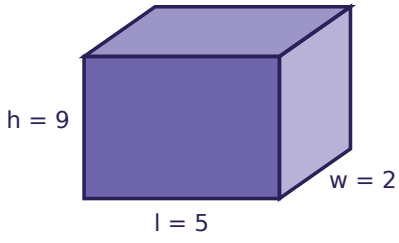

Task card 13 Surface Area & Volume of Prisms (M...

Find the surface area of a rectangular prism with length 3, width 9, and height 9.

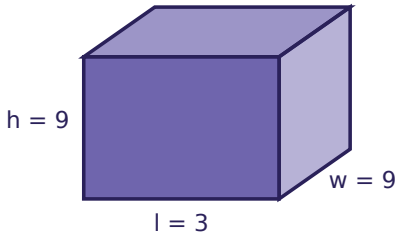

Task card 14 Surface Area & Volume of Prisms (M...

Find the volume of a triangular prism with a triangular base of base 3 and height 6, and a prism length of 7.

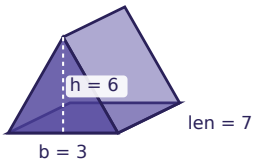

Task card 15 Surface Area & Volume of Prisms (M...

Find the volume of a rectangular prism with length 8, width 7, and height 4.

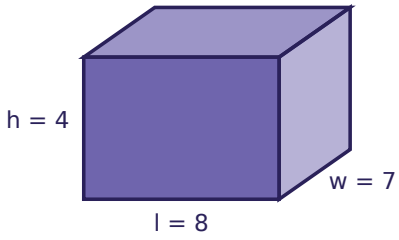

Task card 16 Surface Area & Volume of Prisms (M...

Find the surface area of a rectangular prism with length 2, width 8, and height 3.

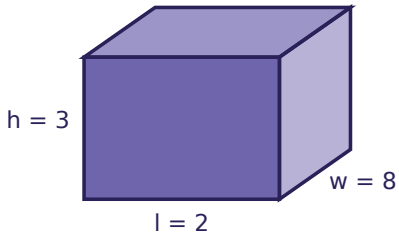

Task card 17 Surface Area & Volume of Prisms (M...

Find the volume of a rectangular prism with length 10, width 5, and height 7.

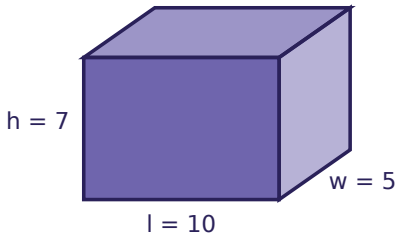

Task card 18 Surface Area & Volume of Prisms (M...

Find the surface area of a rectangular prism with length 9, width 2, and height 4.

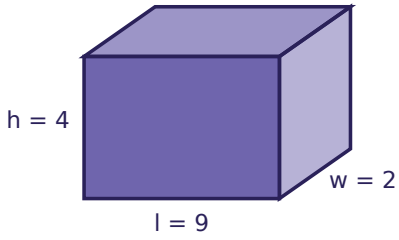

Task card 19 Surface Area & Volume of Prisms (M...

Find the volume of a triangular prism with a triangular base of base 7 and height 8, and a prism length of 7.

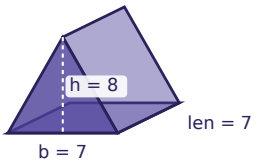

Task card 20 Surface Area & Volume of Prisms (M...

Find the volume of a rectangular prism with length 7, width 5, and height 9.

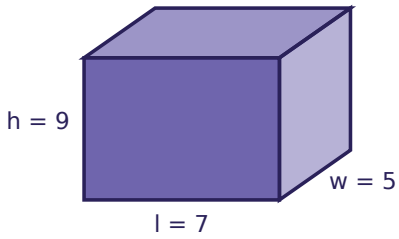

Task card 21 Surface Area & Volume of Prisms (M...

Find the surface area of a rectangular prism with length 8, width 5, and height 6.

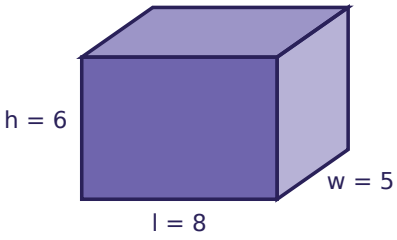

Task card 22 Surface Area & Volume of Prisms (M...

Find the volume of a triangular prism with a triangular base of base 2 and height 6, and a prism length of 9.

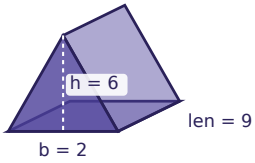

Task card 23 Surface Area & Volume of Prisms (M...

Find the volume of a rectangular prism with length 5, width 4, and height 10.

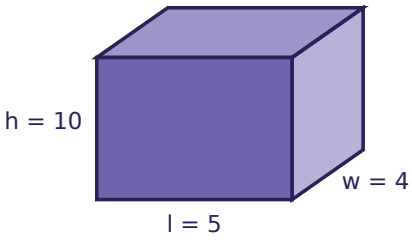

Task card 24 Surface Area & Volume of Prisms (M...

Find the surface area of a rectangular prism with length 6, width 5, and height 8.

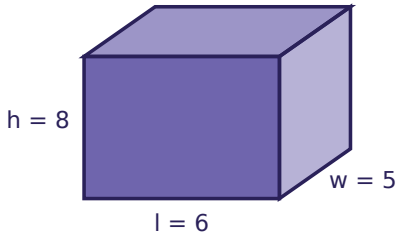

Surface Area & Volume of Prisms (Mixed Review) Task Cards

Recording sheet · Grade 7 · Solve each problem.

Scan to check your answers

Name: _____ Date: _____

1	2	3	4
5	6	7	8
9	10	11	12
13	14	15	16
17	18	19	20
21	22	23	24

Surface Area & Volume of Prisms (Mixed Review) Task Cards: Answer Key

Grade 7 · Medium

The answers online

1. 160	**2.** 182	**3.** 32
4. 144	**5.** 66	**6.** 80
7. 24	**8.** 102	**9.** 108
10. 124	**11.** 16	**12.** 90
13. 270	**14.** 63	**15.** 224
16. 92	**17.** 350	**18.** 124
19. 196	**20.** 315	**21.** 236
22. 54	**23.** 200	**24.** 236