Task card 1 Surface Area & Volume of Prisms (M...

Find the volume of a rectangular prism with length 4, width 4, and height 4.

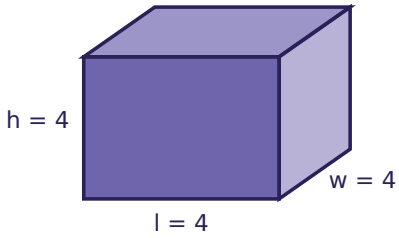

Task card 2 Surface Area & Volume of Prisms (M...

Find the surface area of a rectangular prism with length 5, width 3, and height 2.

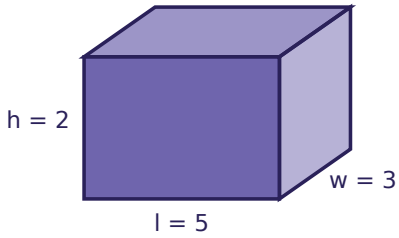

Task card 3 Surface Area & Volume of Prisms (M...

Find the volume of a triangular prism with a triangular base of base 3 and height 2, and a prism length of 3.

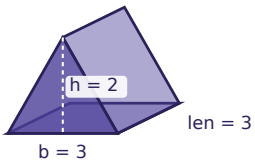

Task card 4 Surface Area & Volume of Prisms (M...

Find the volume of a rectangular prism with length 2, width 4, and height 4.

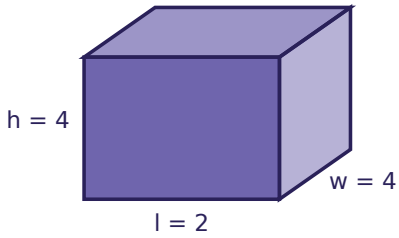

Task card 5 Surface Area & Volume of Prisms (M...

Find the surface area of a rectangular prism with length 4, width 3, and height 4.

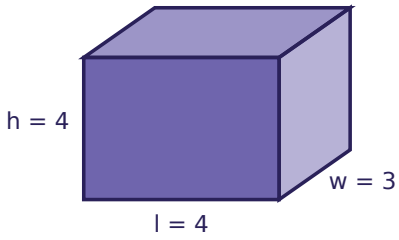

Task card 6 Surface Area & Volume of Prisms (M...

Find the volume of a triangular prism with a triangular base of base 3 and height 2, and a prism length of 4.

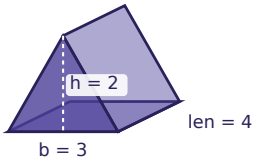

Task card 7 Surface Area & Volume of Prisms (M...

Find the volume of a rectangular prism with length 2, width 2, and height 2.

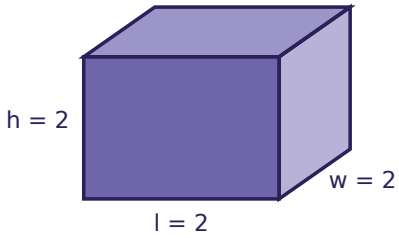

Task card 8 Surface Area & Volume of Prisms (M...

Find the surface area of a rectangular prism with length 3, width 2, and height 3.

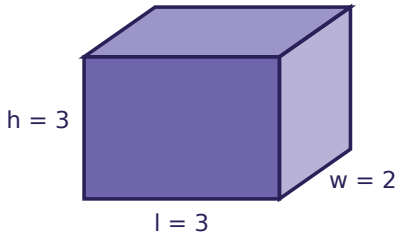

Task card 9 Surface Area & Volume of Prisms (M...

Find the volume of a rectangular prism with length 5, width 6, and height 2.

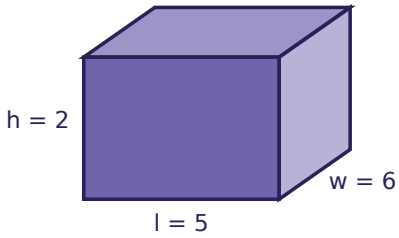

Task card 10 Surface Area & Volume of Prisms (M...

Find the surface area of a rectangular prism with length 3, width 4, and height 4.

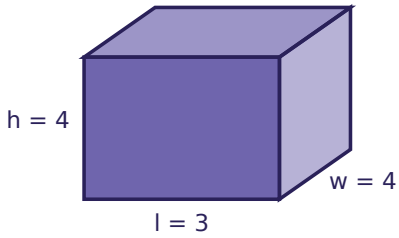

Task card 11 Surface Area & Volume of Prisms (M...

Find the volume of a triangular prism with a triangular base of base 6 and height 2, and a prism length of 2.

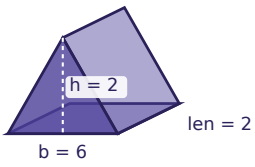

Task card 12 Surface Area & Volume of Prisms (M...

Find the volume of a rectangular prism with length 2, width 5, and height 3.

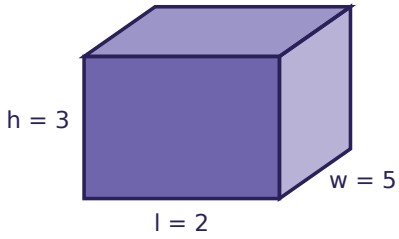

Task card 13 Surface Area & Volume of Prisms (M...

Find the surface area of a rectangular prism with length 6, width 3, and height 3.

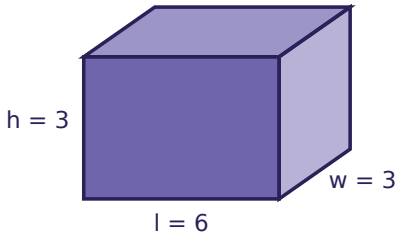

Task card 14 Surface Area & Volume of Prisms (M...

Find the volume of a triangular prism with a triangular base of base 5 and height 2, and a prism length of 4.

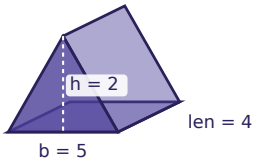

Task card 15 Surface Area & Volume of Prisms (M...

Find the volume of a rectangular prism with length 5, width 5, and height 3.

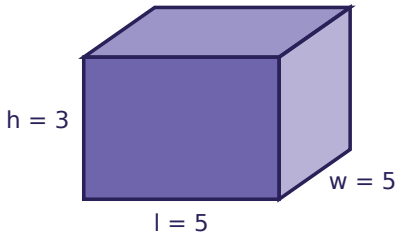

Task card 16 Surface Area & Volume of Prisms (M...

Find the surface area of a rectangular prism with length 2, width 4, and height 3.

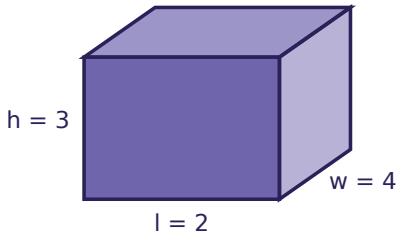

Task card 17 Surface Area & Volume of Prisms (M...

Find the volume of a rectangular prism with length 2, width 2, and height 7.

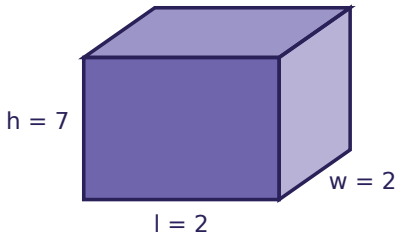

Task card 18 Surface Area & Volume of Prisms (M...

Find the surface area of a rectangular prism with length 4, width 4, and height 5.

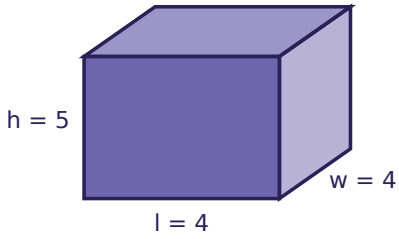

Task card 19 Surface Area & Volume of Prisms (M...

Find the volume of a triangular prism with a triangular base of base 4 and height 2, and a prism length of 7.

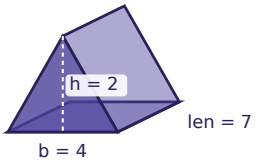

Task card 20 Surface Area & Volume of Prisms (M...

Find the volume of a rectangular prism with length 7, width 2, and height 6.

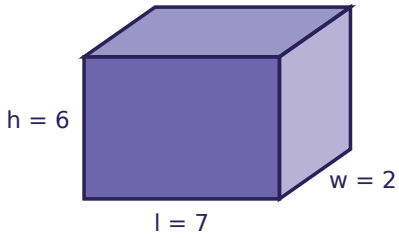

Task card 21 Surface Area & Volume of Prisms (M...

Find the surface area of a rectangular prism with length 5, width 3, and height 5.

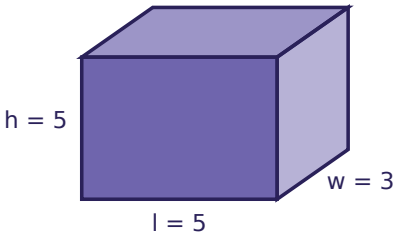

Task card 22 Surface Area & Volume of Prisms (M...

Find the volume of a triangular prism with a triangular base of base 3 and height 4, and a prism length of 5.

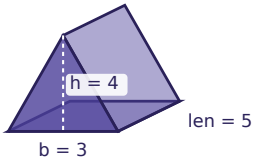

Task card 23 Surface Area & Volume of Prisms (M...

Find the volume of a rectangular prism with length 5, width 4, and height 3.

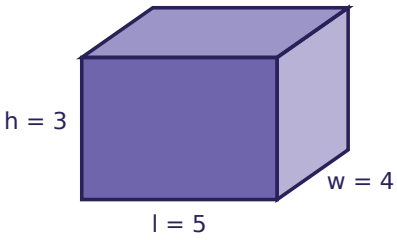

Task card 24 Surface Area & Volume of Prisms (M...

Find the surface area of a rectangular prism with length 3, width 4, and height 3.

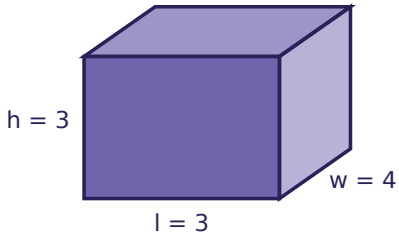

Surface Area & Volume of Prisms (Mixed Review) Task Cards

Recording sheet · Grade 7 · Solve each problem.

Scan to check your answers

Name: _____ Date: _____

1	2	3	4
5	6	7	8
9	10	11	12
13	14	15	16
17	18	19	20
21	22	23	24

Surface Area & Volume of Prisms (Mixed Review) Task Cards: Answer Key

Grade 7 · Easy

The answers online

1. 64	**2.** 62	**3.** 9
4. 32	**5.** 80	**6.** 12
7. 8	**8.** 42	**9.** 60
10. 80	**11.** 12	**12.** 30
13. 90	**14.** 20	**15.** 75
16. 52	**17.** 28	**18.** 112
19. 28	**20.** 84	**21.** 110
22. 30	**23.** 60	**24.** 66