Surface Area & Volume of Prisms (Mixed Review) · 1

Find the volume of a rectangular prism with length 4, width 4, and height 2.

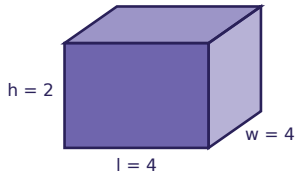

Surface Area & Volume of Prisms (Mixed Review) · 2

Find the surface area of a rectangular prism with length 6, width 9, and height 11.

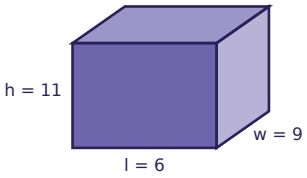

Surface Area & Volume of Prisms (Mixed Review) · 3

Find the volume of a triangular prism with a triangular base of base 7 and height 10, and a prism length of 5.

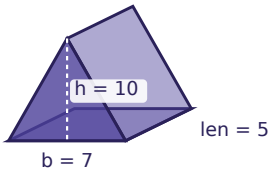

Surface Area & Volume of Prisms (Mixed Review) · 4

Find the volume of a rectangular prism with length 7, width 11, and height 6.

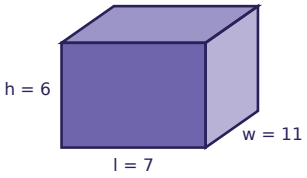

Surface Area & Volume of Prisms (Mixed Review) · 5

Find the surface area of a rectangular prism with length 10, width 7, and height 10.

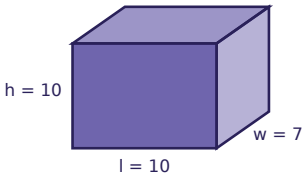

Surface Area & Volume of Prisms (Mixed Review) · 6

Find the volume of a triangular prism with a triangular base of base 9 and height 2, and a prism length of 3.

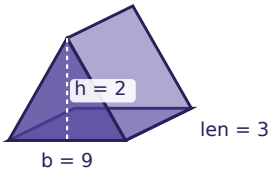

Surface Area & Volume of Prisms (Mixed Review) · 7

Find the volume of a rectangular prism with length 8, width 8, and height 8.

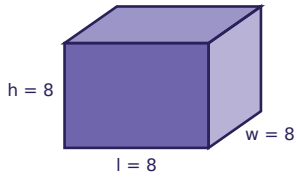

Surface Area & Volume of Prisms (Mixed Review) · 8

Find the surface area of a rectangular prism with length 7, width 11, and height 5.

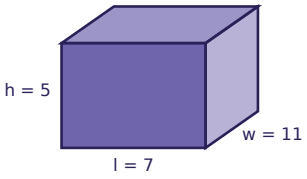

Surface Area & Volume of Prisms (Mixed Review) · 2

ANSWER

438

Surface Area & Volume of Prisms (Mixed Review) · 1

ANSWER

32

Surface Area & Volume of Prisms (Mixed Review) · 4

ANSWER

462

Surface Area & Volume of Prisms (Mixed Review) · 3

ANSWER

175

Surface Area & Volume of Prisms (Mixed Review) · 6

ANSWER

27

Surface Area & Volume of Prisms (Mixed Review) · 5

ANSWER

480

Surface Area & Volume of Prisms (Mixed Review) · 8

ANSWER

334

Surface Area & Volume of Prisms (Mixed Review) · 7

ANSWER

512

Surface Area & Volume of Prisms (Mixed Review) · 9

Find the volume of a rectangular prism with length 11, width 2, and height 8.

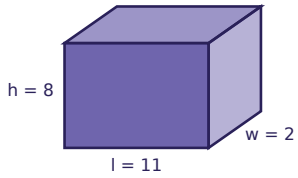

Surface Area & Volume of Prisms (Mixed Review) · 10

Find the surface area of a rectangular prism with length 12, width 12, and height 2.

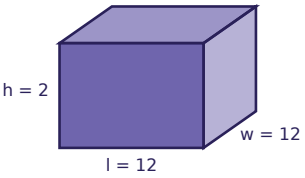

Surface Area & Volume of Prisms (Mixed Review) · 11

Find the volume of a triangular prism with a triangular base of base 2 and height 8, and a prism length of 8.

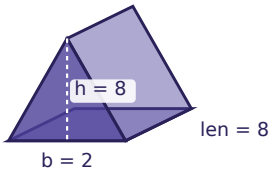

Surface Area & Volume of Prisms (Mixed Review) · 12

Find the volume of a rectangular prism with length 5, width 10, and height 5.

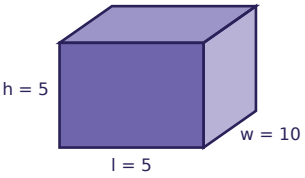

Surface Area & Volume of Prisms (Mixed Review) · 13

Find the surface area of a rectangular prism with length 11, width 10, and height 9.

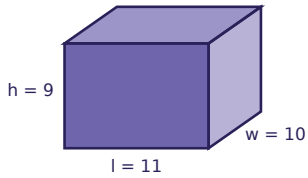

Surface Area & Volume of Prisms (Mixed Review) · 14

Find the volume of a triangular prism with a triangular base of base 9 and height 2, and a prism length of 12.

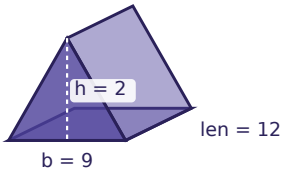

Surface Area & Volume of Prisms (Mixed Review) · 15

Find the volume of a rectangular prism with length 9, width 8, and height 7.

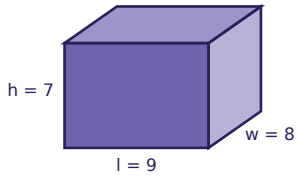

Surface Area & Volume of Prisms (Mixed Review) · 16

Find the surface area of a rectangular prism with length 4, width 12, and height 8.

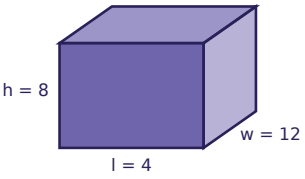

Surface Area & Volume of Prisms (Mixed Review) · 10

ANSWER

384

Surface Area & Volume of Prisms (Mixed Review) · 9

ANSWER

176

Surface Area & Volume of Prisms (Mixed Review) · 12

ANSWER

250

Surface Area & Volume of Prisms (Mixed Review) · 11

ANSWER

64

Surface Area & Volume of Prisms (Mixed Review) · 14

ANSWER

108

Surface Area & Volume of Prisms (Mixed Review) · 13

ANSWER

598

Surface Area & Volume of Prisms (Mixed Review) · 16

ANSWER

352

Surface Area & Volume of Prisms (Mixed Review) · 15

ANSWER

504

Surface Area & Volume of Prisms (Mixed Review) · 17

Find the volume of a rectangular prism with length 6, width 6, and height 9.

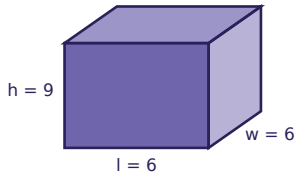

Surface Area & Volume of Prisms (Mixed Review) · 18

Find the surface area of a rectangular prism with length 2, width 3, and height 7.

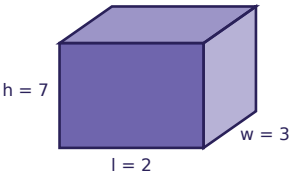

Surface Area & Volume of Prisms (Mixed Review) · 19

Find the volume of a triangular prism with a triangular base of base 10 and height 4, and a prism length of 6.

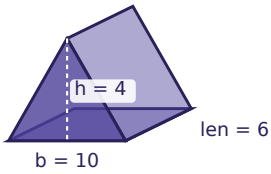

Surface Area & Volume of Prisms (Mixed Review) · 20

Find the volume of a rectangular prism with length 9, width 2, and height 3.

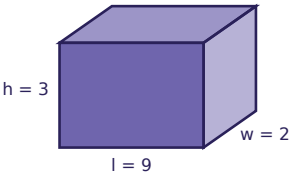

Surface Area & Volume of Prisms (Mixed Review) · 21

Find the surface area of a rectangular prism with length 10, width 5, and height 3.

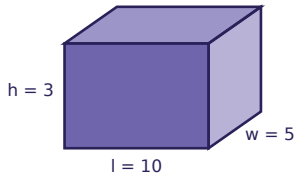

Surface Area & Volume of Prisms (Mixed Review) · 22

Find the volume of a triangular prism with a triangular base of base 5 and height 4, and a prism length of 2.

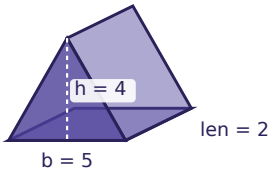

Surface Area & Volume of Prisms (Mixed Review) · 23

Find the volume of a rectangular prism with length 8, width 2, and height 5.

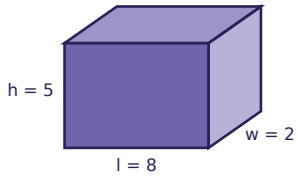

Surface Area & Volume of Prisms (Mixed Review) · 24

Find the surface area of a rectangular prism with length 8, width 6, and height 2.

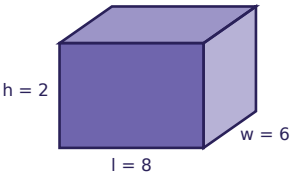

Surface Area & Volume of Prisms (Mixed Review) · 18

ANSWER

82

Surface Area & Volume of Prisms (Mixed Review) · 17

ANSWER

324

Surface Area & Volume of Prisms (Mixed Review) · 20

ANSWER

54

Surface Area & Volume of Prisms (Mixed Review) · 19

ANSWER

120

Surface Area & Volume of Prisms (Mixed Review) · 22

ANSWER

20

Surface Area & Volume of Prisms (Mixed Review) · 21

ANSWER

190

Surface Area & Volume of Prisms (Mixed Review) · 24

ANSWER

152

Surface Area & Volume of Prisms (Mixed Review) · 23

ANSWER

80